Modèles d'un Ensemble (F)



Dans cet ensemble
il y a 12 figures
et 6 sont coloriées.

$$\frac{\text{6 figures coloriées}}{\text{12 figures dans cet ensemble}} = \frac{6}{12} = \frac{1}{2}$$

Écrivez une fraction pour chacun des modèles suivants.













Modèles d'un Ensemble (F) Réponses



Dans cet ensemble
il y a 12 figures
et 6 sont coloriées.

$$\frac{\text{6 figures coloriées}}{\text{12 figures dans cet ensemble}} = \frac{6}{12} = \frac{1}{2}$$

Écrivez une fraction pour chacun des modèles suivants.

$$\frac{4}{8} = \frac{1}{2}$$

$$\frac{3}{6} = \frac{1}{2}$$



$$\frac{5}{10} = \frac{1}{2}$$



$$\frac{10}{20} = \frac{1}{2}$$



$$\frac{8}{16} = \frac{1}{2}$$

$$\frac{2}{4} = \frac{1}{2}$$



$$\frac{12}{24} = \frac{1}{2}$$



$$\frac{9}{18} = \frac{1}{2}$$