Modèles d'un Ensemble (E)



Dans cet ensemble il y a 6 figures et 4 sont coloriées.

$$\frac{\text{4 figures coloriées}}{\text{6 figures dans cet ensemble}} = \frac{4}{6} = \frac{2}{3}$$
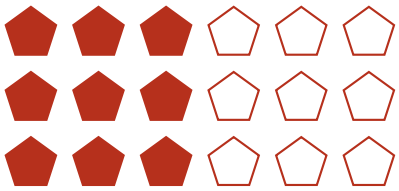
Écrivez une fraction pour chacun des modèles suivants.