Modèles d'un Ensemble (B)

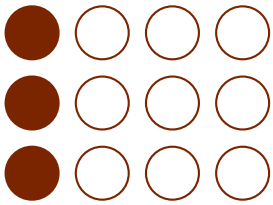

Dans cet ensemble
il y a 12 figures
et 3 sont coloriées.

$$\frac{\text{3 figures coloriées}}{\text{12 figures dans cet ensemble}} = \frac{3}{12} = \frac{1}{4}$$
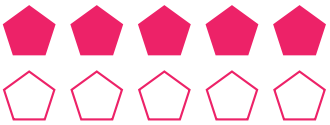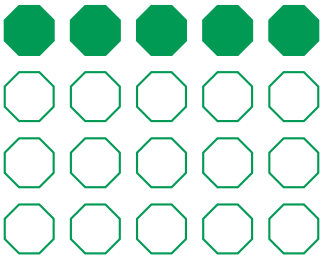
Écrivez une fraction pour chacun des modèles suivants.