Modèles d'un Ensemble (B)

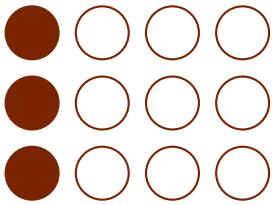

Dans cet ensemble
il y a 12 figures
et 3 sont coloriées.

$$\frac{\text{3 figures coloriées}}{\text{12 figures dans cet ensemble}} = \frac{3}{12} = \frac{1}{4}$$

Écrivez une fraction pour chacun des modèles suivants.

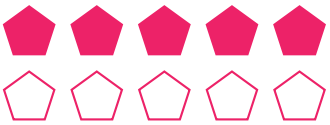





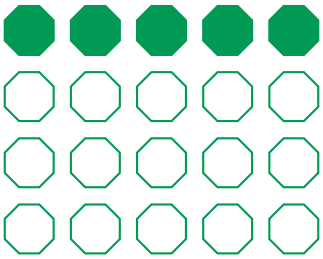



Modèles d'un Ensemble (B) Réponses

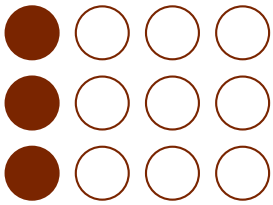

Dans cet ensemble
il y a 12 figures
et 3 sont coloriées.

$$\frac{\text{3 figures coloriées}}{\text{12 figures dans cet ensemble}} = \frac{3}{12} = \frac{1}{4}$$

Écrivez une fraction pour chacun des modèles suivants.

$$\frac{3}{9} = \frac{1}{3}$$

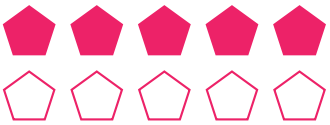

$$\frac{5}{10} = \frac{1}{2}$$



$$\frac{8}{16} = \frac{1}{2}$$



$$\frac{3}{6} = \frac{1}{2}$$

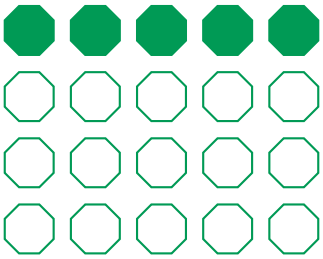

$$\frac{5}{20} = \frac{1}{4}$$

$$\frac{3}{4}$$

$$\frac{1}{4}$$



$$\frac{4}{16} = \frac{1}{4}$$