Modèles d'un Ensemble (J)

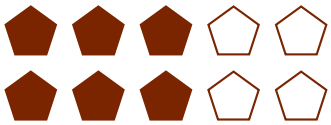

Dans cet ensemble
il y a 10 figures
et 6 sont coloriées.

$$\frac{\text{6 figures coloriées}}{\text{10 figures dans cet ensemble}} = \frac{6}{10} = \frac{3}{5}$$

Écrivez une fraction pour chacun des modèles suivants.

















Modèles d'un Ensemble (J) Réponses

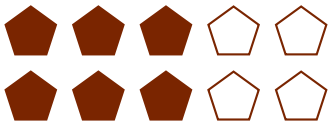

Dans cet ensemble
il y a 10 figures
et 6 sont coloriées.

$$\frac{\text{6 figures coloriées}}{\text{10 figures dans cet ensemble}} = \frac{6}{10} = \frac{3}{5}$$

Écrivez une fraction pour chacun des modèles suivants.



$$\frac{2}{6} = \frac{1}{3}$$



$$\frac{16}{20} = \frac{4}{5}$$



$$\frac{12}{20} = \frac{3}{5}$$



$$\frac{6}{12} = \frac{1}{2}$$



$$\frac{3}{15} = \frac{1}{5}$$



$$\frac{10}{15} = \frac{2}{3}$$



$$\frac{3}{12} = \frac{1}{4}$$



$$\frac{8}{20} = \frac{2}{5}$$