# Modèles d'un Ensemble (H)

Dans cet ensemble il y a 5 figures et 2 sont coloriées.

$$\frac{\text{2 figures coloriées}}{\text{5 figures dans cet ensemble}} = \frac{2}{5}$$

Écrivez une fraction pour chacun des modèles suivants.