Modèles d'un Ensemble (H)

Dans cet ensemble il y a 5 figures et 2 sont coloriées.

$$\frac{\text{2 figures coloriées}}{\text{5 figures dans cet ensemble}} = \frac{2}{5}$$

Écrivez une fraction pour chacun des modèles suivants.















Modèles d'un Ensemble (H) Réponses

Dans cet ensemble il y a 5 figures et 2 sont coloriées.

$$\frac{\text{2 figures coloriées}}{\text{5 figures dans cet ensemble}} = \frac{2}{5}$$

Écrivez une fraction pour chacun des modèles suivants.



$$\frac{20}{24} = \frac{5}{6}$$



$$\frac{4}{8} = \frac{1}{2}$$



$$\frac{3}{18} = \frac{1}{6}$$



$$\frac{8}{12} = \frac{2}{3}$$



$$\frac{16}{20} = \frac{4}{5}$$



$$\frac{3}{15} = \frac{1}{5}$$



$$\frac{3}{12} = \frac{1}{4}$$

$$\frac{3}{9} = \frac{1}{3}$$