Modèles de Fractions (F)

Pour chaque modèle, colorez la portion du cercle représentée par la fraction associée.

1.

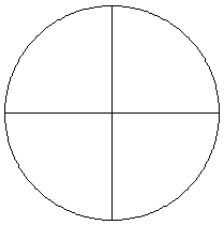

$\frac{4}{4}$

2.

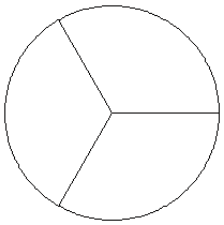

$\frac{1}{3}$

3.

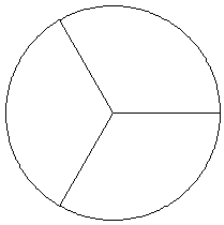

$\frac{2}{3}$

4.

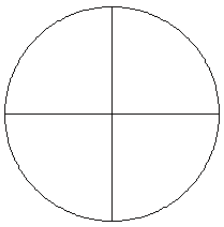

$\frac{1}{4}$

5.

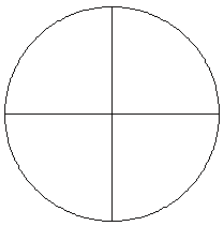

$\frac{3}{4}$

6.

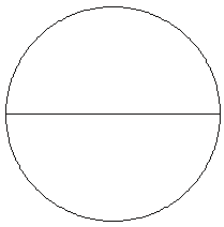

$\frac{1}{2}$

7.

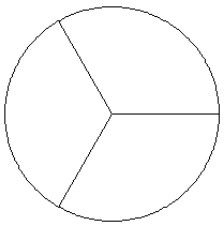

$\frac{1}{3}$

8.

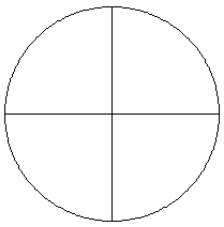

$\frac{1}{4}$

9.

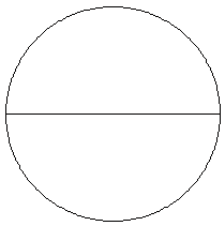

$\frac{0}{2}$

10.

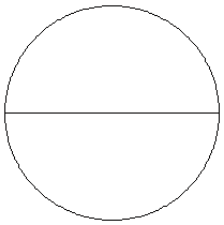

$\frac{0}{2}$

11.

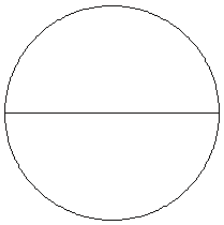

$\frac{1}{2}$

12.

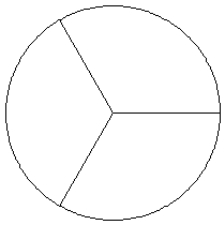

$\frac{1}{3}$