Modèles de Fractions (E)

Pour chaque modèle, colorez la portion du cercle représentée par la fraction associée.

1.

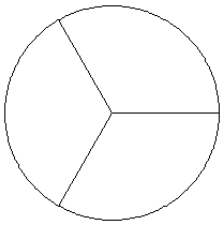

$\frac{3}{3}$

2.

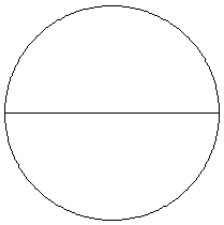

$\frac{1}{2}$

3.

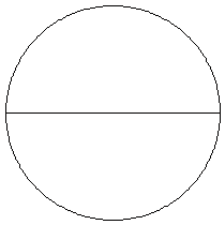

$\frac{2}{2}$

4.

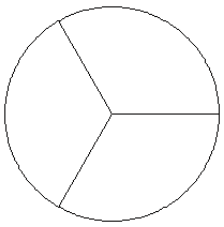

$\frac{1}{3}$

5.

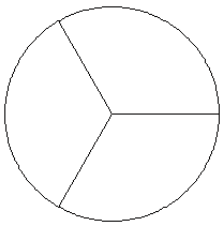

$\frac{0}{3}$

6.

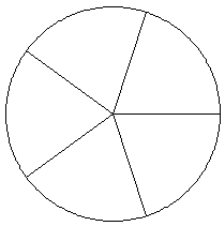

$\frac{4}{5}$

7.

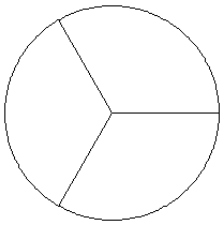

$\frac{2}{3}$

8.

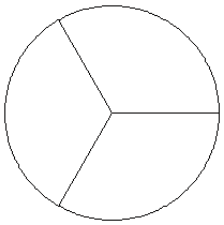

$\frac{1}{3}$

9.

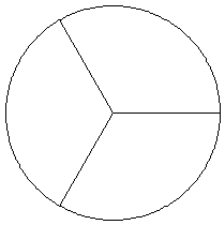

$\frac{2}{3}$

10.

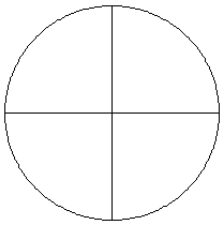

$\frac{1}{4}$

11.

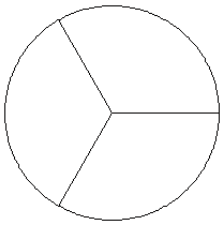

$\frac{1}{3}$

12.

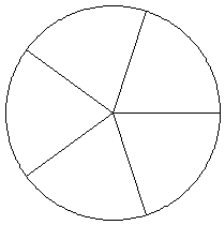

$\frac{2}{5}$