Modèles de Fractions (I)

Pour chaque modèle, colorez la portion du cercle représentée par la fraction associée.

1.

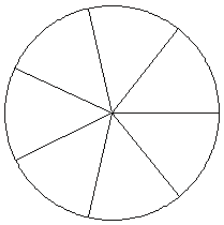

$\frac{4}{7}$

2.

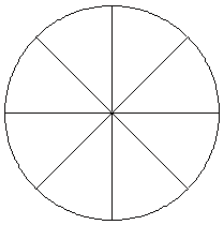

$\frac{5}{8}$

3.

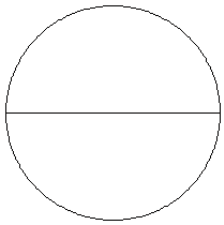

$\frac{1}{2}$

4.

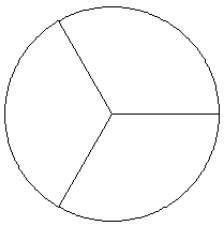

$\frac{2}{3}$

5.

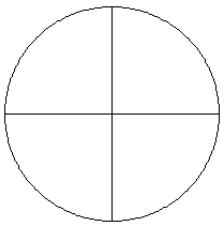

$\frac{1}{4}$

6.

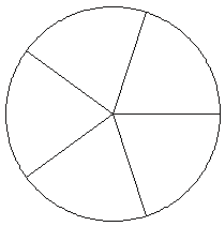

$\frac{3}{5}$

7.

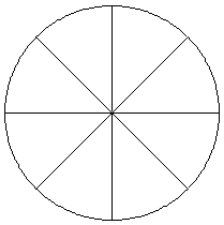

$\frac{4}{8}$

8.

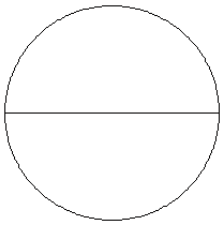

$\frac{1}{2}$

9.

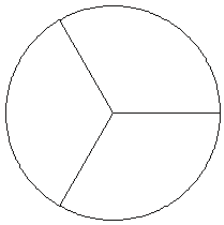

$\frac{1}{3}$

10.

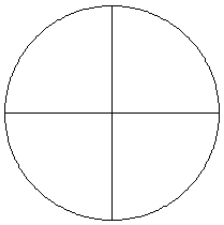

$\frac{2}{4}$

11.

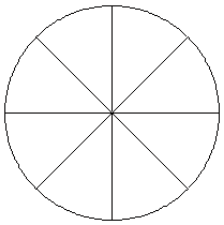

$\frac{6}{8}$

12.

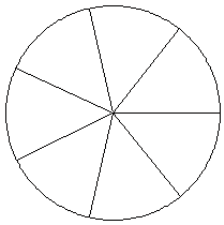

$\frac{5}{7}$

Modèles de Fractions (I) Solutions

Pour chaque modèle, colorez la portion du cercle représentée par la fraction associée.

1.

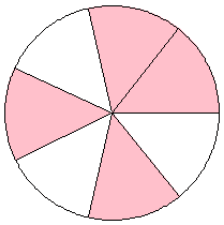

2.

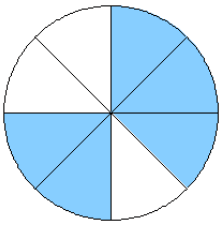

3.

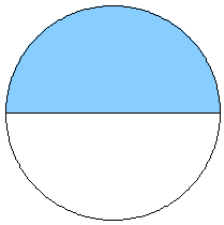

4.

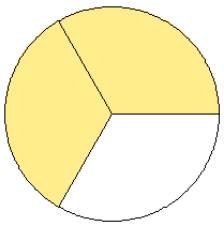

5.

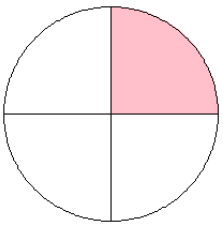

6.

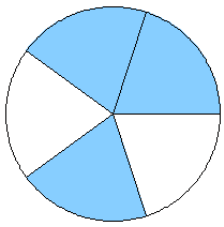

7.

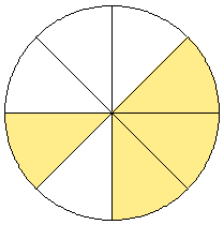

8.

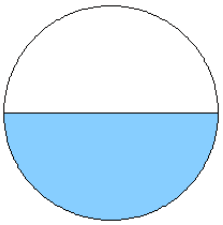

9.

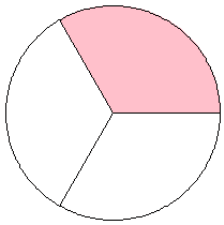

10.

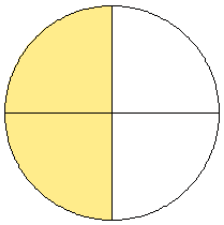

11.

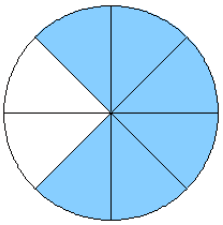
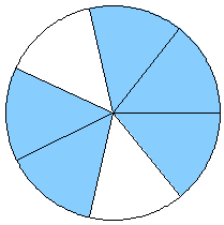
12.