Modèles de Fractions (G)

Pour chaque modèle, colorez la portion du cercle représentée par la fraction associée.

1.

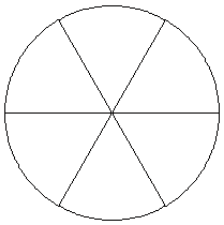

$\frac{5}{6}$

2.

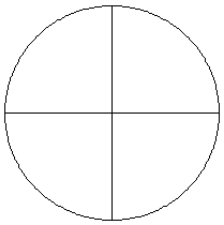

$\frac{1}{4}$

3.

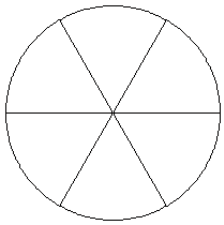

$\frac{2}{6}$

4.

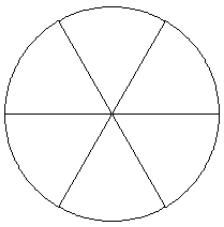

$\frac{6}{6}$

5.

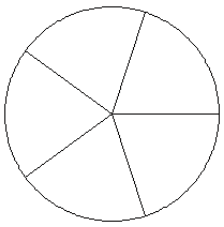

$\frac{0}{5}$

6.

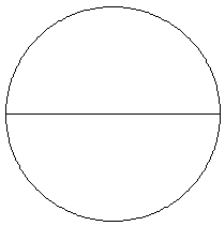

$\frac{2}{2}$

7.

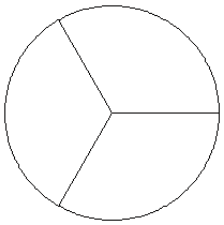

$\frac{2}{3}$

8.

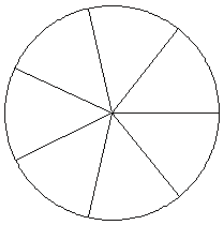

$\frac{3}{7}$

9.

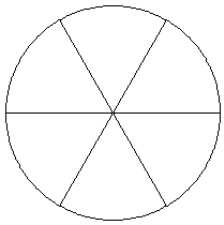

$\frac{3}{6}$

10.

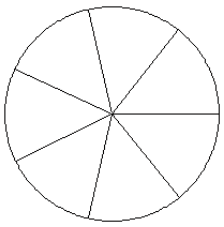

$\frac{3}{7}$

11.

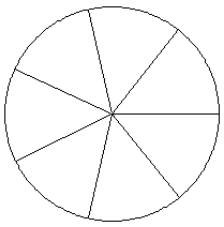

$\frac{4}{7}$

12.

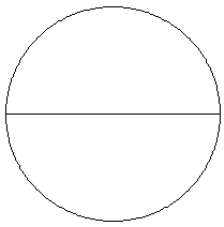

$\frac{2}{2}$

Modèles de Fractions (G) Solutions

Pour chaque modèle, colorez la portion du cercle représentée par la fraction associée.

1.

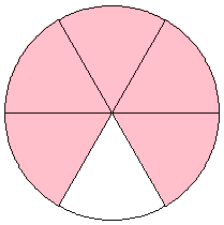

2.

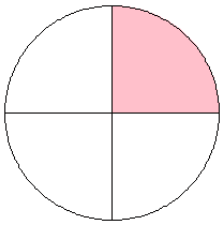

3.

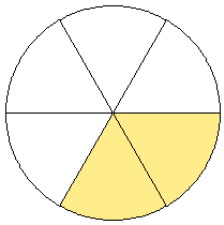

4.

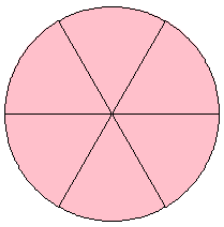

5.

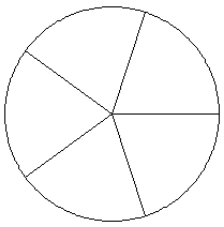

6.

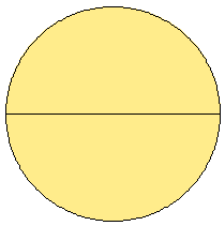

7.

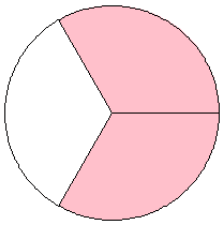

8.

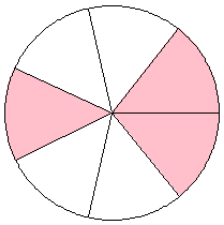

9.

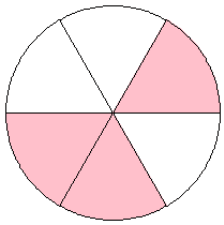

10.

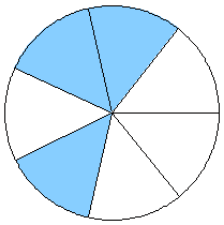

11.

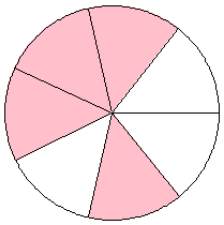
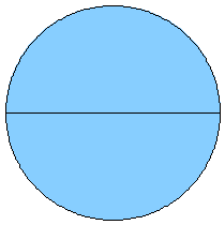
12.