Parts d'un Ensemble (D)



$\frac{2}{6}$ carrés ombragés
carrés dans l'ensemble

Pour chaque ensemble, écrivez la portion de l'ensemble qui est ombragé.

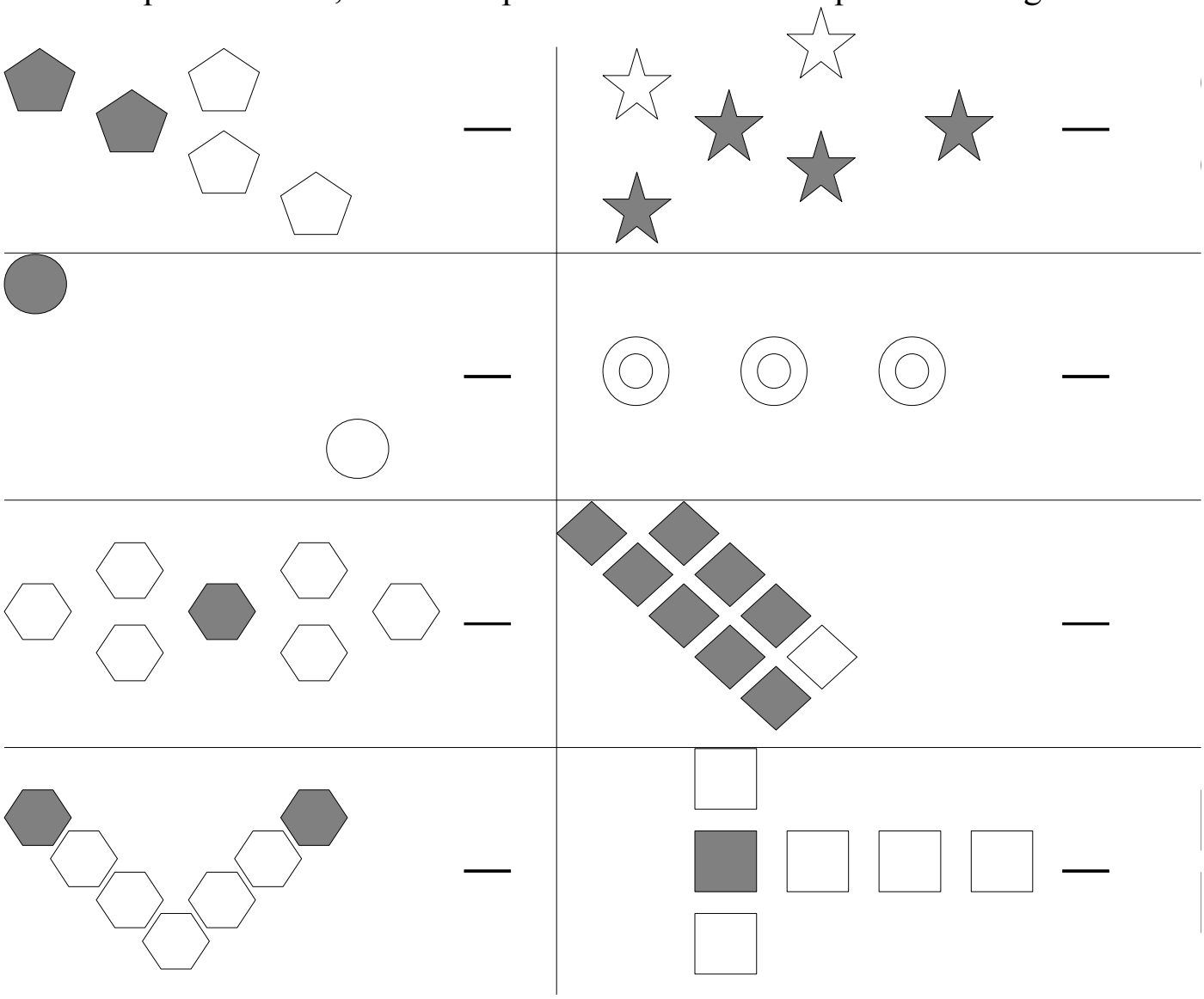

Kelly colored two of the diamonds in a group of three diamonds. ___
What fraction could she write?

Parts d'un Ensemble (D) Solutions



$\frac{2}{6}$ carrés ombragés
carrés dans l'ensemble

Pour chaque ensemble, écrivez la portion de l'ensemble qui est ombragé.

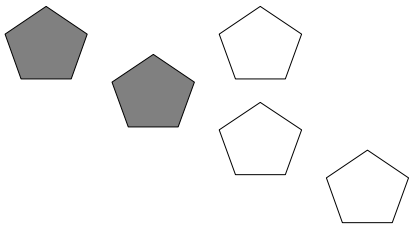

$\frac{2}{5}$



$\frac{4}{6}$



$\frac{1}{2}$

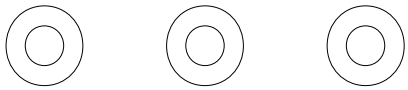

$\frac{0}{3}$

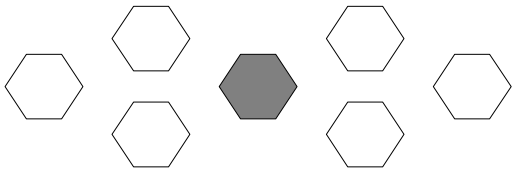

$\frac{1}{7}$

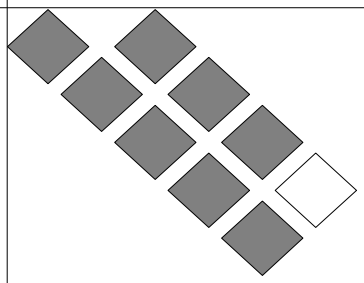

$\frac{8}{9}$

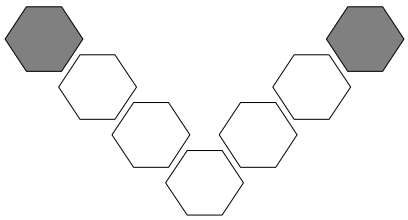

$\frac{2}{7}$

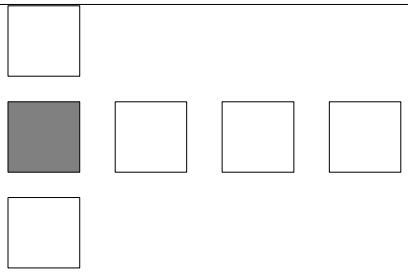

$\frac{1}{6}$

Kelly colored two of the diamonds in a group of three diamonds. What fraction could she write? $\frac{2}{3}$