# Parts d'un Ensemble (C)




$\frac{2}{6}$ carrés ombragés
carrés dans l'ensemble

Pour chaque ensemble, écrivez la portion de l'ensemble qui est ombragé.



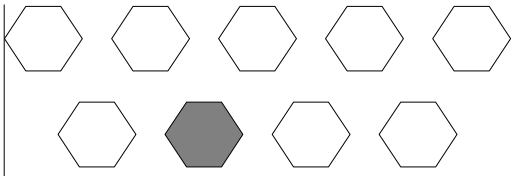

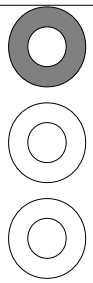

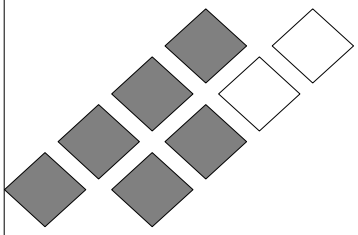

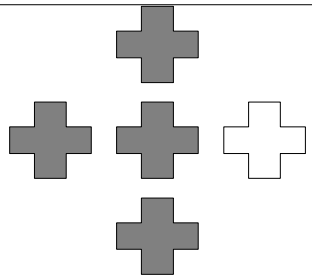

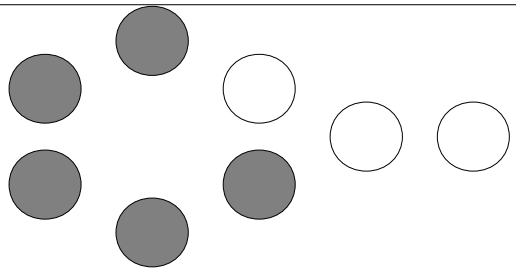

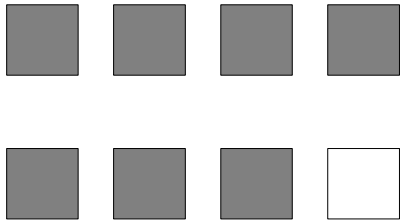

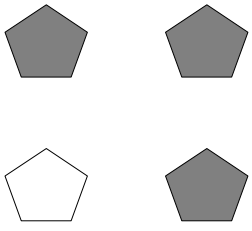

Norman colored six of the circles in a group of eight circles. What fraction could he write?

# Parts d'un Ensemble (C) Solutions




$\frac{2}{6}$ carrés ombragés
carrés dans l'ensemble

Pour chaque ensemble, écrivez la portion de l'ensemble qui est ombragé.



$\frac{0}{4}$

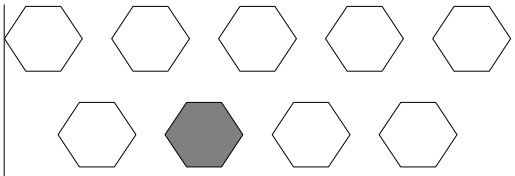

$\frac{1}{9}$

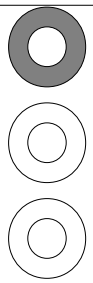

$\frac{1}{3}$

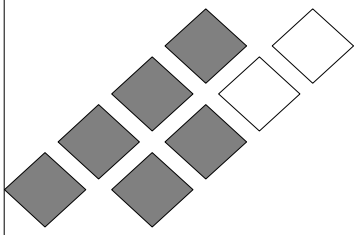

$\frac{6}{8}$

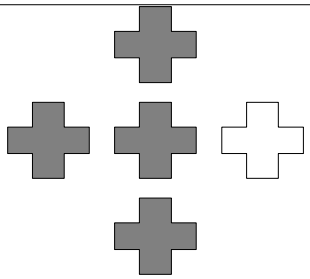

$\frac{4}{5}$

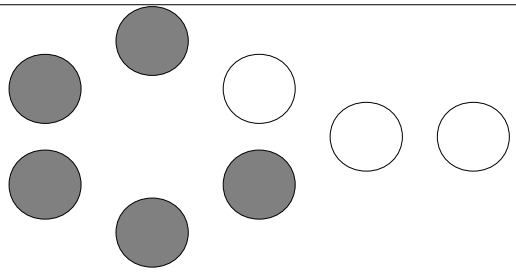

$\frac{5}{8}$



$\frac{7}{8}$

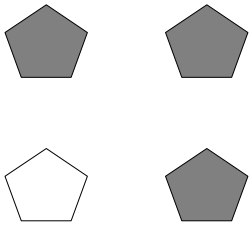

$\frac{3}{4}$

Norman colored six of the circles in a group of eight circles. What fraction could he write? $\frac{6}{8}$