Classification de Fractions (D)

À l'aide des droites numériques, classifiez chaque série de fractions ci-dessous en ordre croissant.

$1\frac{1}{2},\ 1\frac{1}{5},\ \frac{1}{4},\ \frac{3}{5},\ 1\frac{4}{5}$

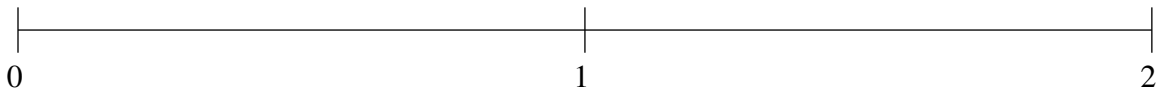

$\frac{1}{2},\ \frac{4}{5},\ 1\frac{3}{10},\ 1\frac{4}{5},\ \frac{1}{5}$

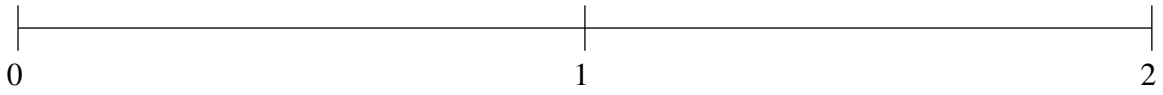
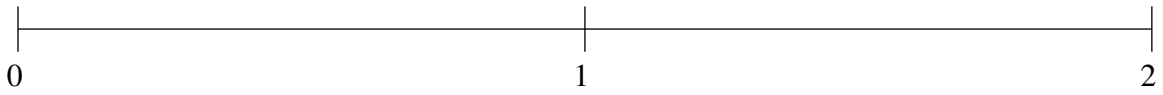
$\frac{4}{5},\ 1\frac{1}{4},\ \frac{2}{5},\ \frac{1}{25},\ 1\frac{4}{5}$