Classification de Fractions (G)

À l'aide des droites numériques, classifiez chaque série de fractions ci-dessous en ordre croissant.

$-\frac{17}{27},\ \frac{10}{13},\ \frac{5}{16},\ 1\frac{3}{5},\ -1\frac{1}{3}$

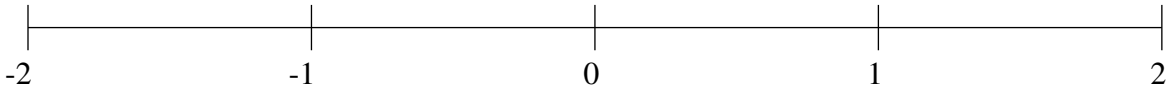

$1\frac{25}{31},\ -1\frac{1}{5},\ -\frac{8}{11},\ \frac{1}{2},\ -1\frac{11}{12}$

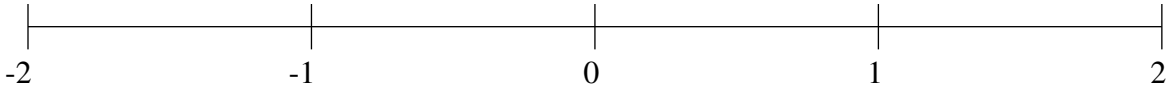

$-1\frac{11}{17},\ -\frac{27}{37},\ 1\frac{19}{25},\ -1\frac{2}{19},\ \frac{29}{44}$

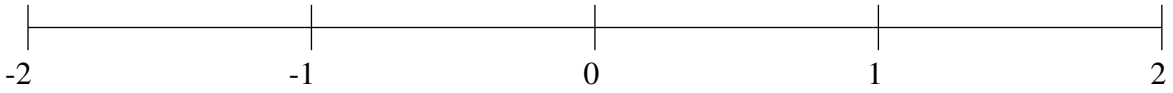

Classification de Fractions (G) Solutions

À l'aide des droites numériques, classifiez chaque série de fractions ci-dessous en ordre croissant.

$-\frac{17}{27}, \frac{10}{13}, \frac{5}{16}, 1\frac{3}{5}, -1\frac{1}{3}$

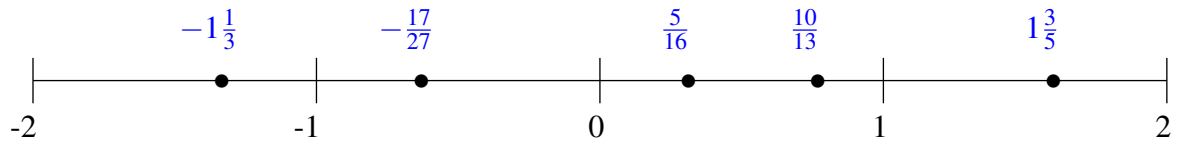

$1\frac{25}{31}, -1\frac{1}{5}, -\frac{8}{11}, \frac{1}{2}, -1\frac{11}{12}$

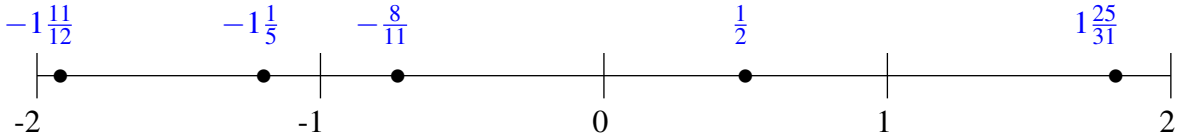
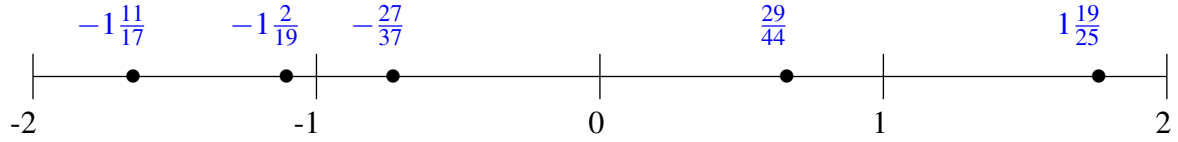
$-1\frac{11}{17}, -\frac{27}{37}, 1\frac{19}{25}, -1\frac{2}{19}, \frac{29}{44}$