Classification de Fractions (D)

À l'aide des droites numériques, classifiez chaque série de fractions ci-dessous en ordre croissant.

$1\frac{5}{6},\ 1\frac{2}{5},\ \frac{1}{6},\ \frac{3}{4},\ 1\frac{1}{10}$

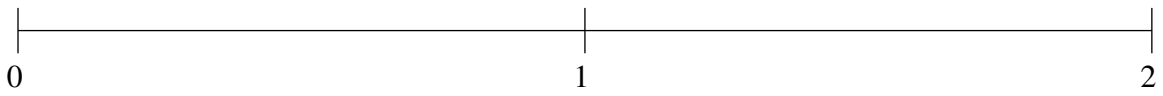

$1\frac{3}{4},\ \frac{5}{6},\ \frac{1}{6},\ \frac{1}{2},\ 1\frac{1}{4}$

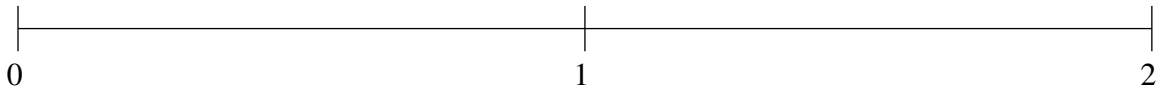

$1\frac{1}{5},\ \frac{1}{12},\ 1\frac{4}{5},\ \frac{5}{6},\ \frac{1}{2}$

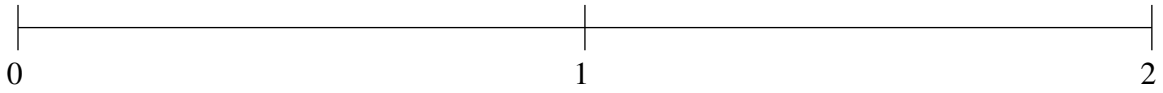

Classification de Fractions (D) Solutions

À l'aide des droites numériques, classifiez chaque série de fractions ci-dessous en ordre croissant.

$1\frac{5}{6},\ 1\frac{2}{5},\ \frac{1}{6},\ \frac{3}{4},\ 1\frac{1}{10}$

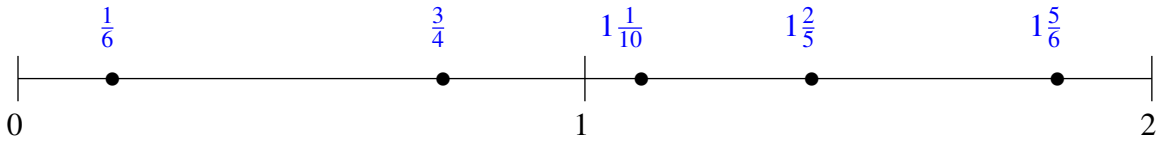

$1\frac{3}{4},\ \frac{5}{6},\ \frac{1}{6},\ \frac{1}{2},\ 1\frac{1}{4}$

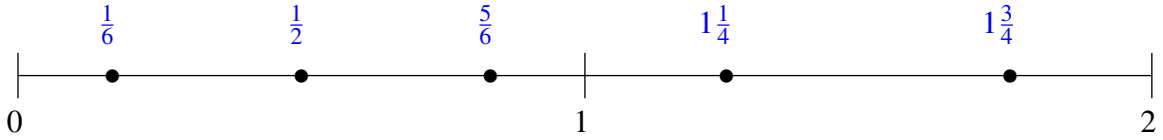
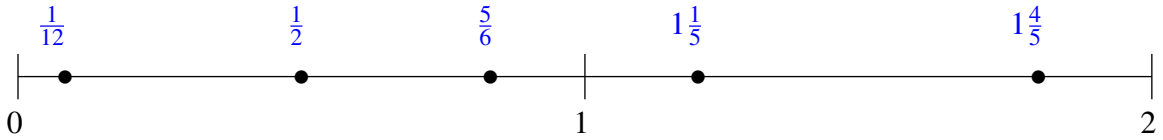
$1\frac{1}{5},\ \frac{1}{12},\ 1\frac{4}{5},\ \frac{5}{6},\ \frac{1}{2}$