Classification de Fractions (D)

À l'aide des droites numériques, classifiez chaque série de fractions ci-dessous en ordre croissant.

$1\frac{5}{6},\ -1\frac{5}{6},\ -\frac{2}{3},\ 1\frac{1}{2},\ -1\frac{1}{4}$

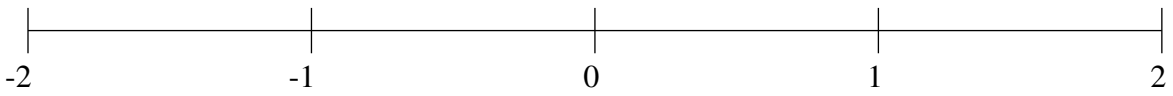

$-\frac{3}{4},\ \frac{1}{4},\ -1\frac{1}{4},\ 1\frac{1}{8},\ -1\frac{3}{4}$

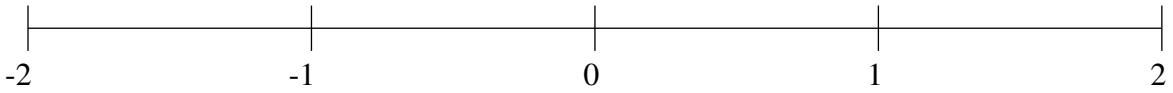
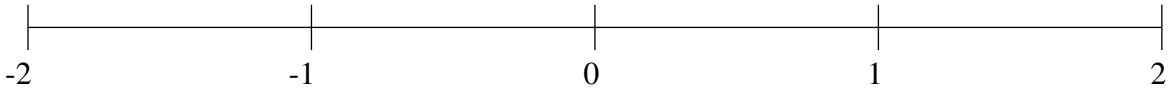
$-1\frac{3}{4},\ 1\frac{5}{6},\ \frac{11}{12},\ -\frac{1}{8},\ -1\frac{1}{4}$