Classification de Fractions (D)

À l'aide des droites numériques, classifiez chaque série de fractions ci-dessous en ordre croissant.

$1\frac{1}{7},\ 1\frac{5}{6},\ 1\frac{1}{2},\ \frac{1}{3},\ \frac{10}{13}$

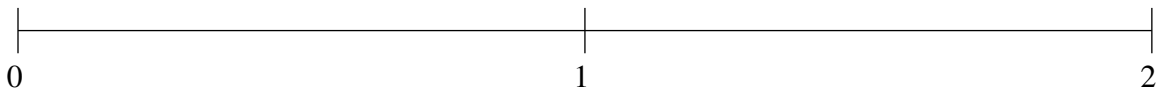

$1\frac{5}{6},\ \frac{4}{5},\ \frac{1}{7},\ 1\frac{7}{19},\ \frac{1}{2}$

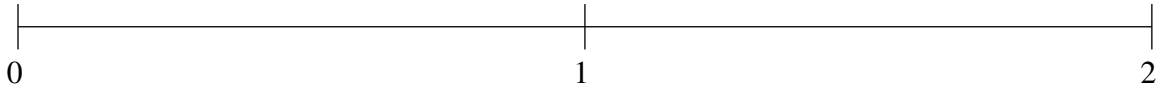
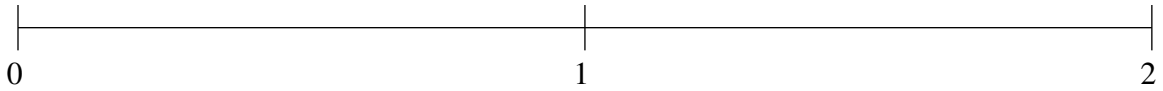
$\frac{3}{4},\ 1\frac{1}{7},\ \frac{1}{17},\ 1\frac{5}{6},\ 1\frac{1}{2}$