Classification de Fractions (A)

À l'aide des droites numériques, classifiez chaque série de fractions ci-dessous en ordre croissant.

$\frac{5}{8},\ -1\frac{1}{4},\ -\frac{3}{4},\ 1\frac{2}{5},\ -1\frac{3}{4}$

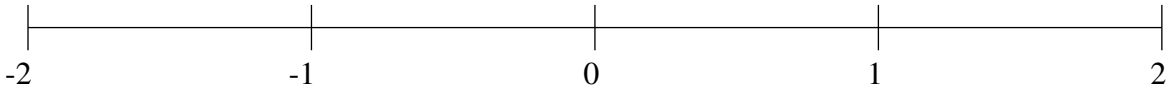

$-1\frac{1}{5},\ 1\frac{7}{8},\ 1\frac{2}{5},\ -1\frac{7}{8},\ \frac{1}{2}$

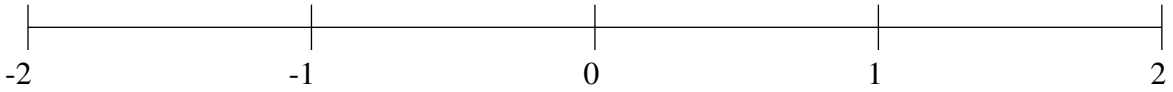

$-1\frac{8}{9},\ \frac{2}{3},\ -\frac{2}{3},\ 1\frac{4}{5},\ 1\frac{1}{4}$

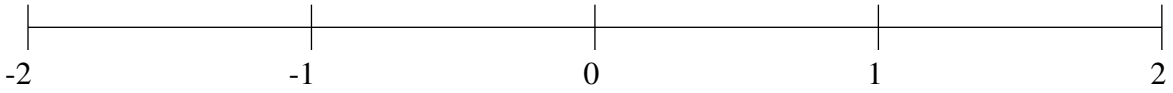

Classification de Fractions (A) Solutions

À l'aide des droites numériques, classifiez chaque série de fractions ci-dessous en ordre croissant.

$\frac{5}{8},\ -1\frac{1}{4},\ -\frac{3}{4},\ 1\frac{2}{5},\ -1\frac{3}{4}$

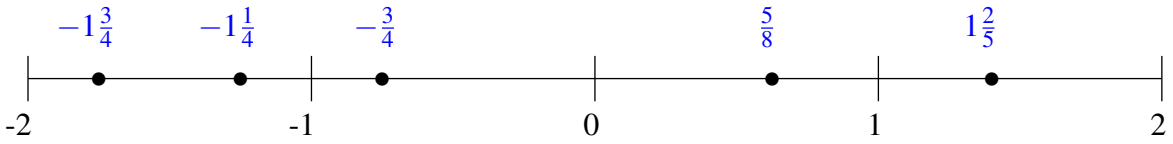

$-1\frac{1}{5},\ 1\frac{7}{8},\ 1\frac{2}{5},\ -1\frac{7}{8},\ \frac{1}{2}$
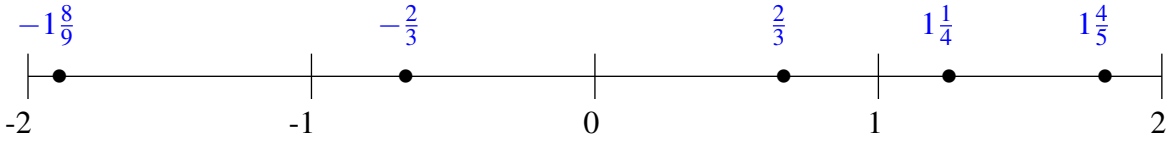
$-1\frac{8}{9},\ \frac{2}{3},\ -\frac{2}{3},\ 1\frac{4}{5},\ 1\frac{1}{4}$