Classification de Fractions (D)

À l'aide des droites numériques, classifiez chaque série de fractions ci-dessous en ordre croissant.

$\frac{1}{2}, \frac{4}{5}, \frac{1}{5}, 1\frac{4}{5}, 1\frac{2}{5}$

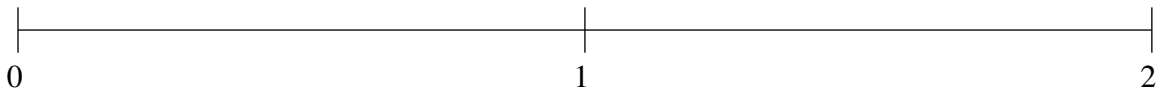

$\frac{4}{5}, \frac{1}{2}, 1\frac{1}{5}, \frac{1}{5}, 1\frac{4}{5}$

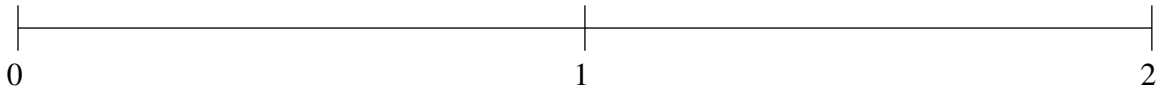

$\frac{4}{5}, 1\frac{1}{2}, 1\frac{4}{5}, \frac{1}{5}, \frac{1}{2}$

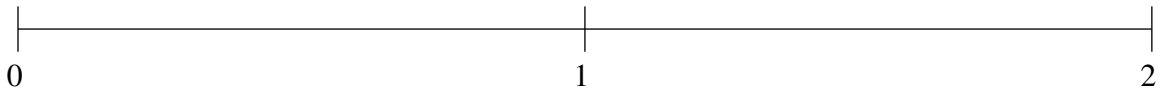

Classification de Fractions (D) Solutions

À l'aide des droites numériques, classifiez chaque série de fractions ci-dessous en ordre croissant.

$\frac{1}{2}, \frac{4}{5}, \frac{1}{5}, 1\frac{4}{5}, 1\frac{2}{5}$

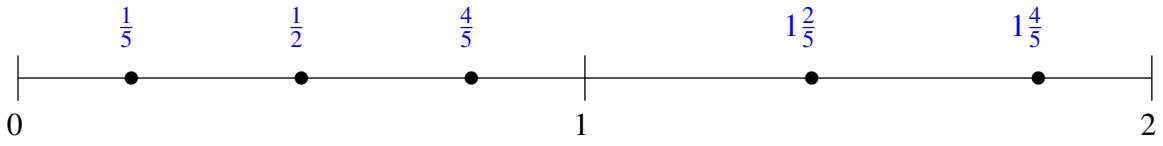

$\frac{4}{5}, \frac{1}{2}, 1\frac{1}{5}, \frac{1}{5}, 1\frac{4}{5}$

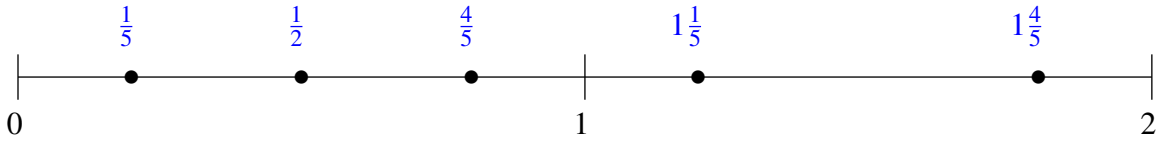
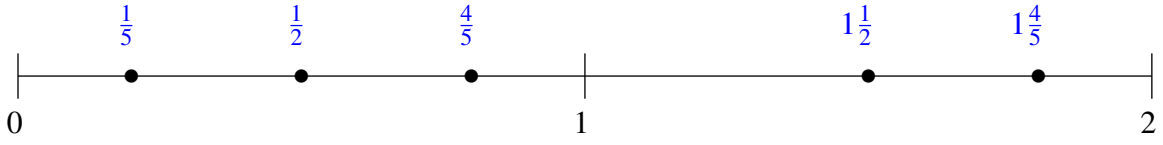
$\frac{4}{5}, 1\frac{1}{2}, 1\frac{4}{5}, \frac{1}{5}, \frac{1}{2}$