Modèles de Cinquièmes (C)

Instructions: Représentez chaque fraction en colorant les sections appropriéees du modèle correspondant. Essayez de représenter les mêmes fractions de divers façons.



$\frac{2}{5}$



$\frac{3}{5}$



$\frac{1}{5}$



$\frac{1}{5}$



$\frac{4}{5}$



$\frac{4}{5}$



$\frac{4}{5}$



$\frac{1}{5}$



$\frac{1}{5}$