Modèles de Cinquièmes (B)

Instructions: Inscrivez le numérateur correspondant.



$\frac{5}{5}$



$\frac{\quad}{5}$



$\frac{\quad}{5}$



$\frac{\quad}{5}$

$\frac{\quad}{5}$

$\frac{\quad}{5}$



$\frac{\quad}{5}$

$\frac{\quad}{5}$



$\frac{\quad}{5}$