Modèles de Cinquièmes (A)

Instructions: Inscrivez le numérateur correspondant.



$\frac{5}{5}$



$\frac{__}{5}$



$\frac{__}{5}$



$\frac{__}{5}$

$\frac{__}{5}$

$\frac{__}{5}$



$\frac{__}{5}$



$\frac{__}{5}$



$\frac{__}{5}$