Fractions Équivalentes (H)

Nom: _____ Date: _____

Colorez le deuxième modèle de la même façon que le premier ensuite déterminez les fractions équivalentes.

1. 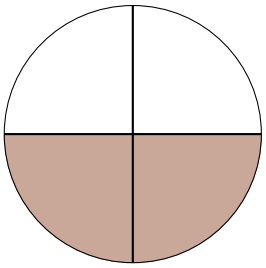 = 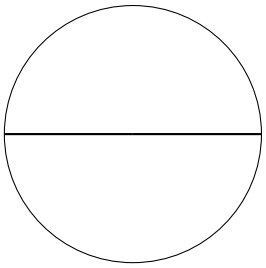 $\frac{\quad}{\quad} = \frac{\quad}{\quad}$

2. 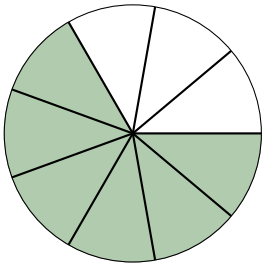 = 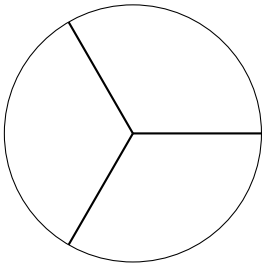 $\frac{\quad}{\quad} = \frac{\quad}{\quad}$

3. 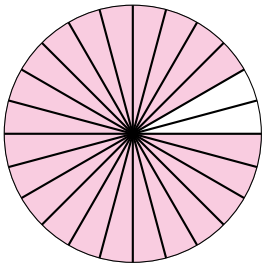 = 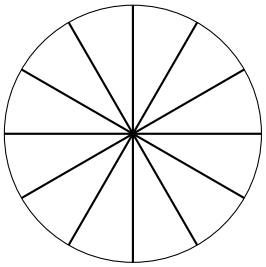 $\frac{\quad}{\quad} = \frac{\quad}{\quad}$

4. 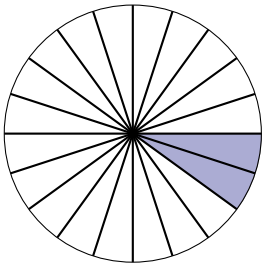 = 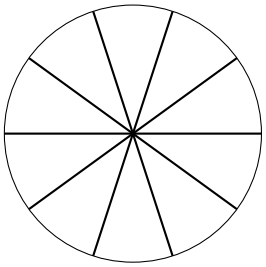 $\frac{\quad}{\quad} = \frac{\quad}{\quad}$

5. 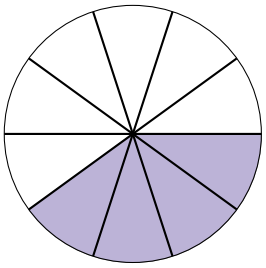 = 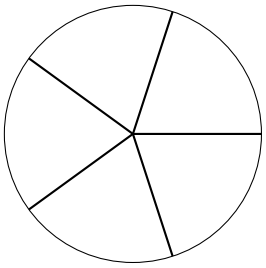 $\frac{\quad}{\quad} = \frac{\quad}{\quad}$

Fractions Équivalentes (H) Réponses

Nom: _____ Date: _____

Colorez le deuxième modèle de la même façon que le premier ensuite déterminez les fractions équivalentes.

1. 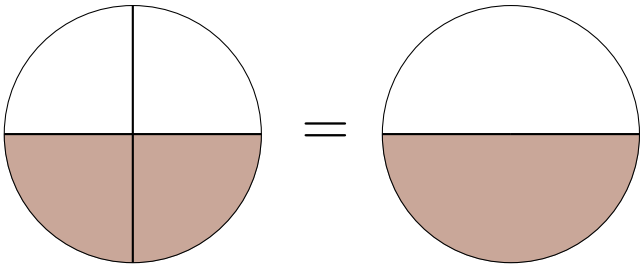 $\frac{1}{2} = \frac{2}{4}$

2. 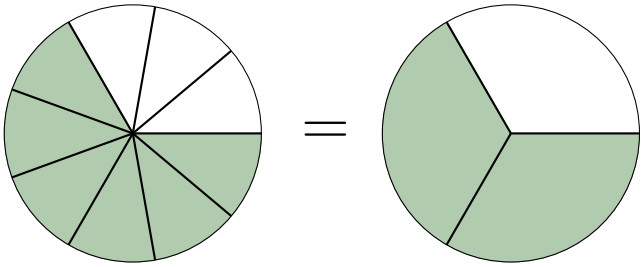 $\frac{2}{3} = \frac{6}{9}$

3. 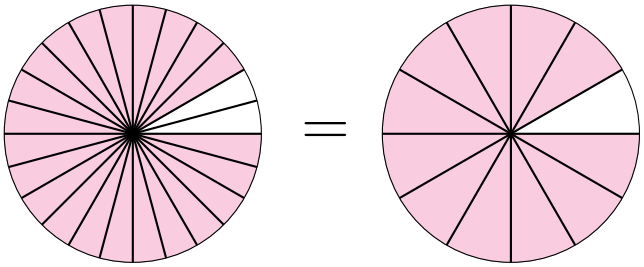 $\frac{11}{12} = \frac{22}{24}$

4. 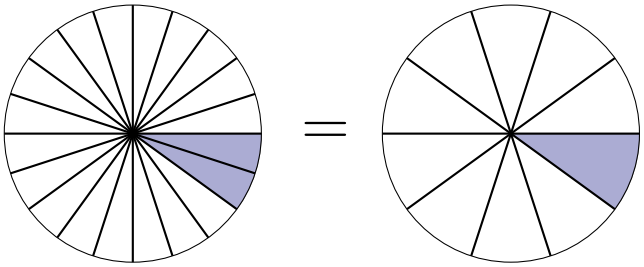 $\frac{1}{10} = \frac{2}{20}$

5. 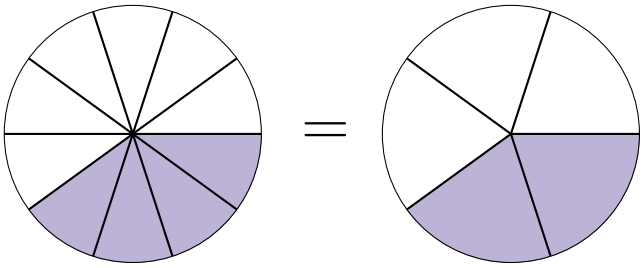 $\frac{2}{5} = \frac{4}{10}$