Fractions Équivalentes (G)

Nom: _____ Date: _____

Colorez le deuxième modèle de la même façon que le premier ensuite déterminez les fractions équivalentes.

1. 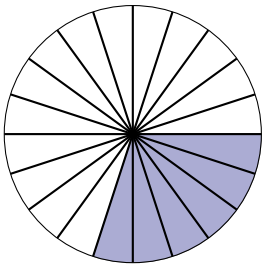 = 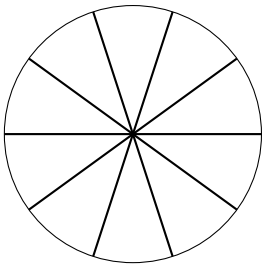 — = —

2. 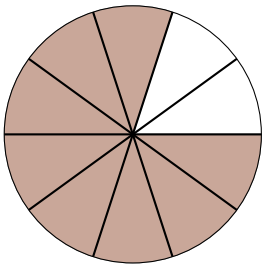 = 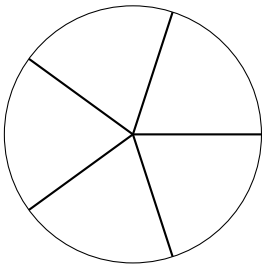 — = —

3. 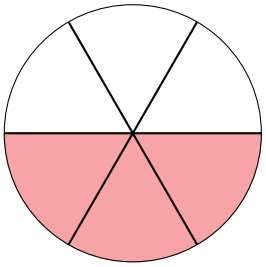 = 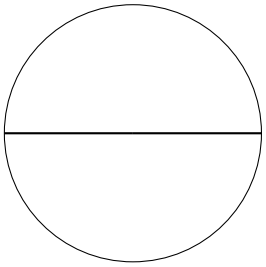 — = —

4. 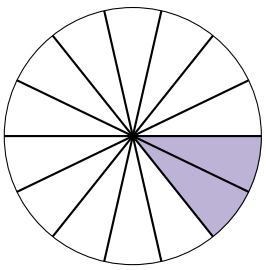 = 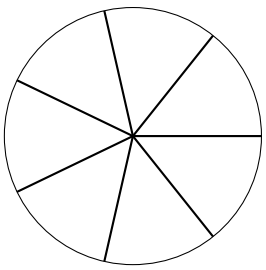 — = —

5. 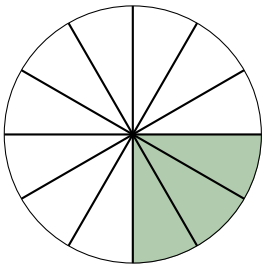 = 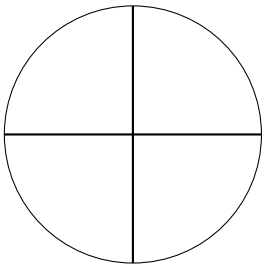 — = —

Fractions Équivalentes (G) Réponses

Nom: _____ Date: _____

Colorez le deuxième modèle de la même façon que le premier ensuite déterminez les fractions équivalentes.

1. 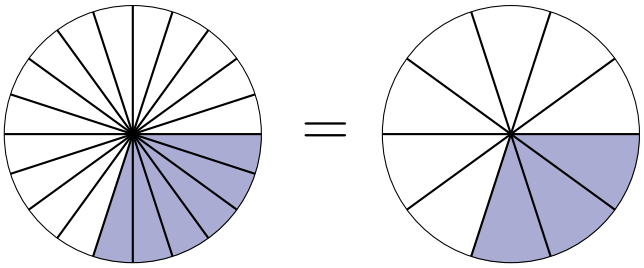

$$\frac{3}{10} = \frac{6}{20}$$

2. 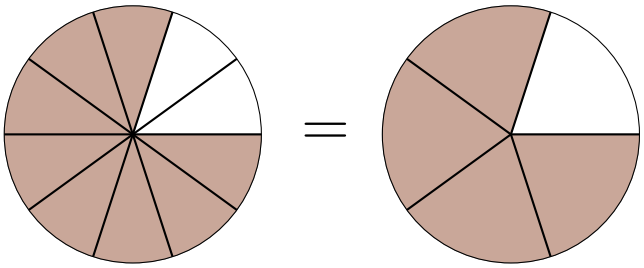

$$\frac{4}{5} = \frac{8}{10}$$

3. 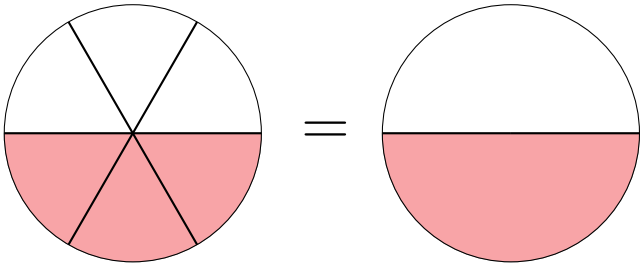

$$\frac{1}{2} = \frac{3}{6}$$

4. 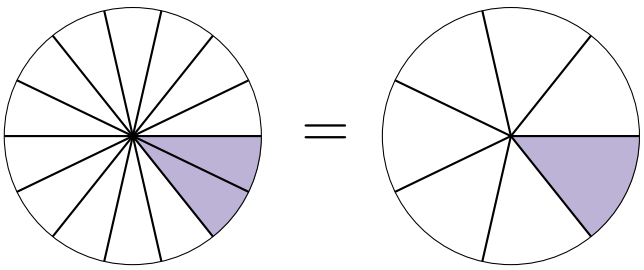

$$\frac{1}{7} = \frac{2}{14}$$

5. 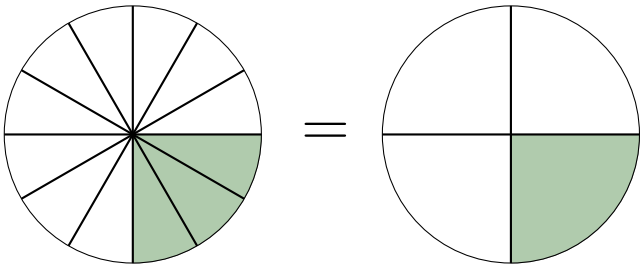

$$\frac{1}{4} = \frac{3}{12}$$