Fractions Équivalentes (F)

Nom: _____ Date: _____

Colorez le deuxième modèle de la même façon que le premier ensuite déterminez les fractions équivalentes.

1. 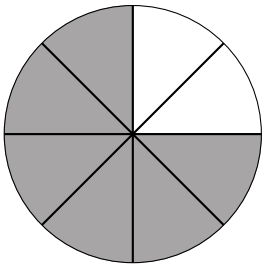 = 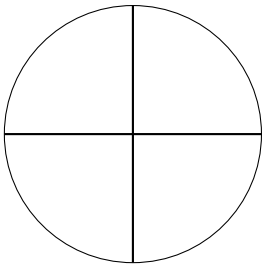 $\frac{\quad}{\quad} = \frac{\quad}{\quad}$

2. 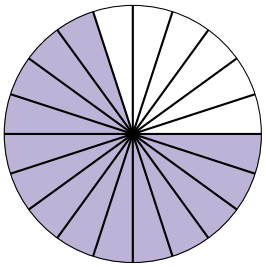 = 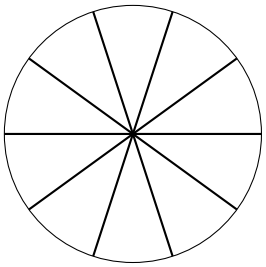 $\frac{\quad}{\quad} = \frac{\quad}{\quad}$

3. 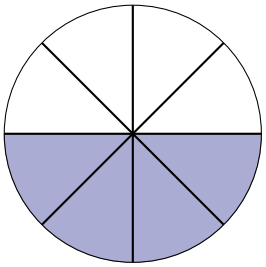 = 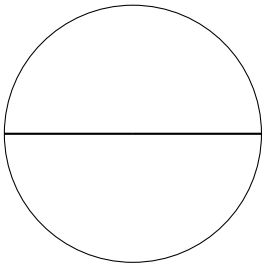 $\frac{\quad}{\quad} = \frac{\quad}{\quad}$

4. 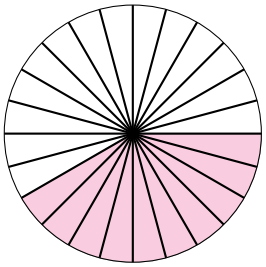 = 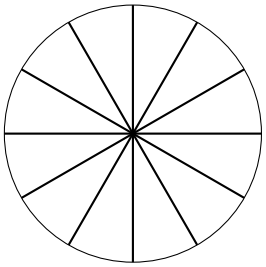 $\frac{\quad}{\quad} = \frac{\quad}{\quad}$

5. 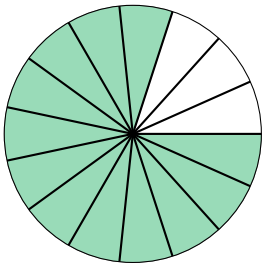 = 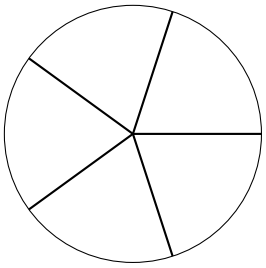 $\frac{\quad}{\quad} = \frac{\quad}{\quad}$

Fractions Équivalentes (F) Réponses

Nom: _____ Date: _____

Colorez le deuxième modèle de la même façon que le premier ensuite déterminez les fractions équivalentes.

1. 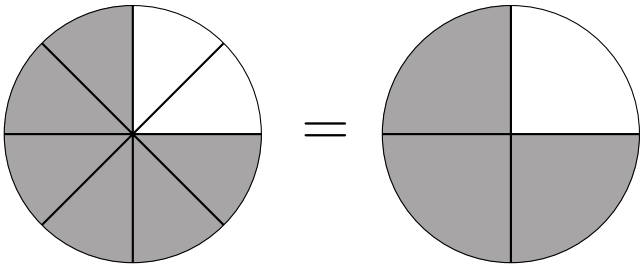

$$\frac{3}{4} = \frac{6}{8}$$

2. 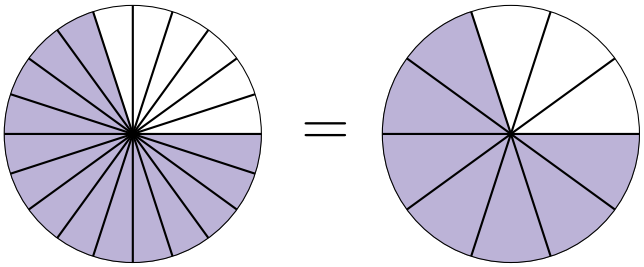

$$\frac{7}{10} = \frac{14}{20}$$

3. 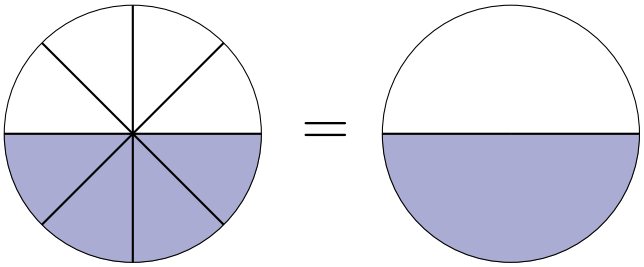

$$\frac{1}{2} = \frac{4}{8}$$

4. 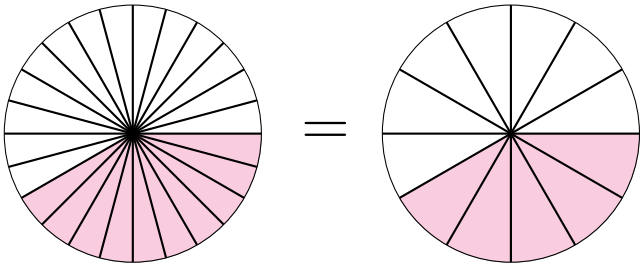

$$\frac{5}{12} = \frac{10}{24}$$

5. 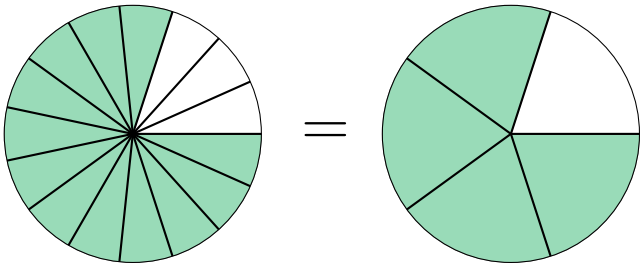

$$\frac{4}{5} = \frac{12}{15}$$