Fractions Équivalentes (A)

Nom: _____ Date: _____

Colorez le deuxième modèle de la même façon que le premier ensuite déterminez les fractions équivalentes.

1. 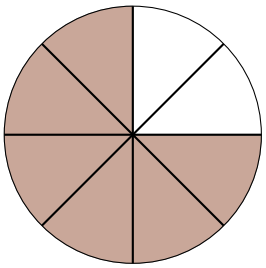 = 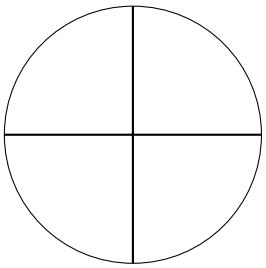 $\frac{\quad}{\quad} = \frac{\quad}{\quad}$

2. 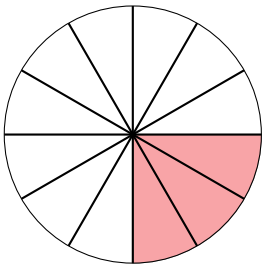 = 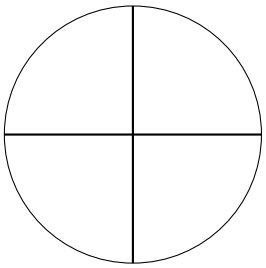 $\frac{\quad}{\quad} = \frac{\quad}{\quad}$

3. 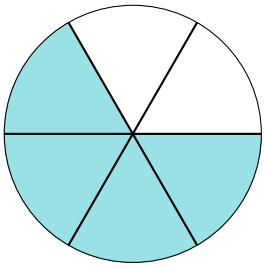 = 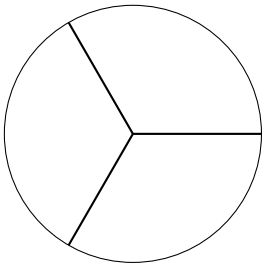 $\frac{\quad}{\quad} = \frac{\quad}{\quad}$

4. 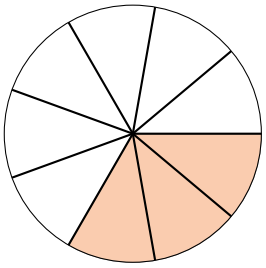 = 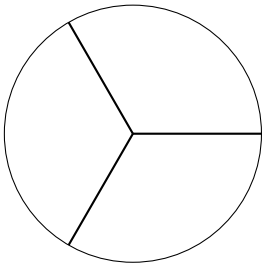 $\frac{\quad}{\quad} = \frac{\quad}{\quad}$

5. 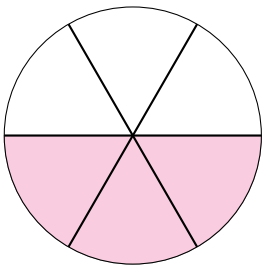 = 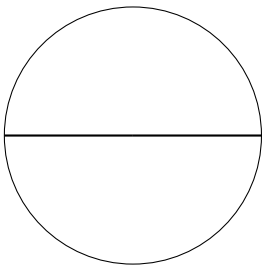 $\frac{\quad}{\quad} = \frac{\quad}{\quad}$