Fractions Équivalentes (F)

Nom: _____ Date: _____

Colorez le deuxième modèle de la même façon que le premier ensuite déterminez les fractions équivalentes.

1. 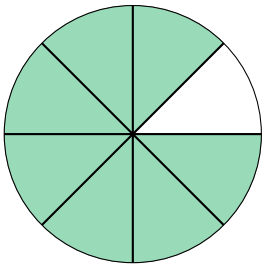 = 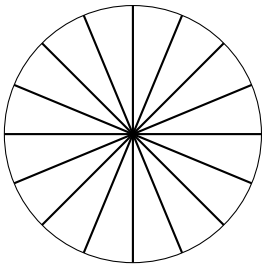 — = —

2. 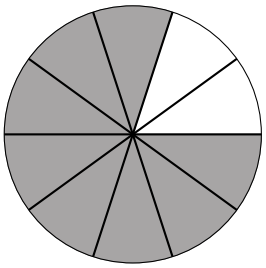 = 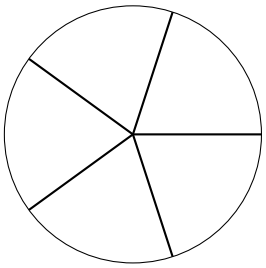 — = —

3. 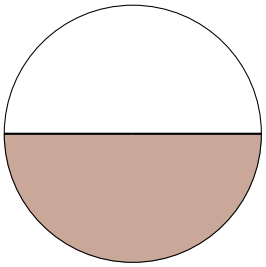 = 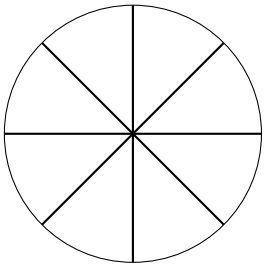 — = —

4. 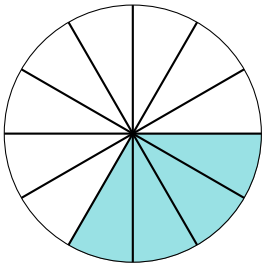 = 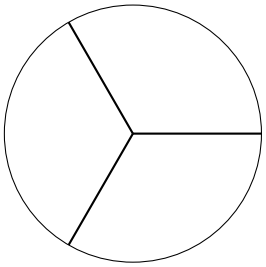 — = —

5. 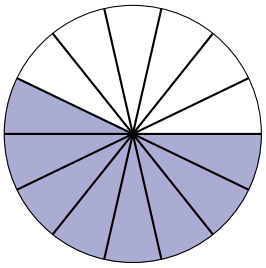 = 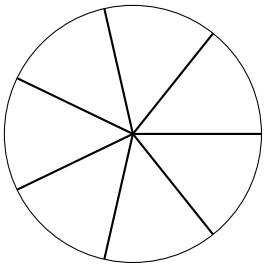 — = —

Fractions Équivalentes (F) Réponses

Nom: _____ Date: _____

Colorez le deuxième modèle de la même façon que le premier ensuite déterminez les fractions équivalentes.

1. 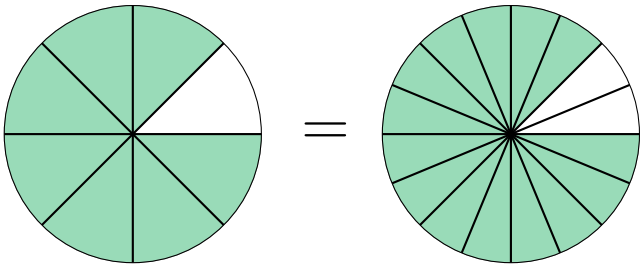 $\frac{7}{8} = \frac{14}{16}$

2. 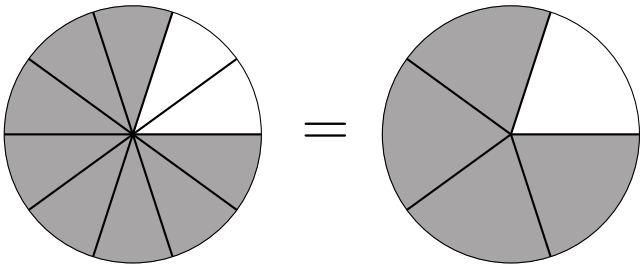 $\frac{4}{5} = \frac{8}{10}$

3. 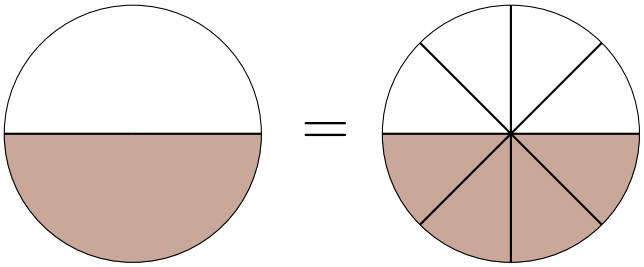 $\frac{1}{2} = \frac{4}{8}$

4. 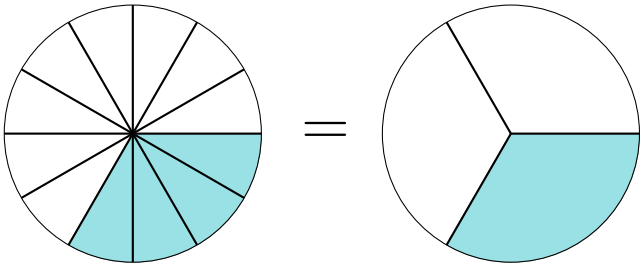 $\frac{1}{3} = \frac{4}{12}$

5. 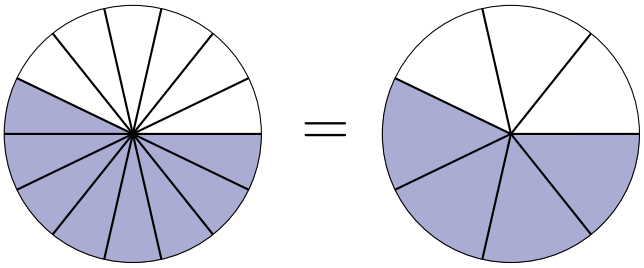 $\frac{4}{7} = \frac{8}{14}$