Coloriage des Fractions (F)

Colorez chaque groupe de figures pour représenter chaque fraction.

1.

$\frac{1}{2}$



2.

$\frac{1}{4}$



3.

$\frac{2}{3}$

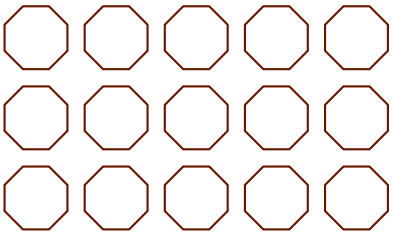

4.

$\frac{1}{3}$



5.

$\frac{1}{4}$

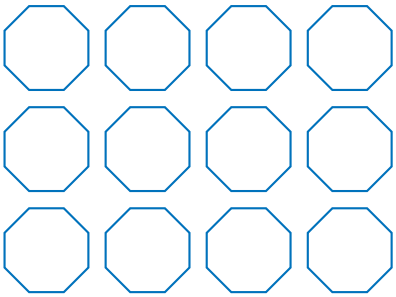

6.

$\frac{3}{4}$