L'Arrondi de Nombres Mixtes (D)

Nom: _____ Date: _____

Arrondissez chaque nombre mixte à la plus proche moitié. Arrondissez à l'entier supérieur en cas d'égalité.

1. $6\frac{1}{7} \simeq$

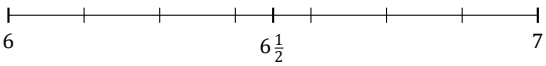

2. $5\frac{3}{4} \simeq$

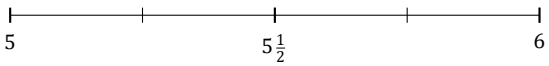

3. $1\frac{3}{10} \simeq$

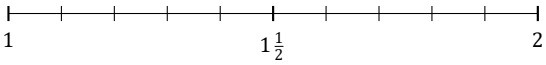

4. $2\frac{6}{10} \simeq$

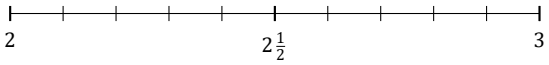

5. $9\frac{10}{11} \simeq$

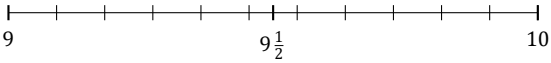

6. $6\frac{2}{4} \simeq$

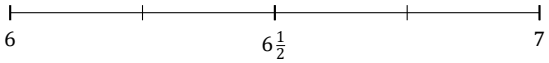

7. $6\frac{10}{12} \simeq$

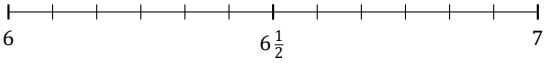

8. $5\frac{1}{8} \simeq$

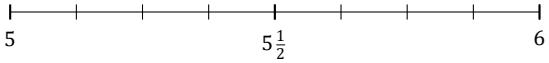

9. $1\frac{7}{11} \simeq$

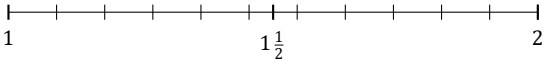

10. $5\frac{3}{8} \simeq$

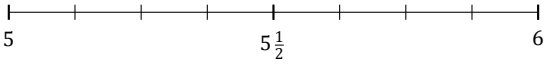

11. $6\frac{9}{12} \simeq$

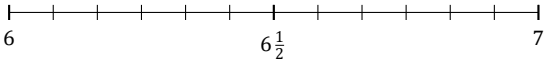

12. $9\frac{4}{5} \simeq$

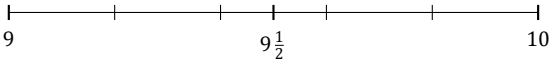

13. $9\frac{8}{9} \simeq$

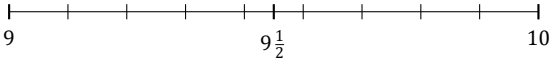

14. $4\frac{7}{10} \simeq$

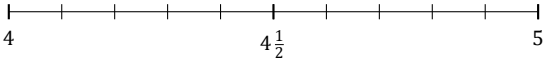

15. $6\frac{6}{12} \simeq$

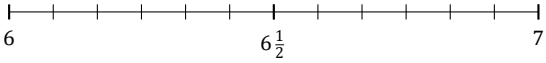

16. $6\frac{7}{9} \simeq$

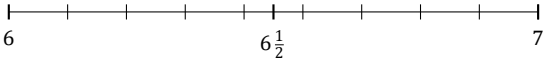

17. $9\frac{3}{9} \simeq$

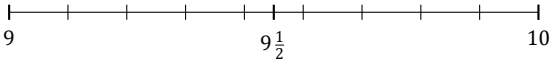

18. $4\frac{7}{8} \simeq$

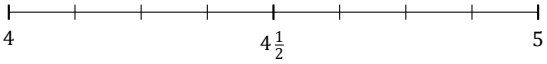

19. $6\frac{4}{10} \simeq$

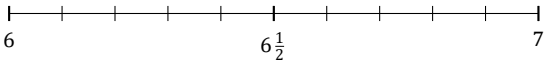
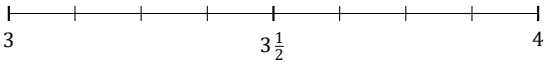
20. $3\frac{4}{8} \simeq$