Représentation de Nombres (C)

Quel chiffre est représenté par chaque groupe de blocs d'unité?

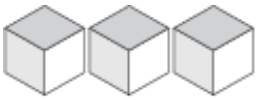

_____

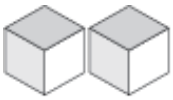

_____

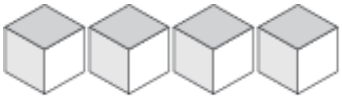

_____

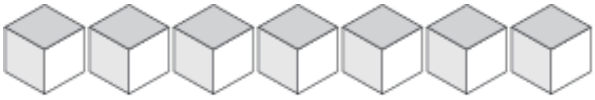

_____

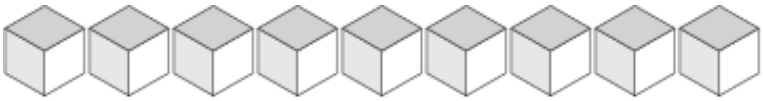

_____

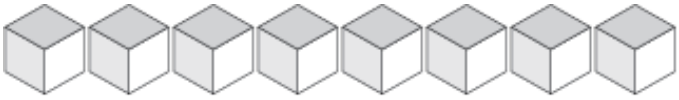

_____

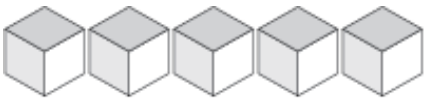

_____

_____

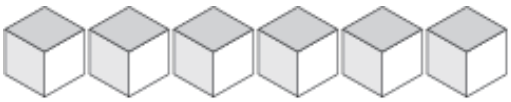

_____