Représentation de Nombres (C)

Quel chiffre est représenté par chaque groupe de blocs d'unité?

1

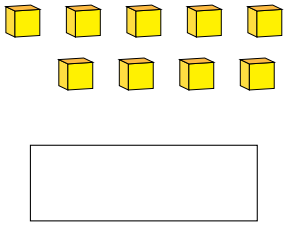

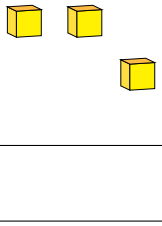

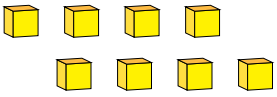

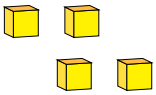

Représentation de Nombres (C) Réponses

Quel chiffre est représenté par chaque groupe de blocs d'unité?

1

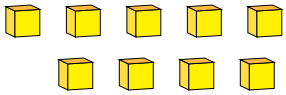

9

2

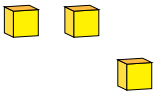

3

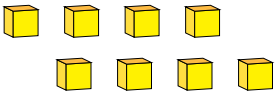

8

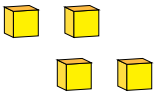

4

1