Échange de Blocs de Base Dix (G)

Combien d'unités pouvez-vous échanger pour des dizaines? Combien vous en restera-t-il?

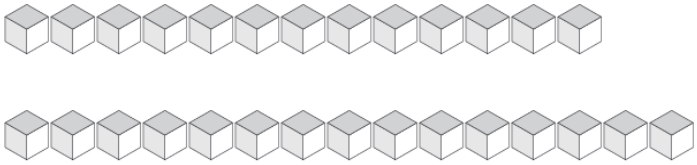

Dizaines	Unités

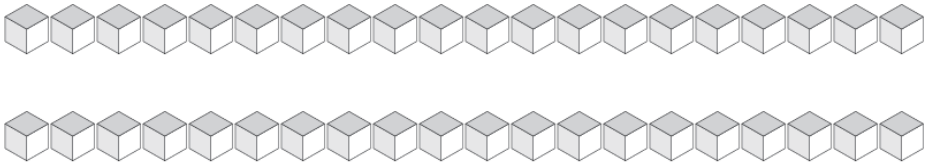

Dizaines	Unités

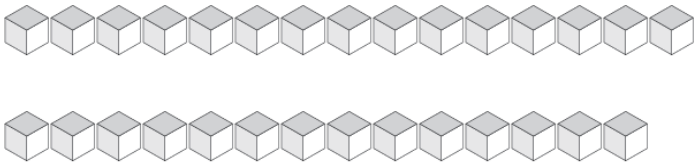

Dizaines	Unités

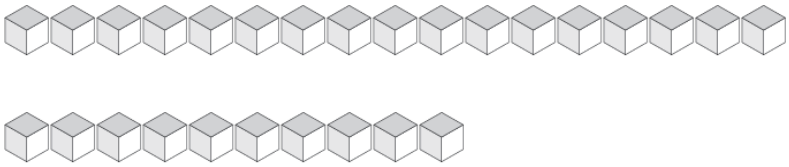

Dizaines	Unités

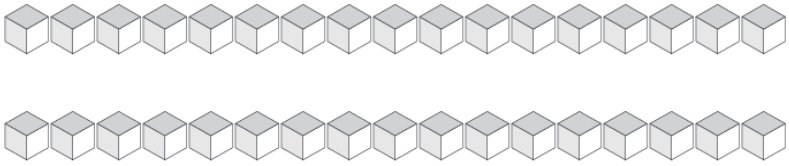

Dizaines	Unités

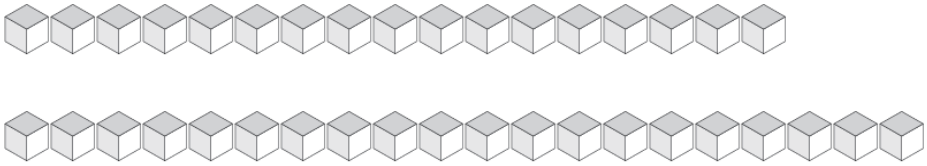

Dizaines	Unités

Échange de Blocs de Base Dix (G) Solutions

Combien d'unités pouvez-vous échanger pour des dizaines? Combien vous en restera-t-il?

Dizaines	Unités
2	8

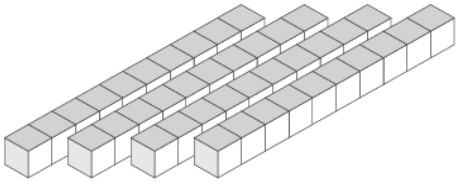

Dizaines	Unités
4	0

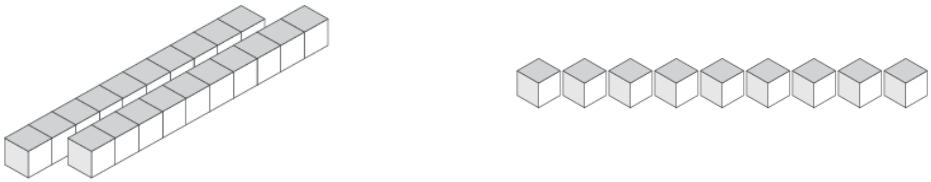

Dizaines	Unités
2	9



Dizaines	Unités
2	7

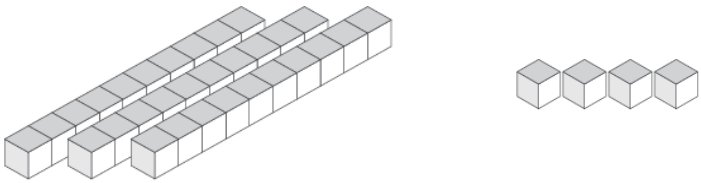

Dizaines	Unités
3	4

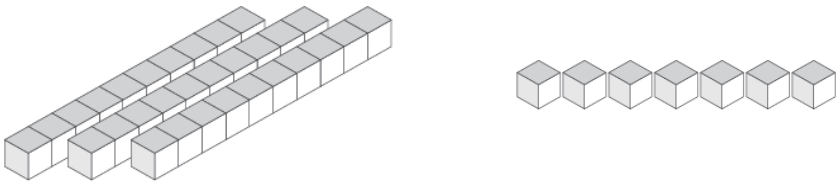

Dizaines	Unités
3	7