Place d'Aiguiles sur Une Horloge Analogique (D)

Nom: _____ Date: _____

Placer les aiguilles de l'horloge pour qu'elles montrent le temps indiqué.

1.



04h09m35s

2.



09h39m05s

3.



22h10m50s

4.



13h30m25s

Place d'Aiguiles sur Une Horloge Analogique (D) Solutions

Nom: _____ Date: _____

Placer les aiguilles de l'horloge pour qu'elles montrent le temps indiqué.

1.



04h09m35s

2.



09h39m05s

3.



22h10m50s

4.



13h30m25s