Place d'Aiguiles sur Une Horloge Analogique (A)

Nom: _____ Date: _____

Placer les aiguilles de l'horloge pour qu'elles montrent le temps indiqué.

1.



9:00 AM

2.



5:00 PM

3.



5:00 AM

4.



11:00 PM