Place d'Aiguiles sur Une Horloge Analogique (D)

Nom: _____ Date: _____

Placer les aiguilles de l'horloge pour qu'elles montrent le temps indiqué.

1.



9:30 AM

2.



7:30 PM

3.



1:00 PM

4.



12:00 AM

Place d'Aiguiles sur Une Horloge Analogique (D) Solutions

Nom: _____ Date: _____

Placer les aiguilles de l'horloge pour qu'elles montrent le temps indiqué.

1.

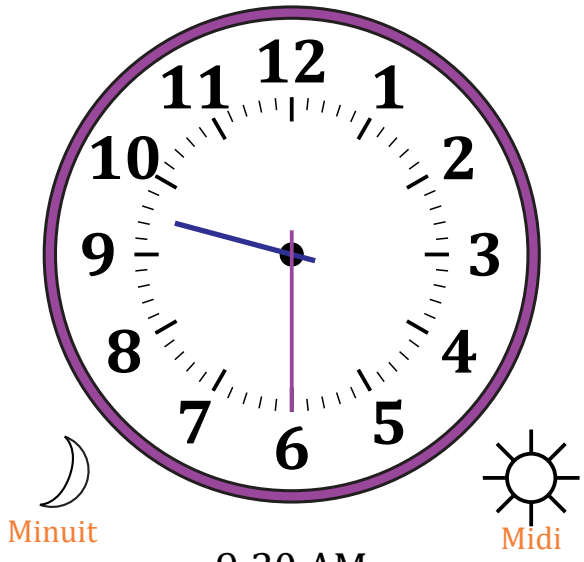

9:30 AM

2.

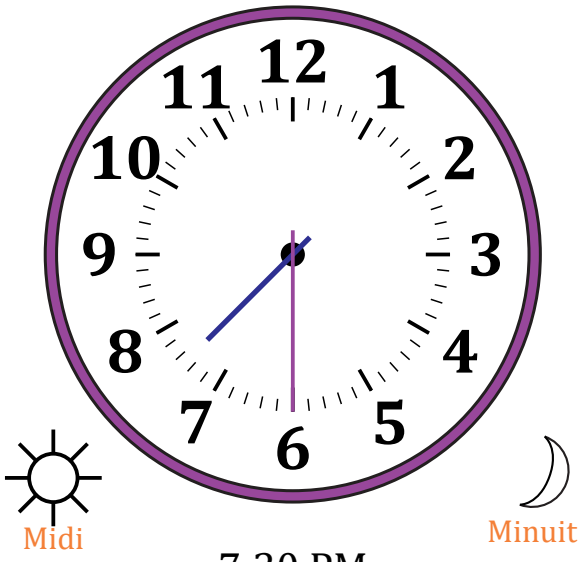

7:30 PM

3.

1:00 PM

4.



12:00 AM