Place d'Aiguiles sur Une Horloge Analogique (C)

Nom: _____ Date: _____

Placer les aiguilles de l'horloge pour qu'elles montrent le temps indiqué.

1.



10:30 PM

2.



3:30 AM

3.



4:00 PM

4.



10:00 AM

Place d'Aiguiles sur Une Horloge Analogique (C) Solutions

Nom: _____ Date: _____

Placer les aiguilles de l'horloge pour qu'elles montrent le temps indiqué.

1.

10:30 PM

2.

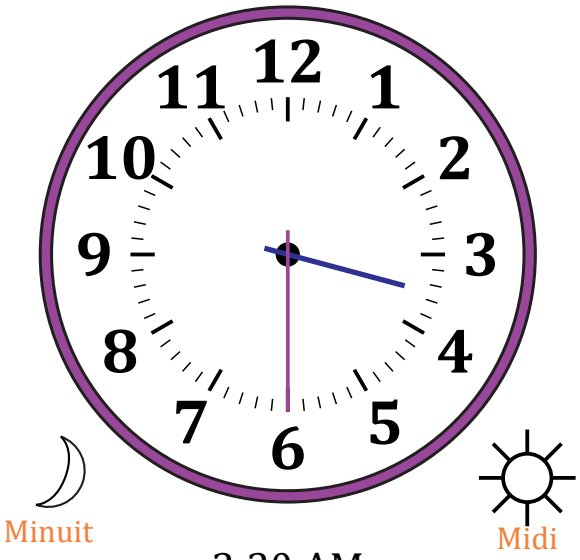

3:30 AM

3.

4:00 PM

4.

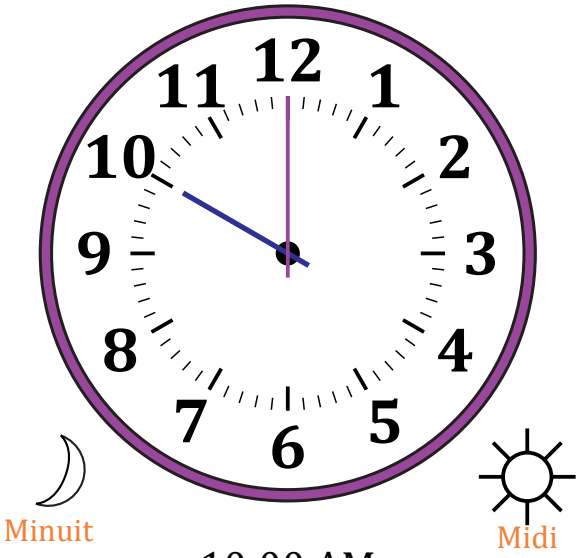

10:00 AM