Place d'Aiguiles sur Une Horloge Analogique (H)

Nom: _____ Date: _____

Placer les aiguilles de l'horloge pour qu'elles montrent le temps indiqué.

1.



10:30 PM

2.

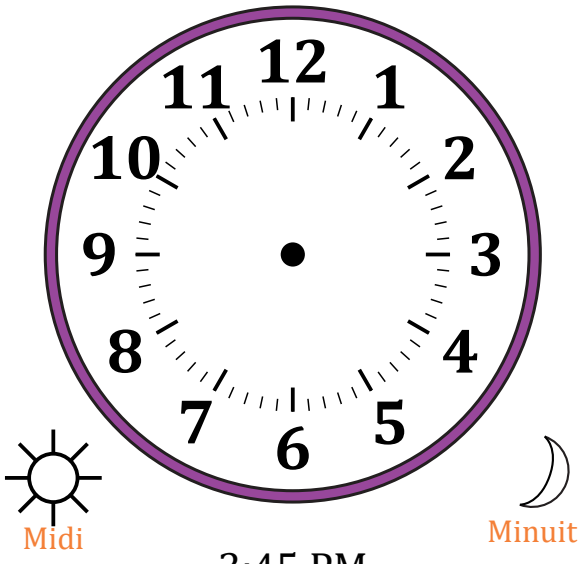

3:45 PM

3.



1:15 AM

4.



7:00 AM

Place d'Aiguiles sur Une Horloge Analogique (H) Solutions

Nom: _____ Date: _____

Placer les aiguilles de l'horloge pour qu'elles montrent le temps indiqué.

1.

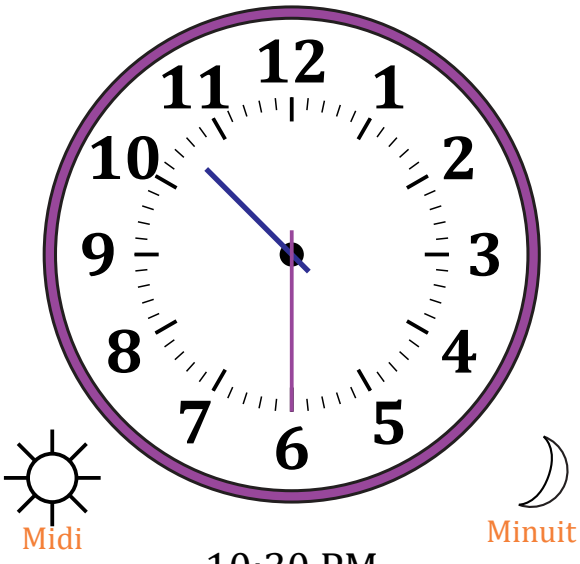

10:30 PM

2.

3:45 PM

3.

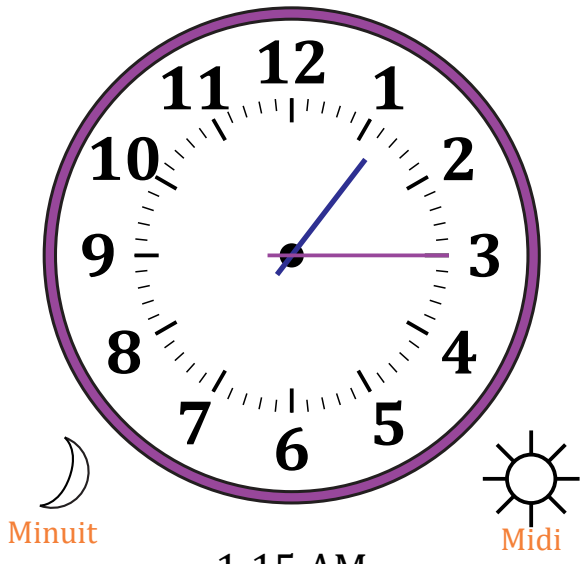

1:15 AM

4.

7:00 AM