Place d'Aiguiles sur Une Horloge Analogique (G)

Nom: _____ Date: _____

Placer les aiguilles de l'horloge pour qu'elles montrent le temps indiqué.

1.



6:45 AM

2.



3:35 AM

3.



9:00 PM

4.



1:25 PM