Place d'Aiguiles sur Une Horloge Analogique (C)

Nom: _____ Date: _____

Placer les aiguilles de l'horloge pour qu'elles montrent le temps indiqué.

1.



2:45 PM

2.



6:15 PM

3.



10:30 AM

4.



2:00 AM