Place d'Aiguiles sur Une Horloge Analogique (A)

Nom: _____ Date: _____

Placer les aiguilles de l'horloge pour qu'elles montrent le temps indiqué.

1. 

3:43:00 PM

2. 

7:54:00 AM

3. 

5:58:30 PM

4.

5:35:30 AM

5. 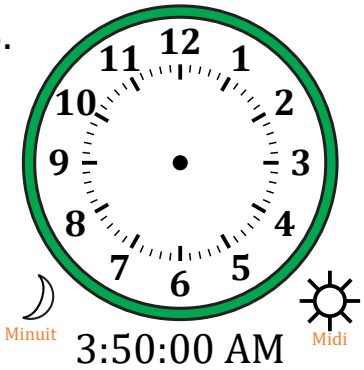

3:50:00 AM

6. 

11:48:00 PM

7. 

8:11:30 PM

8. 

1:16:30 PM

9. 

9:30:00 AM

10. 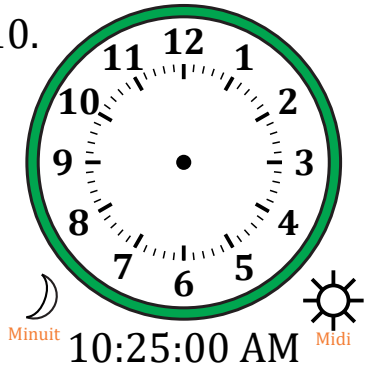

10:25:00 AM

11. 

7:34:30 PM

12. 

12:16:30 AM

Place d'Aiguiles sur Une Horloge Analogique (A) Solutions

Nom: _____ Date: _____

Placer les aiguilles de l'horloge pour qu'elles montrent le temps indiqué.

1. 

3:43:00 PM

2.

7:54:00 AM

3.

5:58:30 PM

4.

5:35:30 AM

5. 

3:50:00 AM

6. 

11:48:00 PM

7. 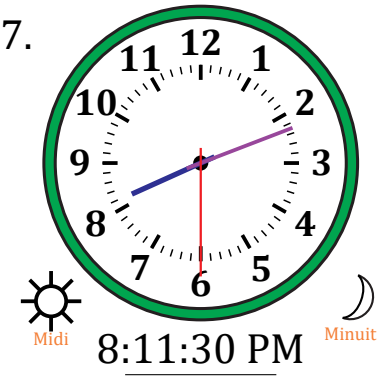

8:11:30 PM

8. 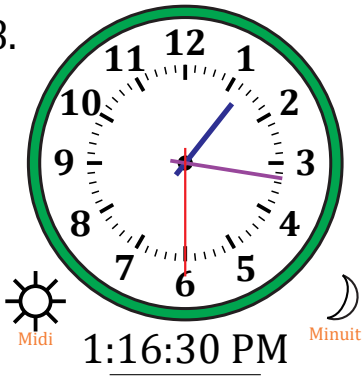

1:16:30 PM

9.

9:30:00 AM

10. 

10:25:00 AM

11.

7:34:30 PM

12. 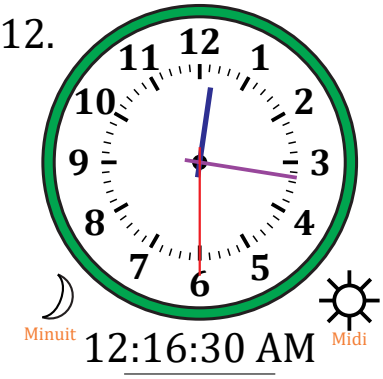

12:16:30 AM

Place d'Aiguiles sur Une Horloge Analogique (B)

Nom: _____ Date: _____

Placer les aiguilles de l'horloge pour qu'elles montrent le temps indiqué.

1. 

10:38:30 AM

2. 

4:31:30 PM

3. 

1:35:00 PM

4. 

3:21:00 AM

5. 

11:40:00 PM

6. 

4:51:00 AM

7. 

7:54:30 AM

8. 

3:06:30 PM

9. 

12:16:00 AM

10. 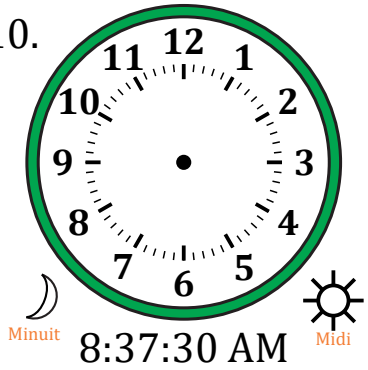

8:37:30 AM

11. 

7:35:30 PM

12. 

9:45:00 PM

Place d'Aiguiles sur Une Horloge Analogique (B) Solutions

Nom: _____ Date: _____

Placer les aiguilles de l'horloge pour qu'elles montrent le temps indiqué.

1.

10:38:30 AM

2.

4:31:30 PM

3. 

1:35:00 PM

4.

3:21:00 AM

5.

11:40:00 PM

6. 

4:51:00 AM

7.

7:54:30 AM

8.

3:06:30 PM

9.

12:16:00 AM

10.

8:37:30 AM

11. 

7:35:30 PM

12.

9:45:00 PM

Place d'Aiguiles sur Une Horloge Analogique (C)

Nom: _____ Date: _____

Placer les aiguilles de l'horloge pour qu'elles montrent le temps indiqué.

1.


6:37:00 PM

2.
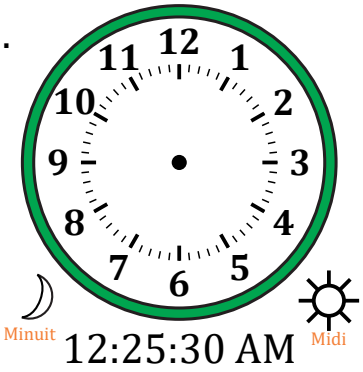

12:25:30 AM

3.

4:32:30 AM

4.


9:54:30 AM

5.
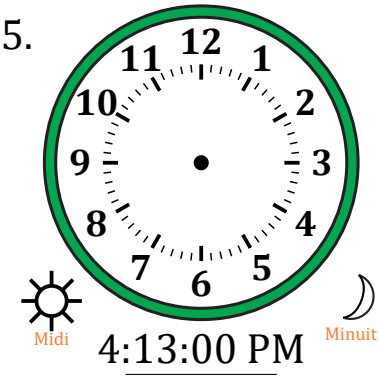

4:13:00 PM

6.


11:55:30 AM

7.


7:45:30 AM

8.
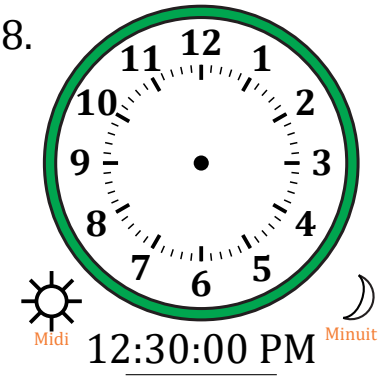

12:30:00 PM

9.


9:20:00 PM

10.


3:48:00 AM

11.
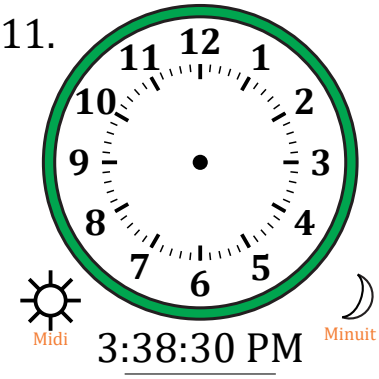

3:38:30 PM

12.
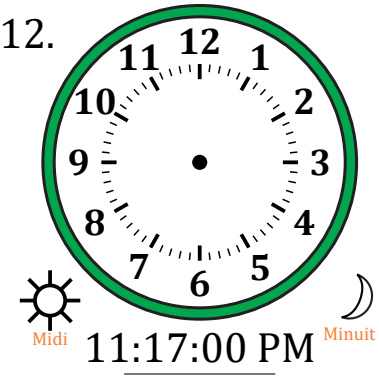

11:17:00 PM

Place d'Aiguiles sur Une Horloge Analogique (C) Solutions

Nom: _____ Date: _____

Placer les aiguilles de l'horloge pour qu'elles montrent le temps indiqué.

1.

6:37:00 PM

2.

12:25:30 AM

3.

4:32:30 AM

4.

9:54:30 AM

5.

4:13:00 PM

6.

11:55:30 AM

7. 

7:45:30 AM

8. 

12:30:00 PM

9. 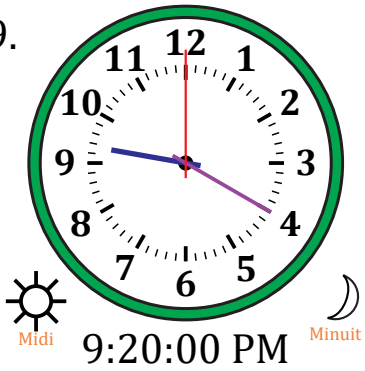

9:20:00 PM

10. 

3:48:00 AM

11.

3:38:30 PM

12.

11:17:00 PM

Place d'Aiguiles sur Une Horloge Analogique (D)

Nom: _____ Date: _____

Placer les aiguilles de l'horloge pour qu'elles montrent le temps indiqué.

1. 

7:27:30 PM

2. 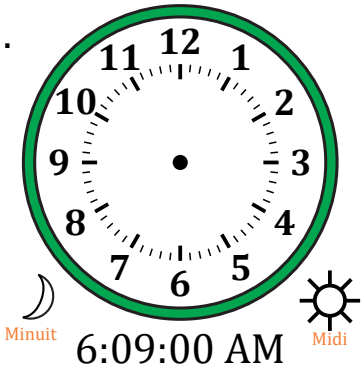

6:09:00 AM

3. 

4:33:00 PM

4. 

5:57:00 AM

5. 

11:03:30 PM

6. 

8:21:30 PM

7. 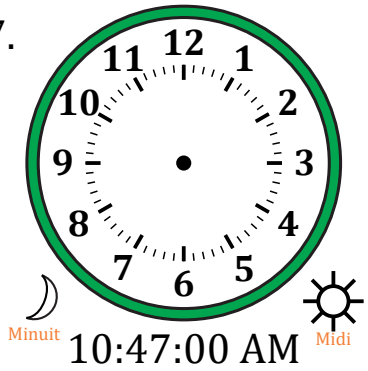

10:47:00 AM

8. 

2:58:00 PM

9. 

2:57:30 AM

10. 

12:42:00 PM

11. 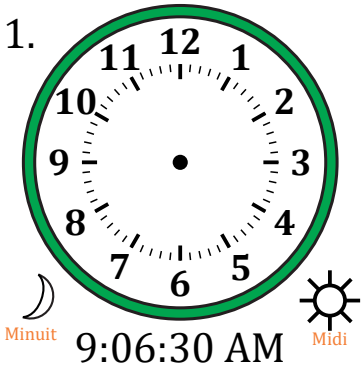

9:06:30 AM

12. 

1:17:30 AM

Place d'Aiguiles sur Une Horloge Analogique (D) Solutions

Nom: _____ Date: _____

Placer les aiguilles de l'horloge pour qu'elles montrent le temps indiqué.

1.

7:27:30 PM

2.

6:09:00 AM

3.

4:33:00 PM

4.

5:57:00 AM

5. 

11:03:30 PM

6. 

8:21:30 PM

7.

10:47:00 AM

8.

2:58:00 PM

9. 

2:57:30 AM

10.

12:42:00 PM

11. 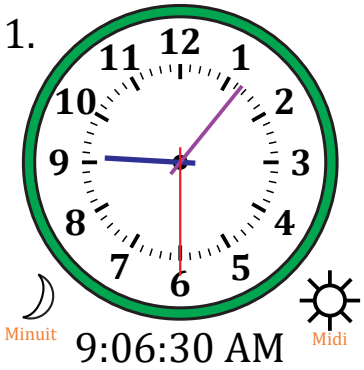

9:06:30 AM

12. 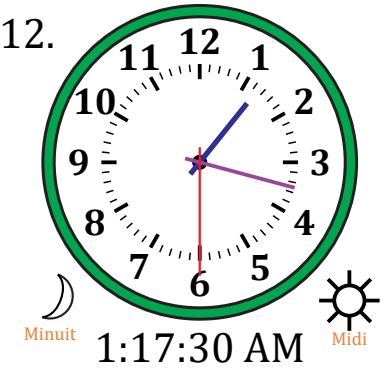

1:17:30 AM

Place d'Aiguiles sur Une Horloge Analogique (E)

Nom: _____ Date: _____

Placer les aiguilles de l'horloge pour qu'elles montrent le temps indiqué.

1.


8:21:00 PM

2.


6:43:30 PM

3.

2:35:00 AM

4.


3:51:00 PM

5.


5:31:30 AM

6.
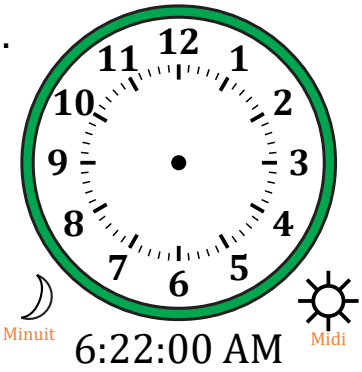

6:22:00 AM

7.


10:54:30 AM

8.


11:21:30 PM

9.


1:13:00 PM

10.


1:53:30 AM

11.


9:09:00 AM

12.


5:42:30 PM

Place d'Aiguiles sur Une Horloge Analogique (E) Solutions

Nom: _____ Date: _____

Placer les aiguilles de l'horloge pour qu'elles montrent le temps indiqué.

1.


8:21:00 PM

2.

6:43:30 PM

3.

2:35:00 AM

4.
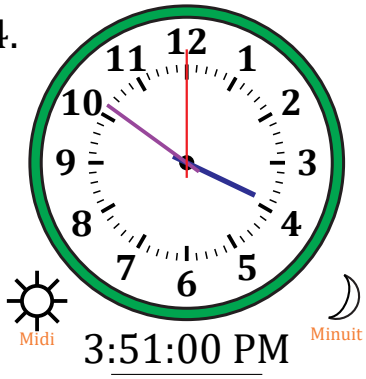

3:51:00 PM

5.


5:31:30 AM

6.


6:22:00 AM

7.


10:54:30 AM

8.
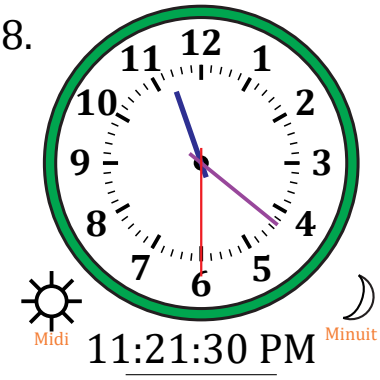

11:21:30 PM

9.


1:13:00 PM

10.
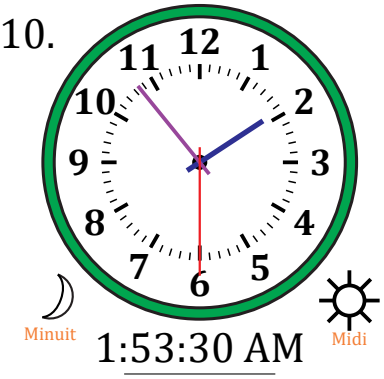

1:53:30 AM

11.


9:09:00 AM

12.

5:42:30 PM

Place d'Aiguiles sur Une Horloge Analogique (F)

Nom: _____ Date: _____

Placer les aiguilles de l'horloge pour qu'elles montrent le temps indiqué.

1.


2:29:00 PM

2.
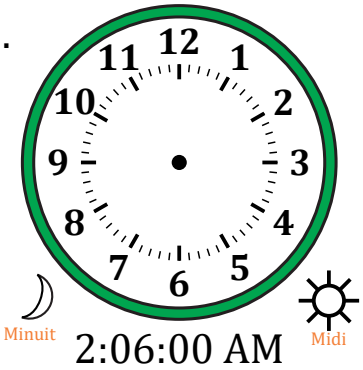

2:06:00 AM

3.


5:13:00 PM

4.


7:10:30 PM

5.
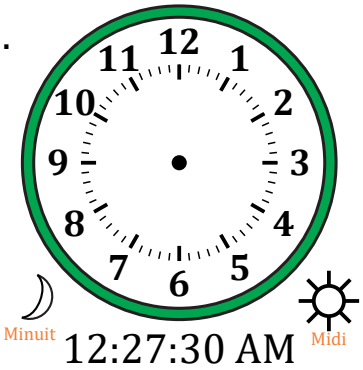

12:27:30 AM

6.


10:37:30 PM

7.


8:27:30 AM

8.


1:23:00 PM

9.


9:01:00 PM

10.


7:49:30 AM

11.
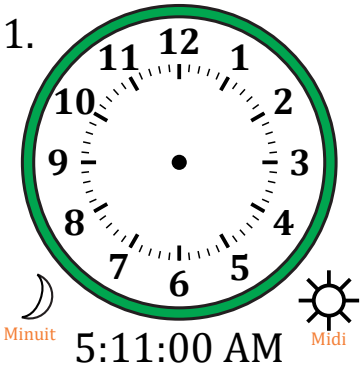

5:11:00 AM

12.


11:44:30 AM

Place d'Aiguiles sur Une Horloge Analogique (F) Solutions

Nom: _____ Date: _____

Placer les aiguilles de l'horloge pour qu'elles montrent le temps indiqué.

1. 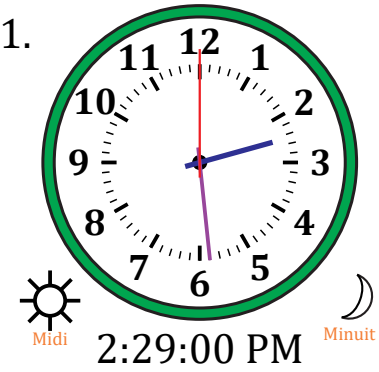

2:29:00 PM

2.

2:06:00 AM

3. 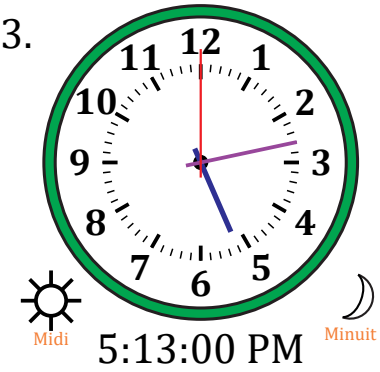

5:13:00 PM

4. 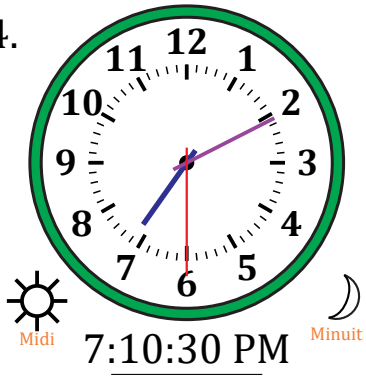

7:10:30 PM

5. 

12:27:30 AM

6. 

10:37:30 PM

7. 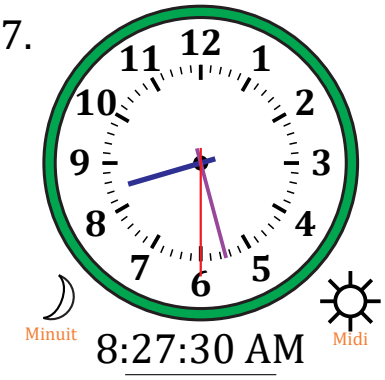

8:27:30 AM

8. 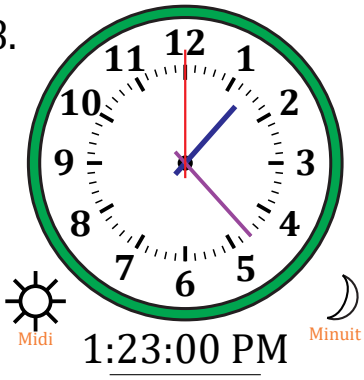

1:23:00 PM

9. 

9:01:00 PM

10. 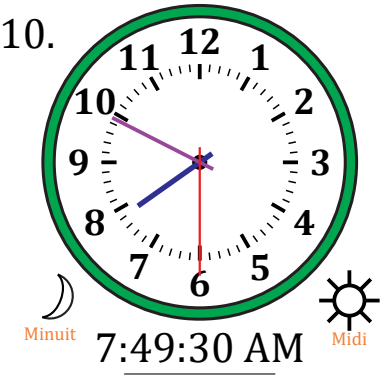

7:49:30 AM

11. 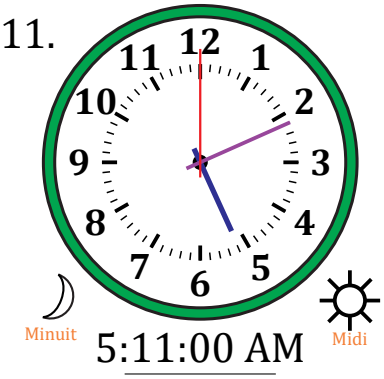

5:11:00 AM

12. 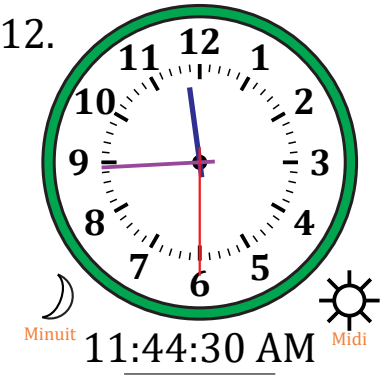

11:44:30 AM

Place d'Aiguiles sur Une Horloge Analogique (G)

Nom: _____ Date: _____

Placer les aiguilles de l'horloge pour qu'elles montrent le temps indiqué.

1. 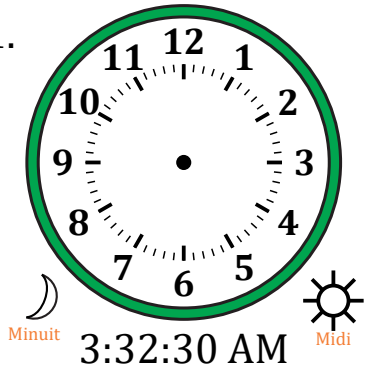

3:32:30 AM

2. 

6:48:00 PM

3. 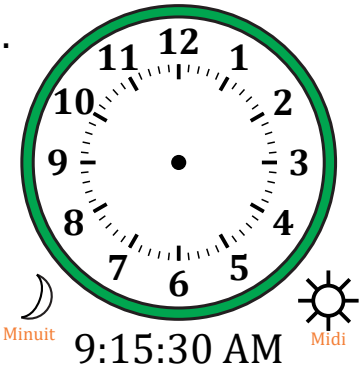

9:15:30 AM

4.

11:29:00 AM

5. 

12:10:30 AM

6. 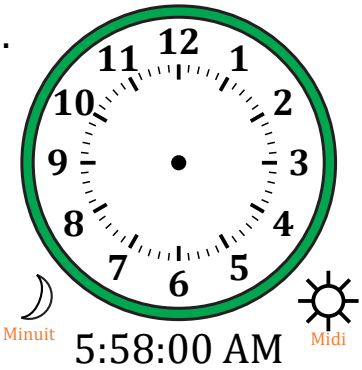

5:58:00 AM

7. 

2:21:00 PM

8. 

6:41:30 AM

9. 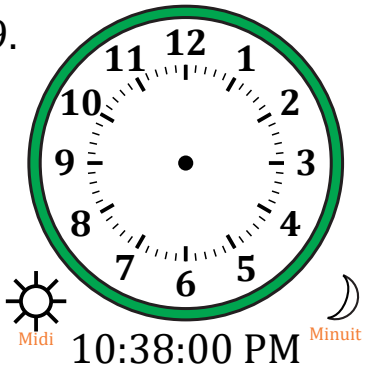

10:38:00 PM

10. 

1:35:00 PM

11. 

4:09:30 PM

12. 

8:16:30 PM

Place d'Aiguiles sur Une Horloge Analogique (G) Solutions

Nom: _____ Date: _____

Placer les aiguilles de l'horloge pour qu'elles montrent le temps indiqué.

1.


3:32:30 AM

2.


6:48:00 PM

3.


9:15:30 AM

4.


11:29:00 AM

5.


12:10:30 AM

6.


5:58:00 AM

7.


2:21:00 PM

8.


6:41:30 AM

9.


10:38:00 PM

10.


1:35:00 PM

11.


4:09:30 PM

12.


8:16:30 PM

Place d'Aiguiles sur Une Horloge Analogique (H)

Nom: _____ Date: _____

Placer les aiguilles de l'horloge pour qu'elles montrent le temps indiqué.

1.

11:53:30 AM

2.


10:08:30 PM

3.
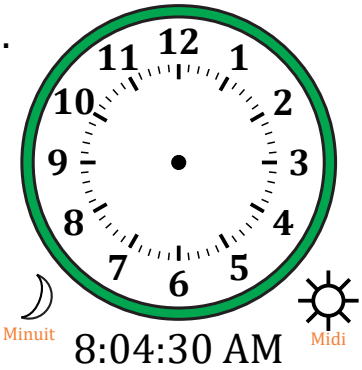

8:04:30 AM

4.


7:14:00 AM

5.


3:20:30 AM

6.


1:06:00 PM

7.


12:57:30 AM

8.


4:46:30 PM

9.
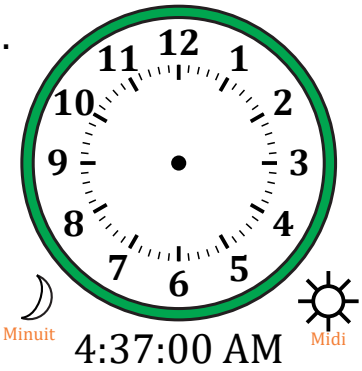

4:37:00 AM

10.


9:09:00 PM

11.


3:59:00 PM

12.


6:34:00 PM

Place d'Aiguiles sur Une Horloge Analogique (H) Solutions

Nom: _____ Date: _____

Placer les aiguilles de l'horloge pour qu'elles montrent le temps indiqué.

1.


11:53:30 AM

2.

10:08:30 PM

3.

8:04:30 AM

4.

7:14:00 AM

5.


3:20:30 AM

6.

1:06:00 PM

7.

12:57:30 AM

8.

4:46:30 PM

9.
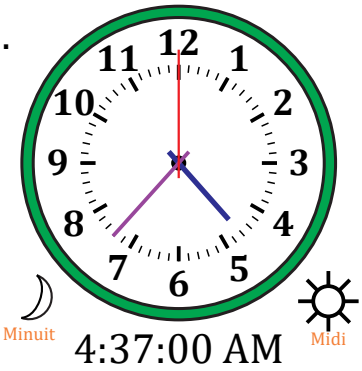

4:37:00 AM

10.


9:09:00 PM

11.

3:59:00 PM

12.

6:34:00 PM

Place d'Aiguiles sur Une Horloge Analogique (I)

Nom: _____ Date: _____

Placer les aiguilles de l'horloge pour qu'elles montrent le temps indiqué.

1. 

9:51:00 PM

2. 

6:41:30 AM

3. 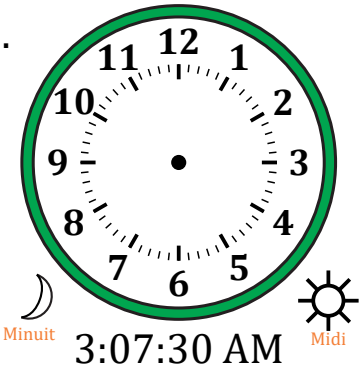

3:07:30 AM

4. 

4:50:00 PM

5. 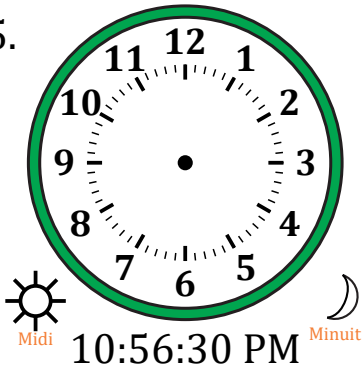

10:56:30 PM

6. 

11:07:00 AM

7. 

4:58:00 AM

8. 

7:08:30 PM

9. 

2:43:00 PM

10. 

12:40:30 AM

11. 

9:04:30 AM

12. 

1:31:00 PM

Place d'Aiguiles sur Une Horloge Analogique (I) Solutions

Nom: _____ Date: _____

Placer les aiguilles de l'horloge pour qu'elles montrent le temps indiqué.

1. 

9:51:00 PM

2.

6:41:30 AM

3. 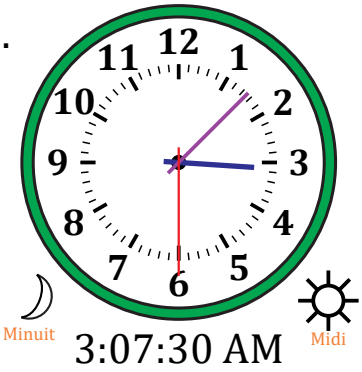

3:07:30 AM

4. 

4:50:00 PM

5. 

10:56:30 PM

6.

11:07:00 AM

7. 

4:58:00 AM

8. 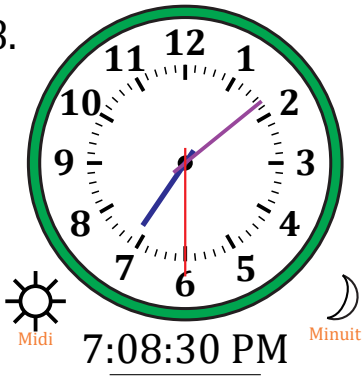

7:08:30 PM

9. 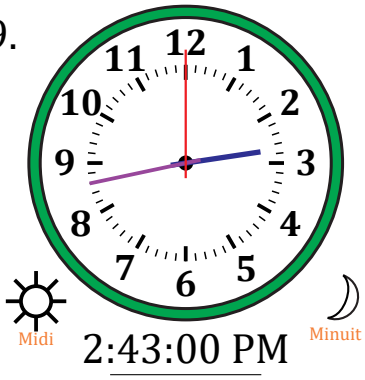

2:43:00 PM

10. 

12:40:30 AM

11. 

9:04:30 AM

12. 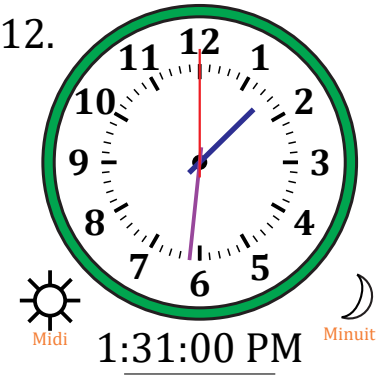

1:31:00 PM

Place d'Aiguiles sur Une Horloge Analogique (J)

Nom: _____ Date: _____

Placer les aiguilles de l'horloge pour qu'elles montrent le temps indiqué.

1.


9:44:30 PM

2.


8:40:30 AM

3.


11:56:00 PM

4.


7:35:00 PM

5.
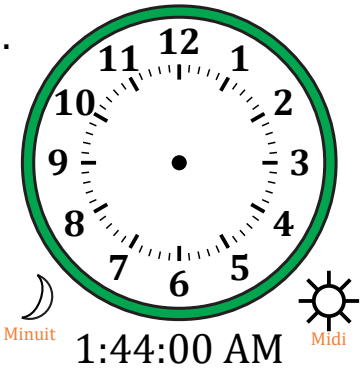

1:44:00 AM

6.


11:49:30 AM

7.


5:25:00 AM

8.


3:55:30 PM

9.


12:27:00 PM

10.


2:42:30 AM

11.


5:28:30 PM

12.


6:59:00 AM

Place d'Aiguiles sur Une Horloge Analogique (J) Solutions

Nom: _____ Date: _____

Placer les aiguilles de l'horloge pour qu'elles montrent le temps indiqué.

1. 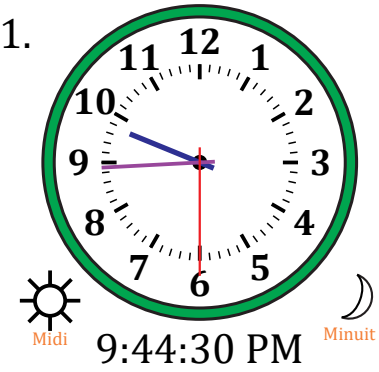

9:44:30 PM

2.

8:40:30 AM

3. 

11:56:00 PM

4.

7:35:00 PM

5. 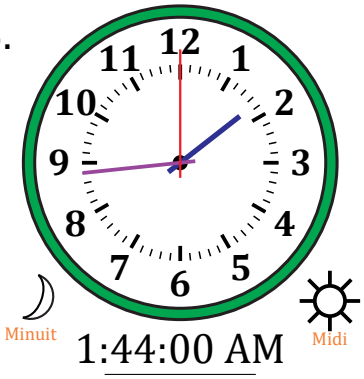

1:44:00 AM

6. 

11:49:30 AM

7. 

5:25:00 AM

8. 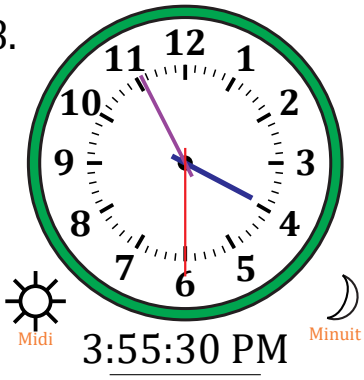

3:55:30 PM

9. 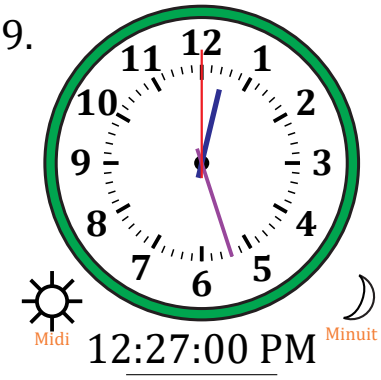

12:27:00 PM

10. 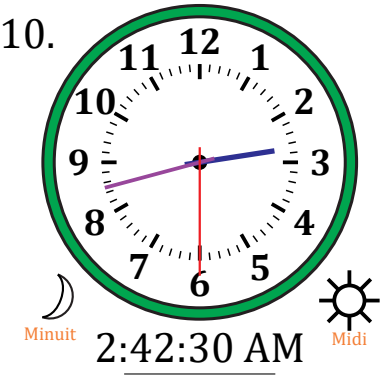

2:42:30 AM

11.

5:28:30 PM

12.

6:59:00 AM