Place d'Aiguiles sur Une Horloge Analogique (I)

Nom: _____ Date: _____

Placer les aiguilles de l'horloge pour qu'elles montrent le temps indiqué.

1. 

8:01:05 AM

2. 

8:29:10 PM

3. 

6:34:15 PM

4. 

7:35:00 AM

5. 

5:13:45 PM

6. 

1:38:30 AM

7. 

5:54:55 AM

8. 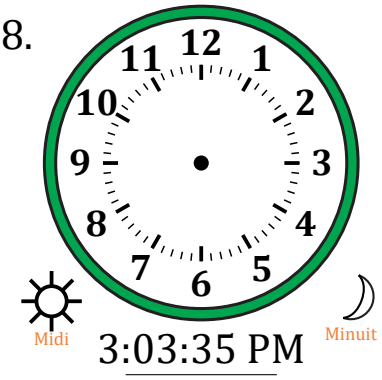

3:03:35 PM

9. 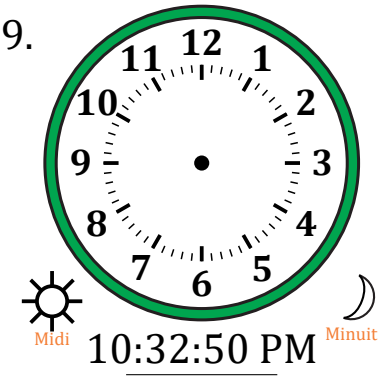

10:32:50 PM

10. 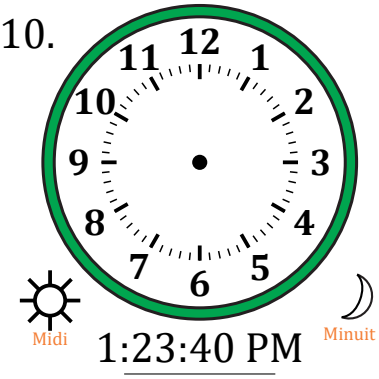

1:23:40 PM

11. 

2:35:20 AM

12. 

10:14:25 AM