Place d'Aiguiles sur Une Horloge Analogique (A)

Nom: _____ Date: _____

Placer les aiguilles de l'horloge pour qu'elles montrent le temps indiqué.

1. 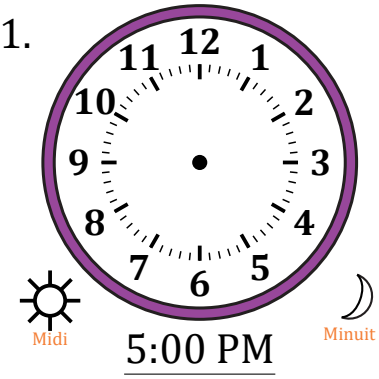

5:00 PM

2. 

6:00 AM

3. 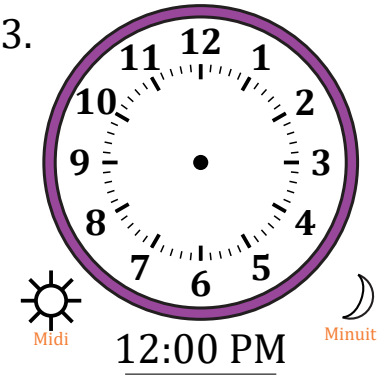

12:00 PM

4. 

9:00 PM

5. 

9:00 AM

6. 

11:00 AM

7. 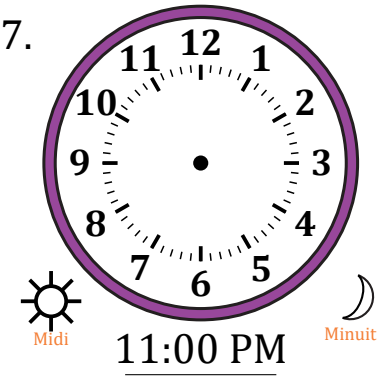

11:00 PM

8. 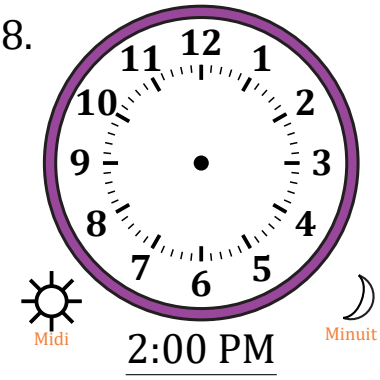

2:00 PM

9. 

3:00 AM

10. 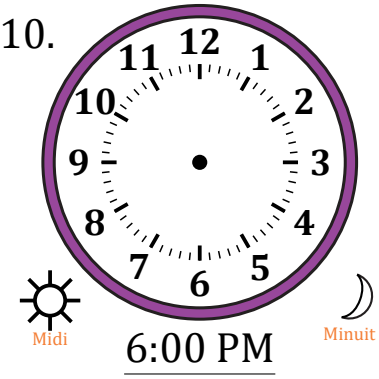

6:00 PM

11. 

5:00 AM

12. 

1:00 AM

Place d'Aiguiles sur Une Horloge Analogique (A) Solutions

Nom: _____ Date: _____

Placer les aiguilles de l'horloge pour qu'elles montrent le temps indiqué.

1. 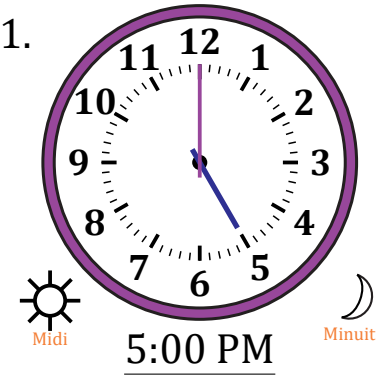

5:00 PM

2. 

6:00 AM

3. 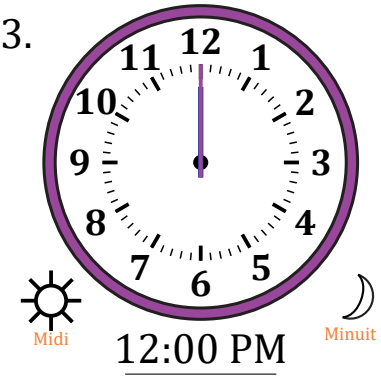

12:00 PM

4.

9:00 PM

5.

9:00 AM

6. 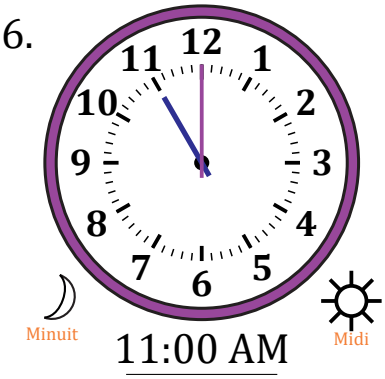

11:00 AM

7. 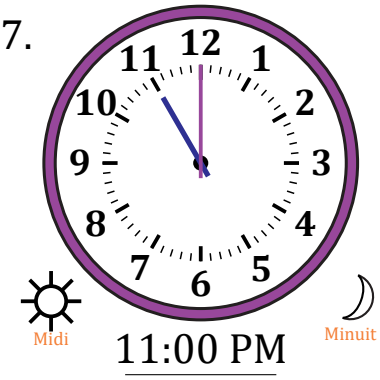

11:00 PM

8. 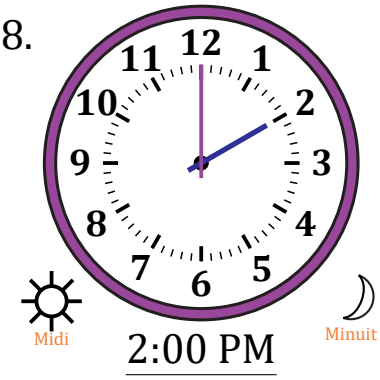

2:00 PM

9. 

3:00 AM

10. 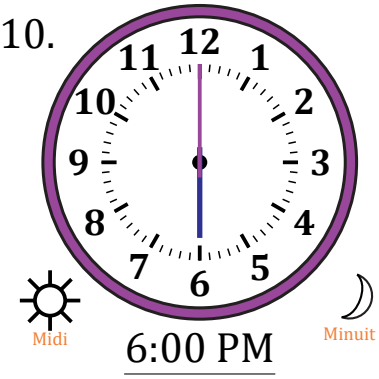

6:00 PM

11. 

5:00 AM

12. 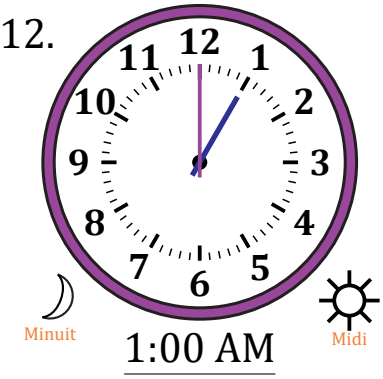

1:00 AM

Place d'Aiguiles sur Une Horloge Analogique (B)

Nom: _____ Date: _____

Placer les aiguilles de l'horloge pour qu'elles montrent le temps indiqué.

1. 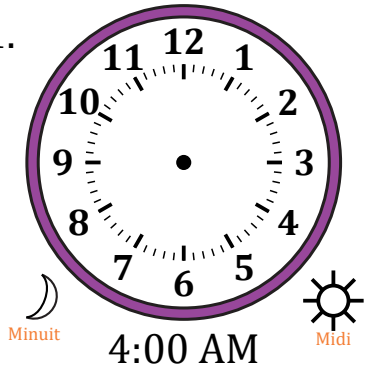

4:00 AM

2. 

8:00 PM

3. 

1:00 AM

4. 

11:00 AM

5. 

9:00 AM

6. 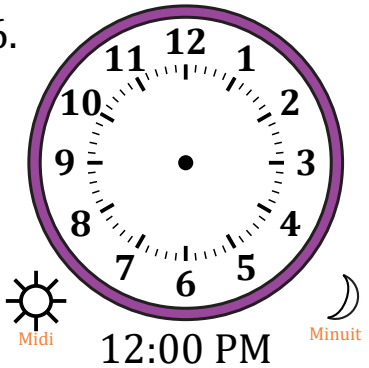

12:00 PM

7. 

3:00 AM

8. 

11:00 PM

9. 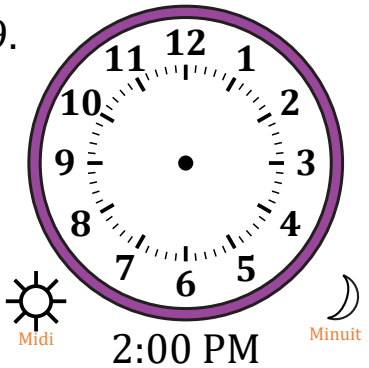

2:00 PM

10. 

7:00 PM

11. 

7:00 AM

12. 

5:00 PM

Place d'Aiguiles sur Une Horloge Analogique (B) Solutions

Nom: _____ Date: _____

Placer les aiguilles de l'horloge pour qu'elles montrent le temps indiqué.

1.
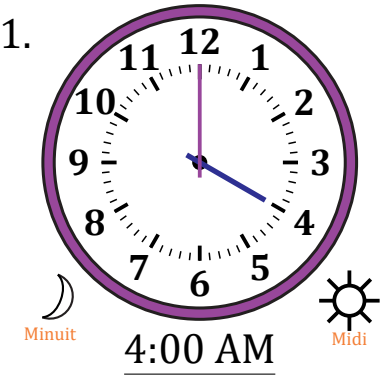

4:00 AM

2.
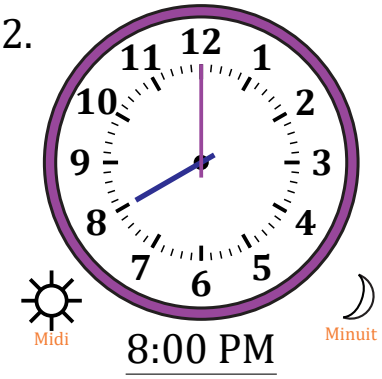

8:00 PM

3.


1:00 AM

4.


11:00 AM

5.


9:00 AM

6.
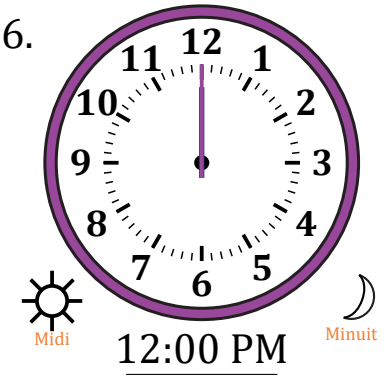

12:00 PM

7.
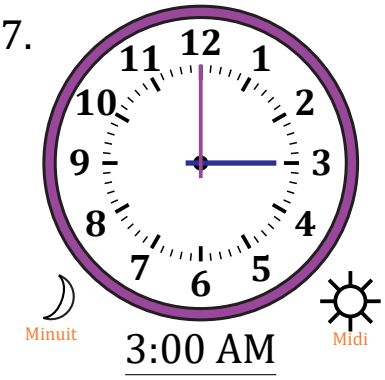

3:00 AM

8.
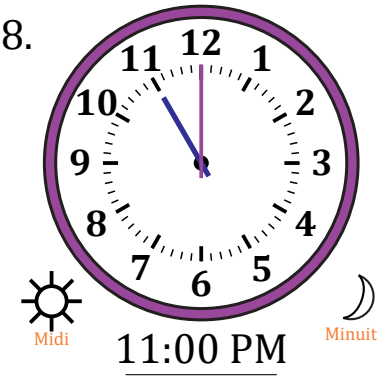

11:00 PM

9.
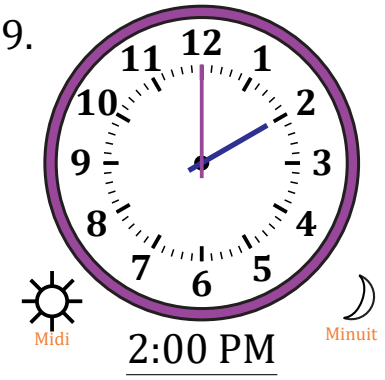

2:00 PM

10.
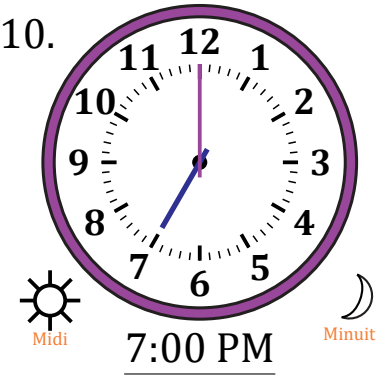

7:00 PM

11.
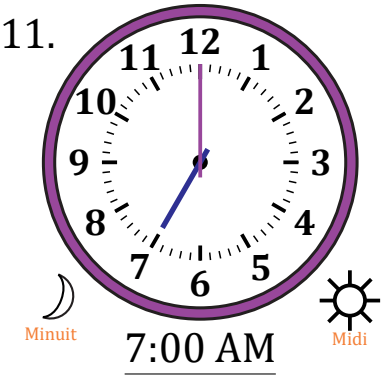

7:00 AM

12.

5:00 PM

Place d'Aiguiles sur Une Horloge Analogique (C)

Nom: _____ Date: _____

Placer les aiguilles de l'horloge pour qu'elles montrent le temps indiqué.

1. 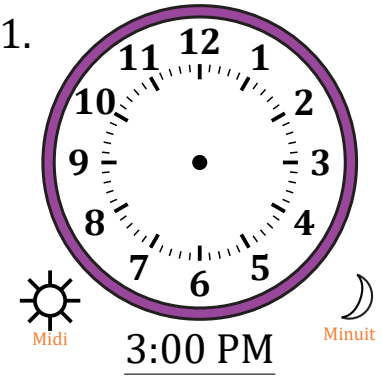

3:00 PM

2. 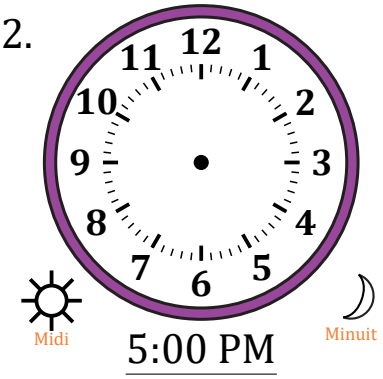

5:00 PM

3. 

9:00 AM

4. 

4:00 AM

5. 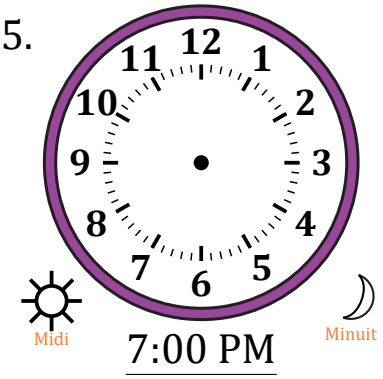

7:00 PM

6. 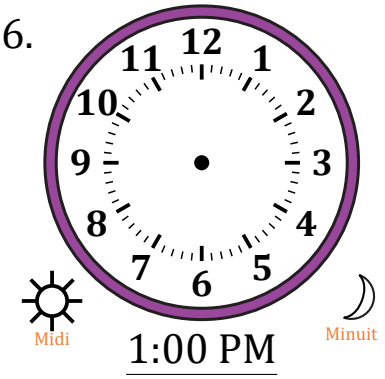

1:00 PM

7. 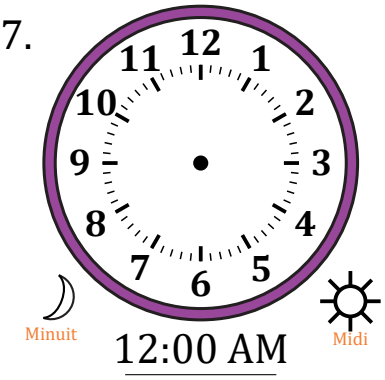

12:00 AM

8. 

11:00 AM

9. 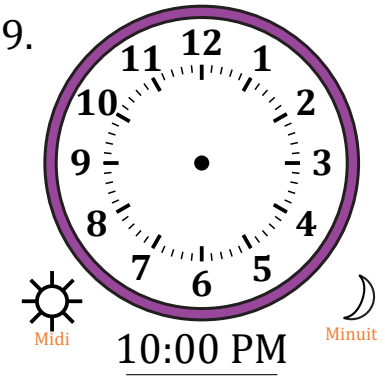

10:00 PM

10. 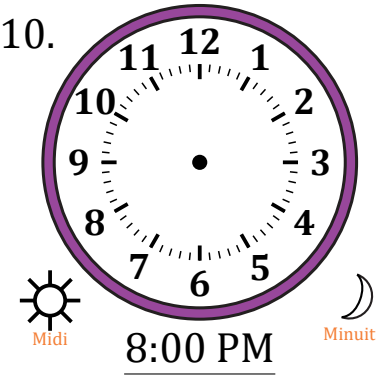

8:00 PM

11. 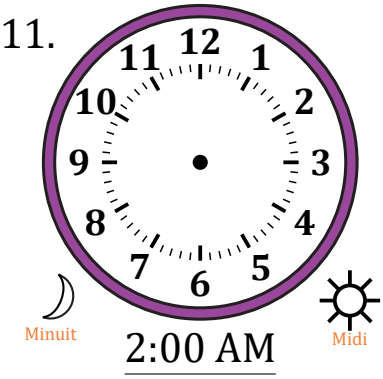

2:00 AM

12. 

7:00 AM

Place d'Aiguiles sur Une Horloge Analogique (C) Solutions

Nom: _____ Date: _____

Placer les aiguilles de l'horloge pour qu'elles montrent le temps indiqué.

1. 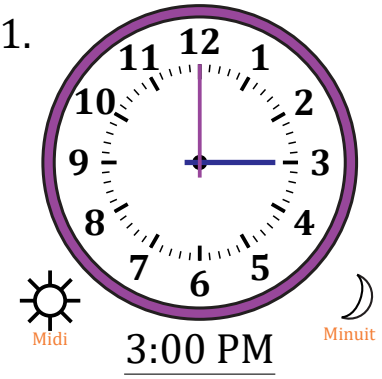

3:00 PM

2. 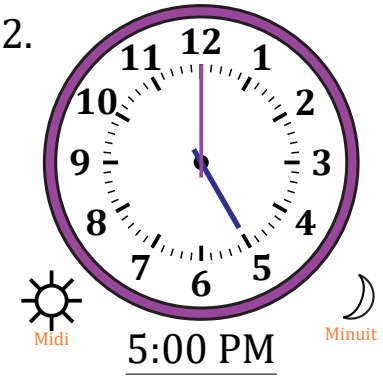

5:00 PM

3. 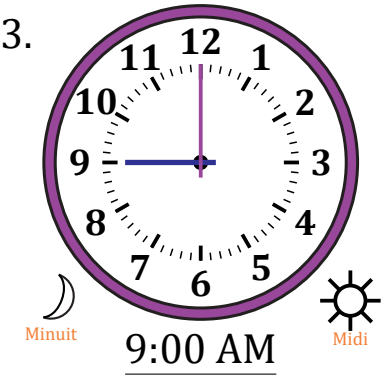

9:00 AM

4. 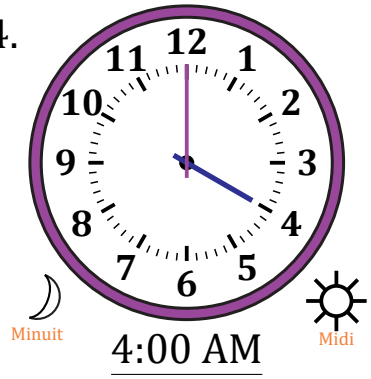

4:00 AM

5. 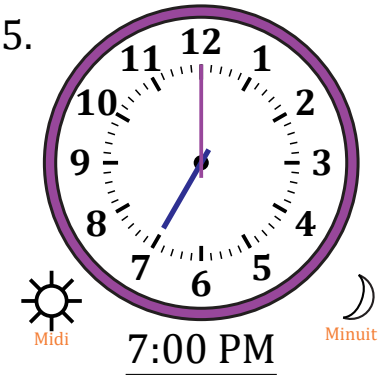

7:00 PM

6. 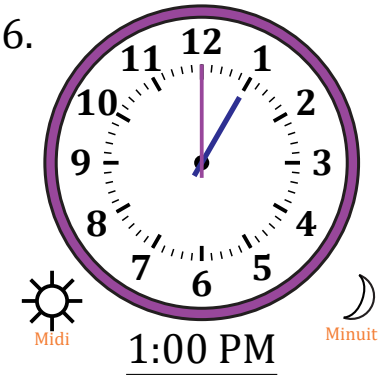

1:00 PM

7. 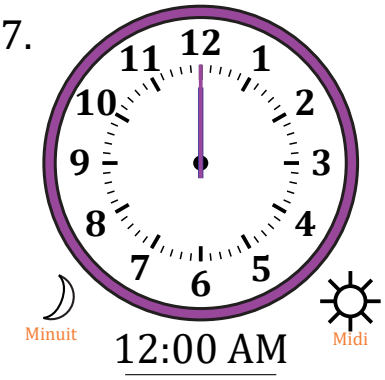

12:00 AM

8. 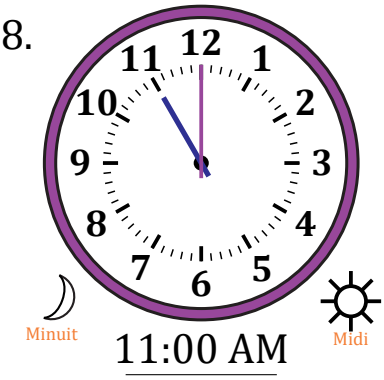

11:00 AM

9. 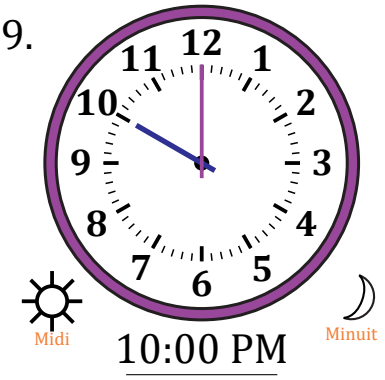

10:00 PM

10. 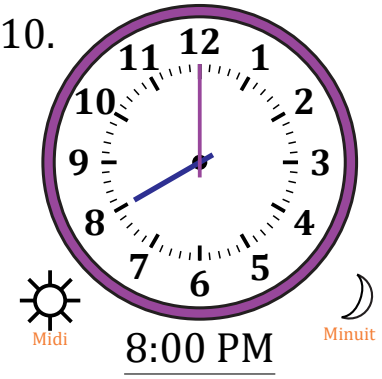

8:00 PM

11. 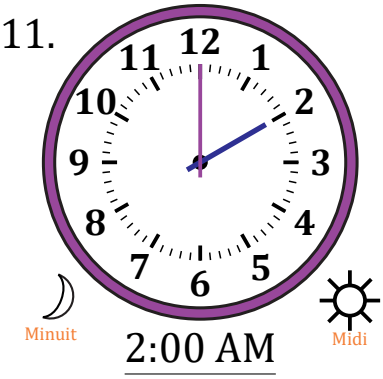

2:00 AM

12. 

7:00 AM

Place d'Aiguiles sur Une Horloge Analogique (D)

Nom: _____ Date: _____

Placer les aiguilles de l'horloge pour qu'elles montrent le temps indiqué.

1. 

9:00 AM

2. 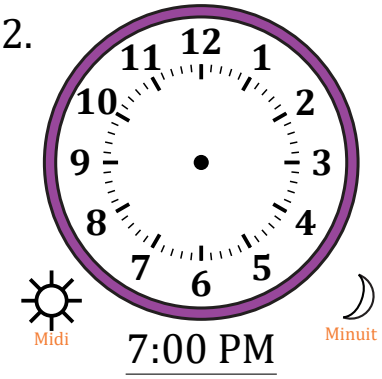

7:00 PM

3. 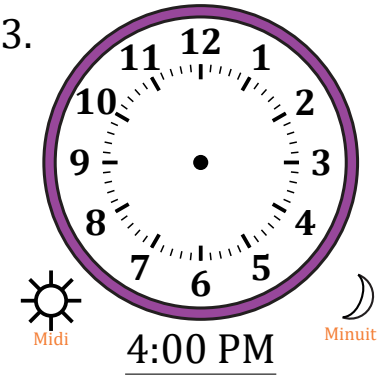

4:00 PM

4. 

3:00 AM

5. 

6:00 AM

6. 

12:00 AM

7. 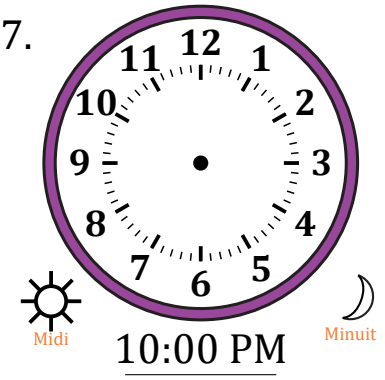

10:00 PM

8. 

10:00 AM

9. 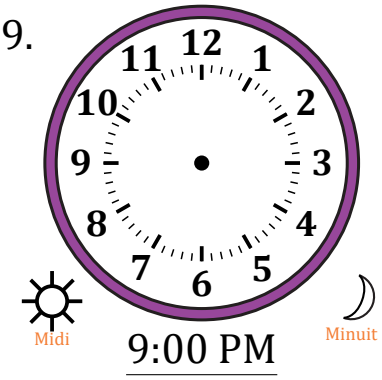

9:00 PM

10. 

5:00 AM

11. 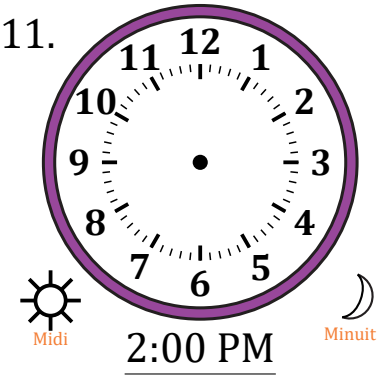

2:00 PM

12. 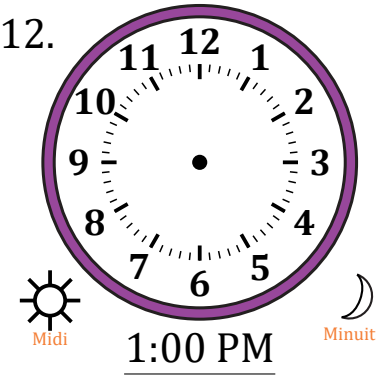

1:00 PM

Place d'Aiguiles sur Une Horloge Analogique (D) Solutions

Nom: _____ Date: _____

Placer les aiguilles de l'horloge pour qu'elles montrent le temps indiqué.

1. 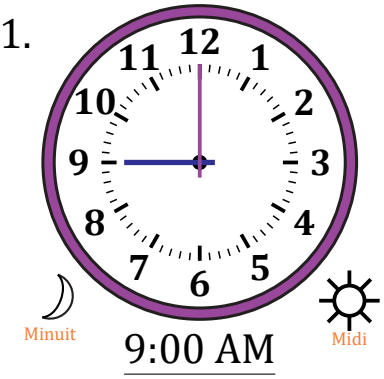

9:00 AM

2. 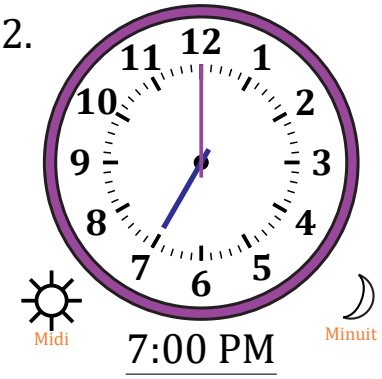

7:00 PM

3. 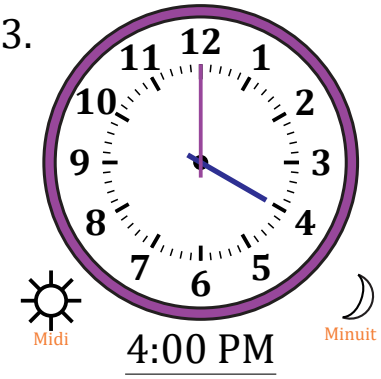

4:00 PM

4. 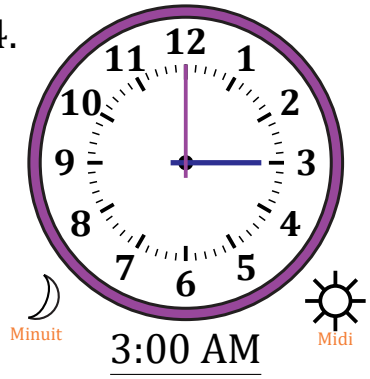

3:00 AM

5. 

6:00 AM

6. 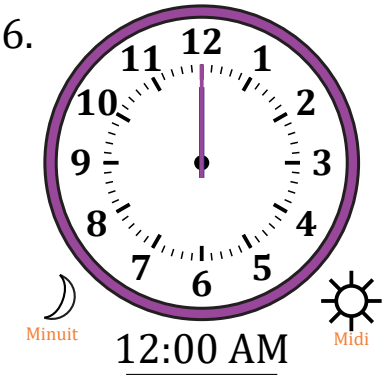

12:00 AM

7. 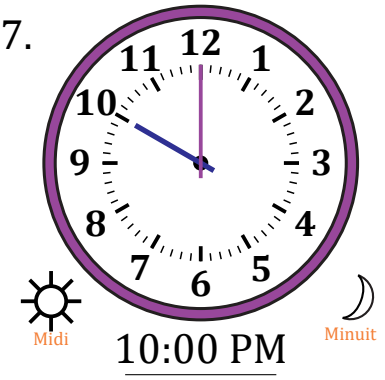

10:00 PM

8. 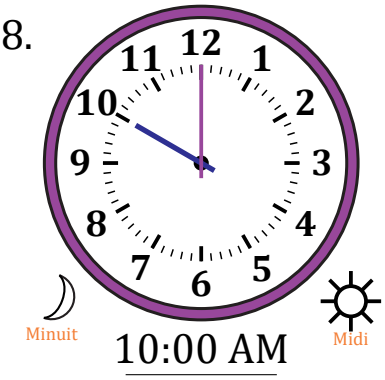

10:00 AM

9. 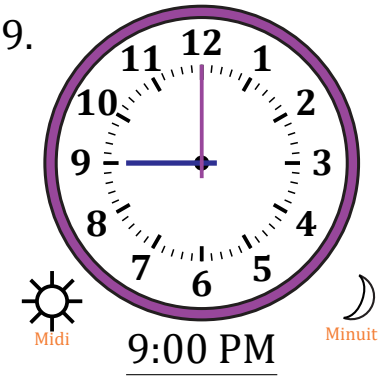

9:00 PM

10. 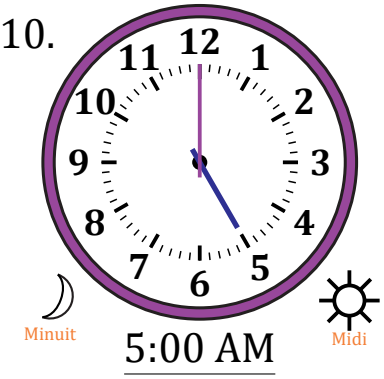

5:00 AM

11. 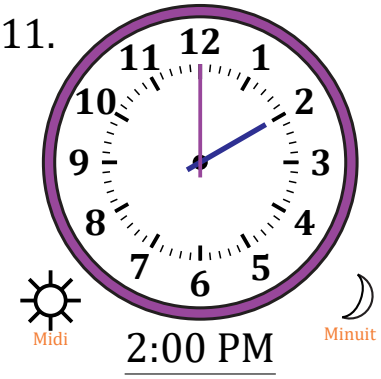

2:00 PM

12. 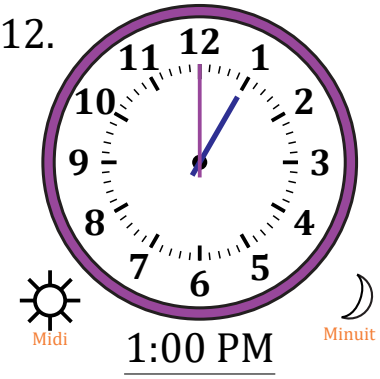

1:00 PM

Place d'Aiguiles sur Une Horloge Analogique (E)

Nom: _____ Date: _____

Placer les aiguilles de l'horloge pour qu'elles montrent le temps indiqué.

1. 

10:00 AM

2. 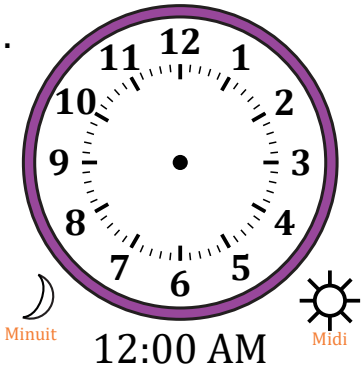

12:00 AM

3. 

3:00 AM

4. 

5:00 PM

5. 

3:00 PM

6. 

6:00 PM

7. 

1:00 PM

8. 

11:00 PM

9. 

8:00 AM

10. 

8:00 PM

11. 

7:00 AM

12. 

5:00 AM

Place d'Aiguiles sur Une Horloge Analogique (E) Solutions

Nom: _____ Date: _____

Placer les aiguilles de l'horloge pour qu'elles montrent le temps indiqué.

1. 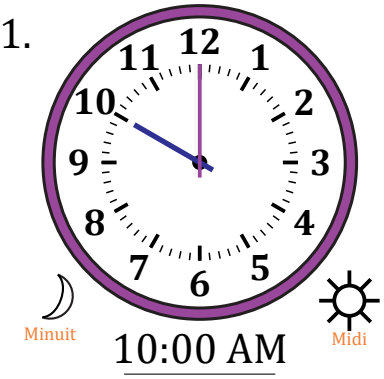

10:00 AM

2. 

12:00 AM

3. 

3:00 AM

4.

5:00 PM

5. 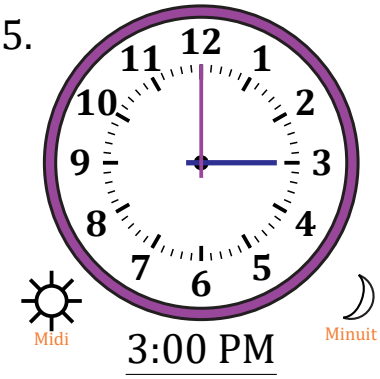

3:00 PM

6. 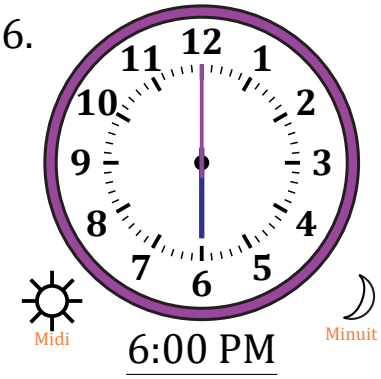

6:00 PM

7. 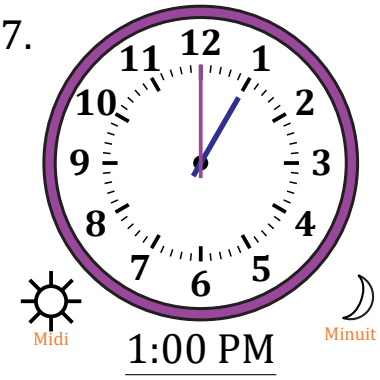

1:00 PM

8. 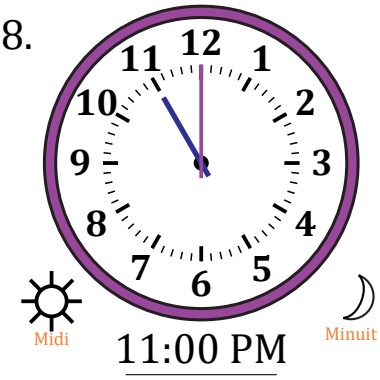

11:00 PM

9. 

8:00 AM

10. 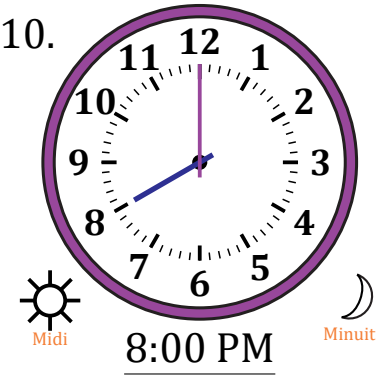

8:00 PM

11. 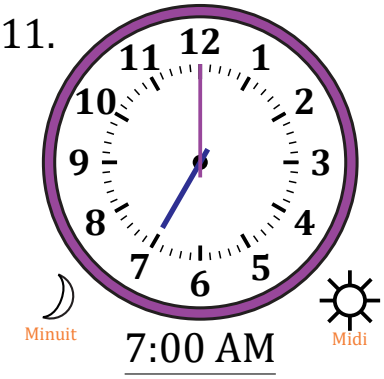

7:00 AM

12. 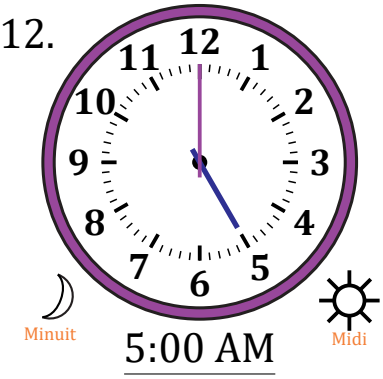

5:00 AM

Place d'Aiguiles sur Une Horloge Analogique (F)

Nom: _____ Date: _____

Placer les aiguilles de l'horloge pour qu'elles montrent le temps indiqué.

1.
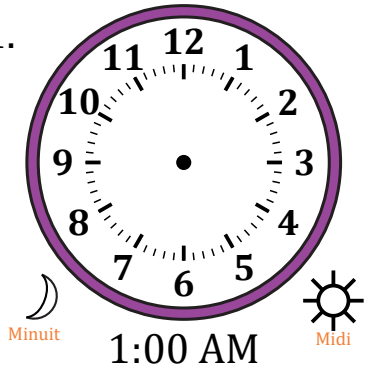

1:00 AM

2.


10:00 PM

3.


12:00 PM

4.


9:00 AM

5.


4:00 AM

6.


7:00 AM

7.


5:00 PM

8.


2:00 AM

9.


2:00 PM

10.
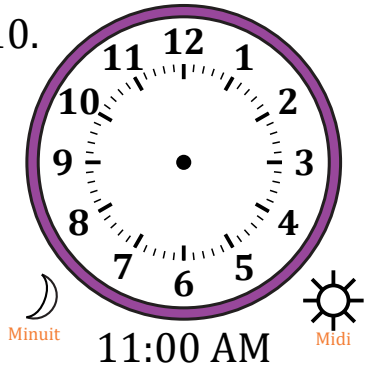

11:00 AM

11.


7:00 PM

12.


9:00 PM

Place d'Aiguiles sur Une Horloge Analogique (F) Solutions

Nom: _____ Date: _____

Placer les aiguilles de l'horloge pour qu'elles montrent le temps indiqué.

1.
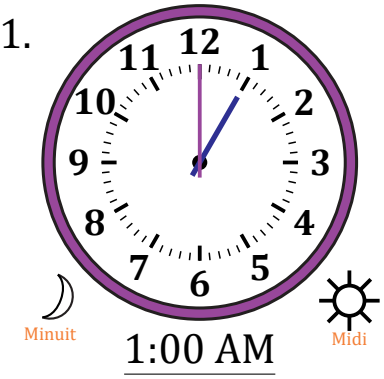

1:00 AM

2.
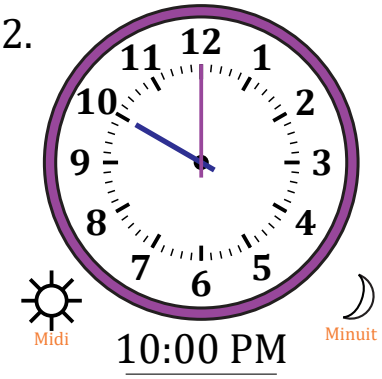

10:00 PM

3.
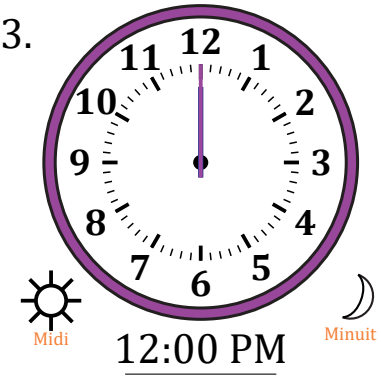

12:00 PM

4.
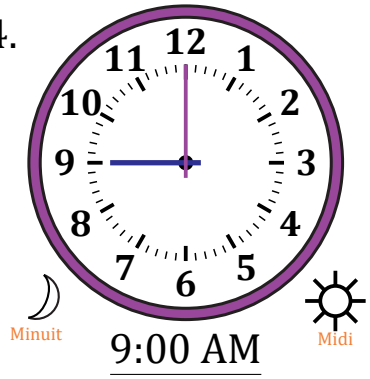

9:00 AM

5.
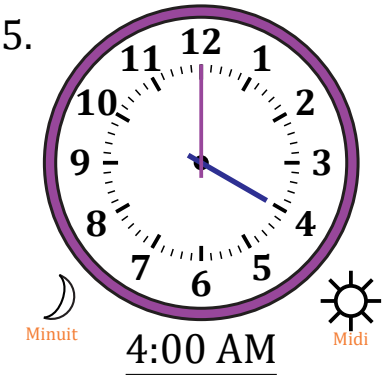

4:00 AM

6.


7:00 AM

7.
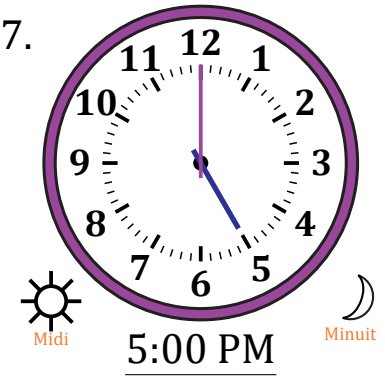

5:00 PM

8.
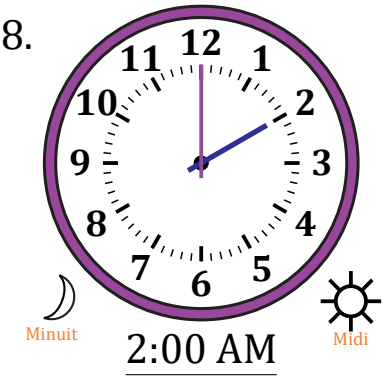

2:00 AM

9.
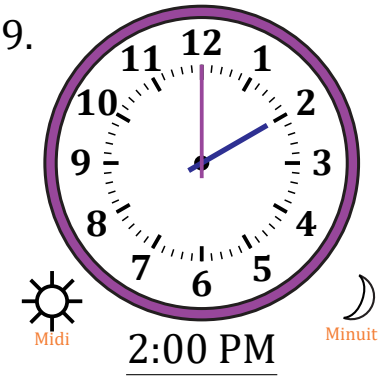

2:00 PM

10.
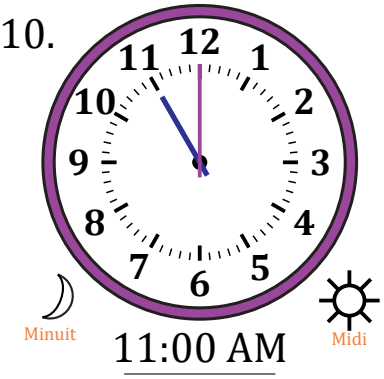

11:00 AM

11.
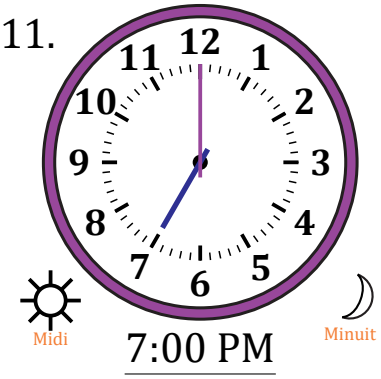

7:00 PM

12.
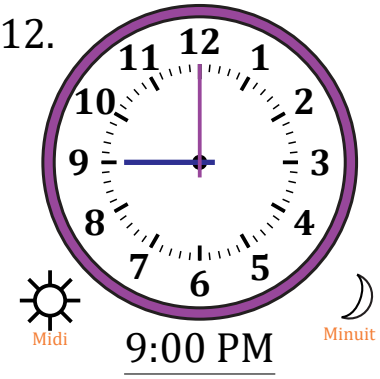

9:00 PM

Place d'Aiguiles sur Une Horloge Analogique (G)

Nom: _____ Date: _____

Placer les aiguilles de l'horloge pour qu'elles montrent le temps indiqué.

1. 

7:00 AM

2. 

1:00 AM

3. 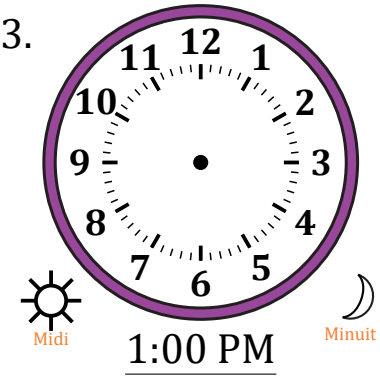

1:00 PM

4. 

4:00 PM

5. 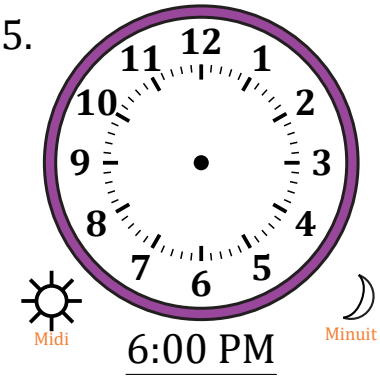

6:00 PM

6. 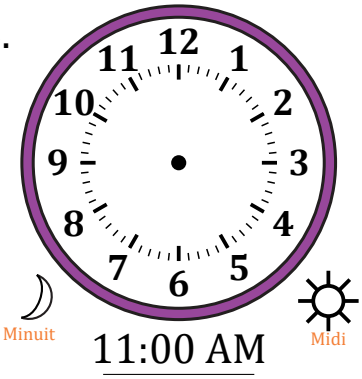

11:00 AM

7. 

9:00 AM

8. 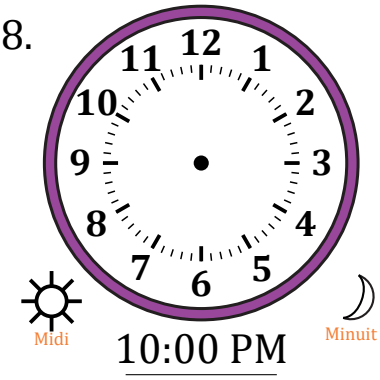

10:00 PM

9. 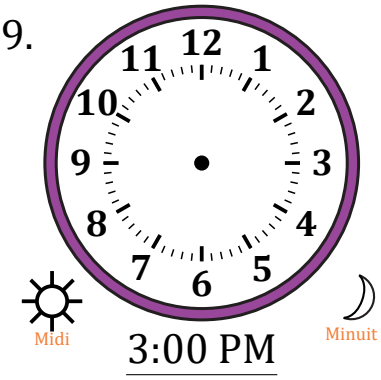

3:00 PM

10. 

3:00 AM

11. 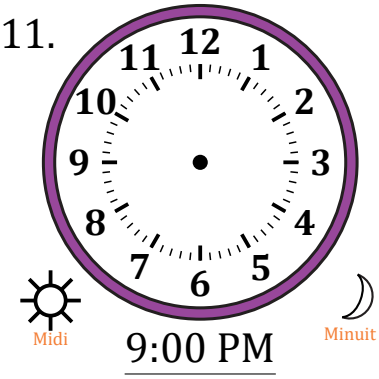

9:00 PM

12. 

5:00 AM

Place d'Aiguiles sur Une Horloge Analogique (G) Solutions

Nom: _____ Date: _____

Placer les aiguilles de l'horloge pour qu'elles montrent le temps indiqué.

1.
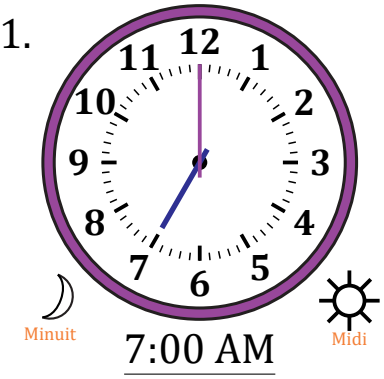

7:00 AM

2.


1:00 AM

3.
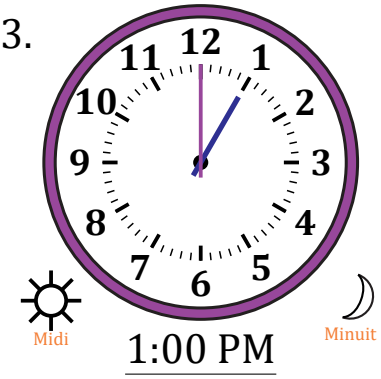

1:00 PM

4.
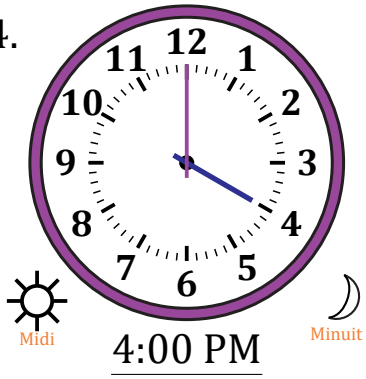

4:00 PM

5.
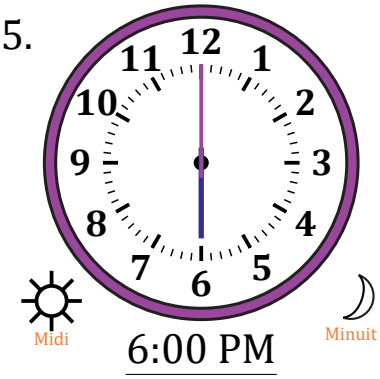

6:00 PM

6.


11:00 AM

7.
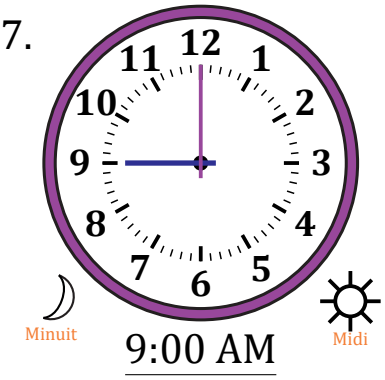

9:00 AM

8.
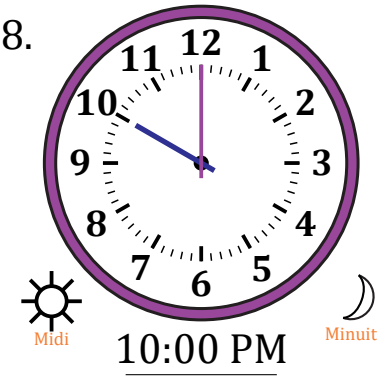

10:00 PM

9.
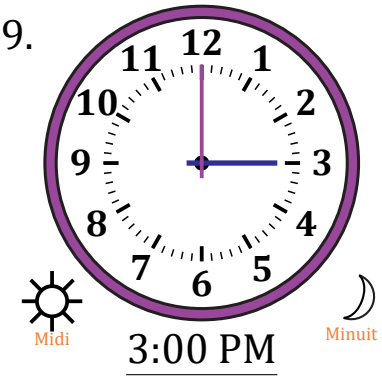

3:00 PM

10.
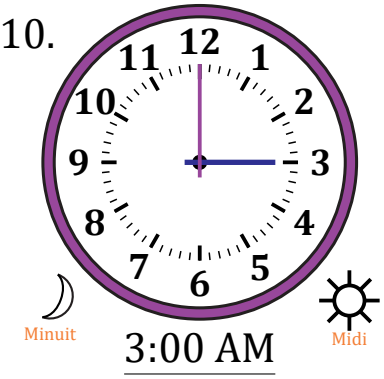

3:00 AM

11.
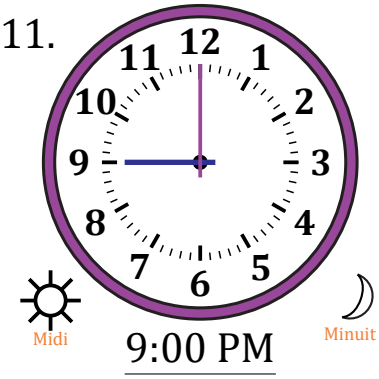

9:00 PM

12.
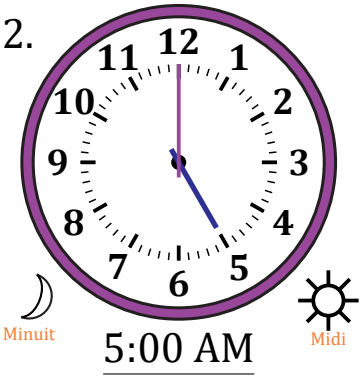

5:00 AM

Place d'Aiguiles sur Une Horloge Analogique (H)

Nom: _____ Date: _____

Placer les aiguilles de l'horloge pour qu'elles montrent le temps indiqué.

1. 

4:00 AM

2. 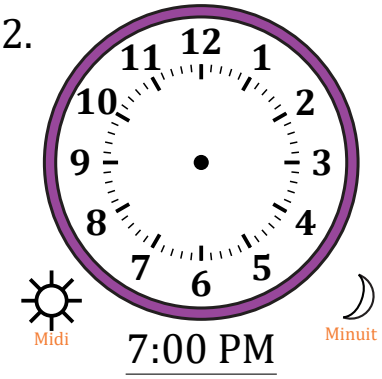

7:00 PM

3. 

10:00 AM

4. 

2:00 PM

5. 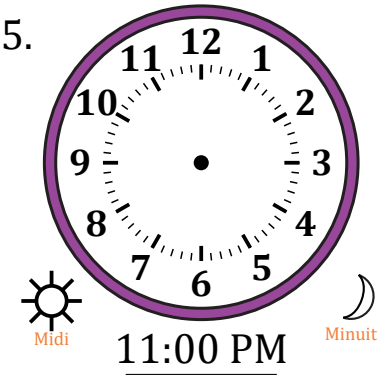

11:00 PM

6. 

8:00 PM

7. 

8:00 AM

8. 

2:00 AM

9. 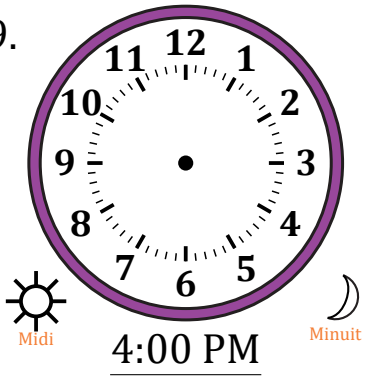

4:00 PM

10. 

6:00 AM

11. 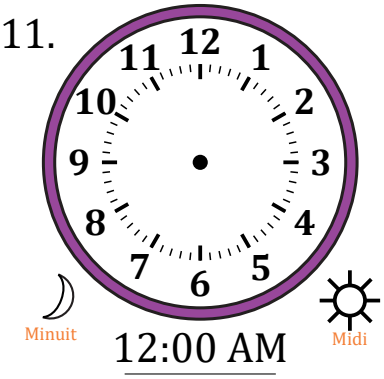

12:00 AM

12. 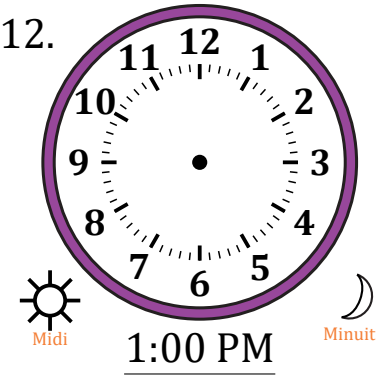

1:00 PM

Place d'Aiguiles sur Une Horloge Analogique (H) Solutions

Nom: _____ Date: _____

Placer les aiguilles de l'horloge pour qu'elles montrent le temps indiqué.

1.
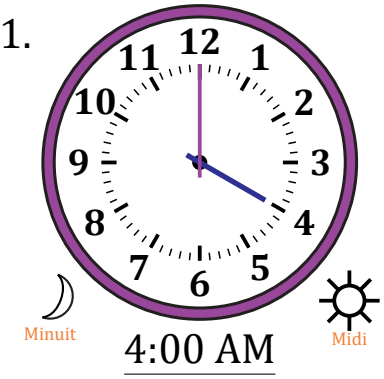

4:00 AM

2.
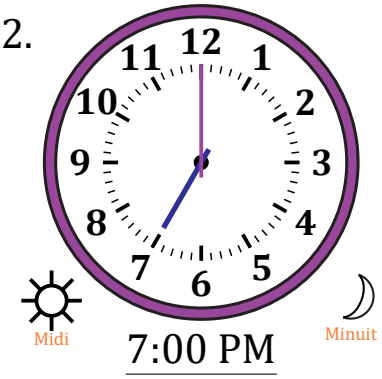

7:00 PM

3.
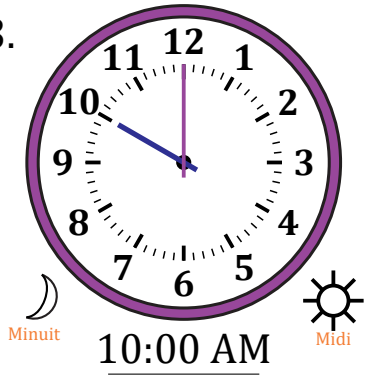

10:00 AM

4.
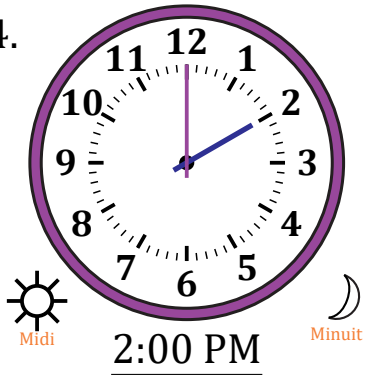

2:00 PM

5.
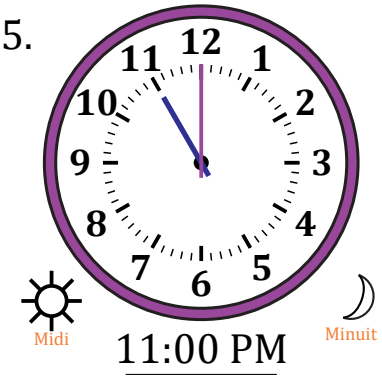

11:00 PM

6.
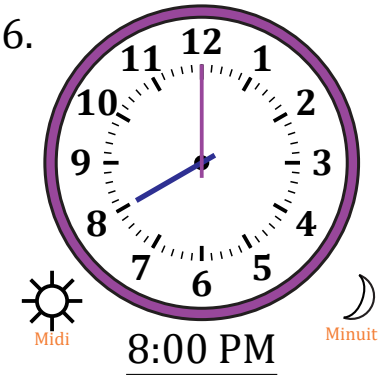

8:00 PM

7.
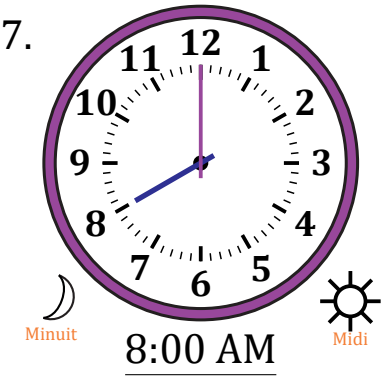

8:00 AM

8.
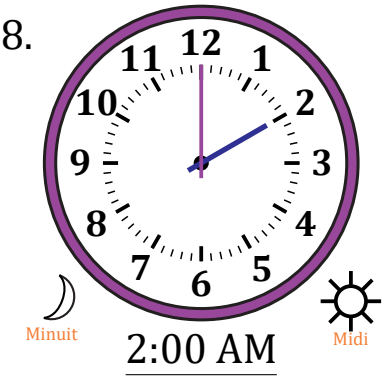

2:00 AM

9.
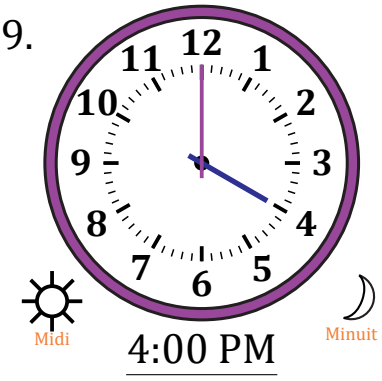

4:00 PM

10.
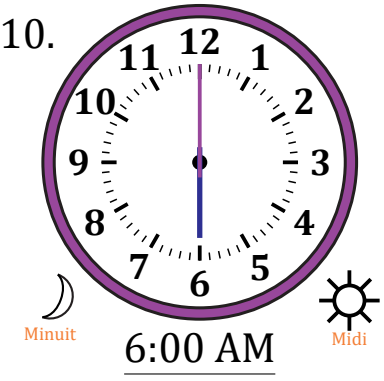

6:00 AM

11.
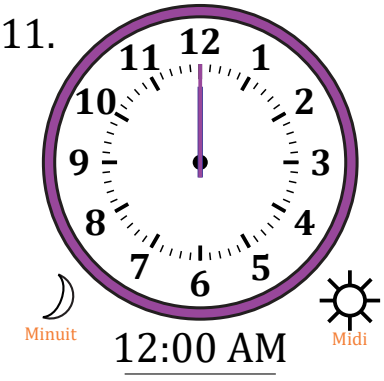

12:00 AM

12.
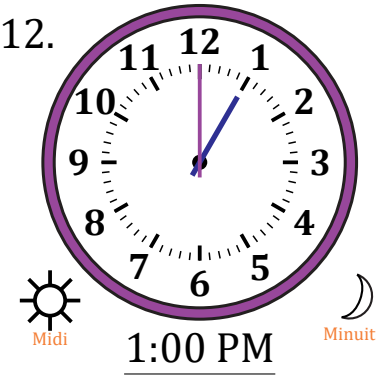

1:00 PM

Place d'Aiguiles sur Une Horloge Analogique (I)

Nom: _____ Date: _____

Placer les aiguilles de l'horloge pour qu'elles montrent le temps indiqué.

1. 

3:00 AM

2. 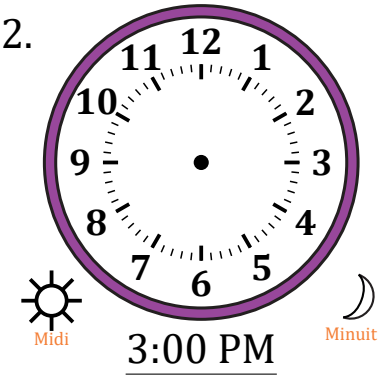

3:00 PM

3. 

12:00 AM

4. 

7:00 AM

5. 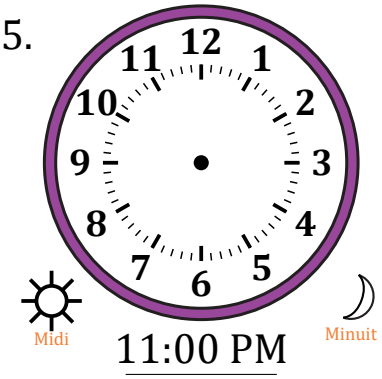

11:00 PM

6. 

5:00 PM

7. 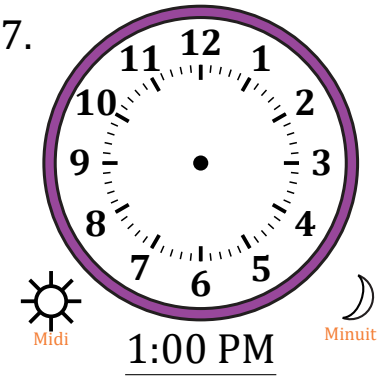

1:00 PM

8. 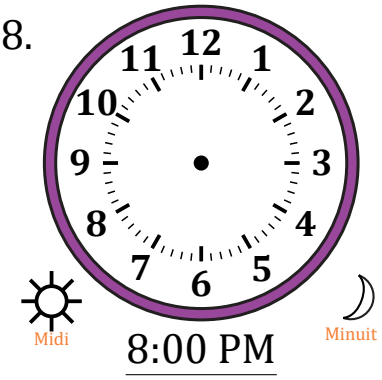

8:00 PM

9. 

7:00 PM

10. 

4:00 AM

11. 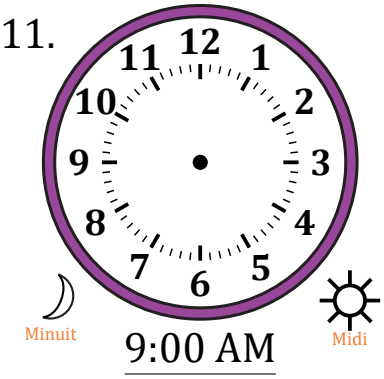

9:00 AM

12. 

11:00 AM

Place d'Aiguiles sur Une Horloge Analogique (I) Solutions

Nom: _____ Date: _____

Placer les aiguilles de l'horloge pour qu'elles montrent le temps indiqué.

1. 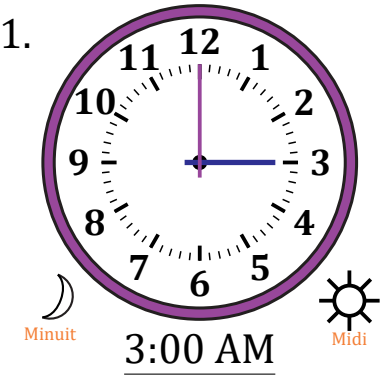

3:00 AM

2. 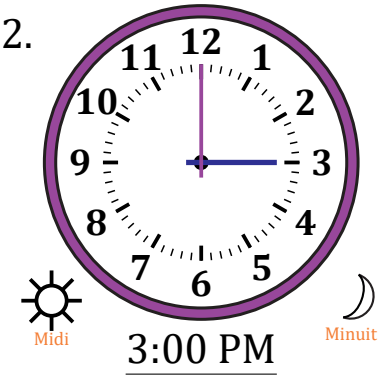

3:00 PM

3.

12:00 AM

4. 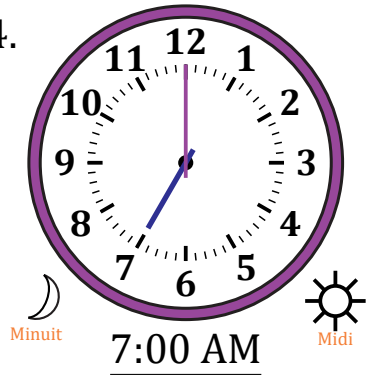

7:00 AM

5. 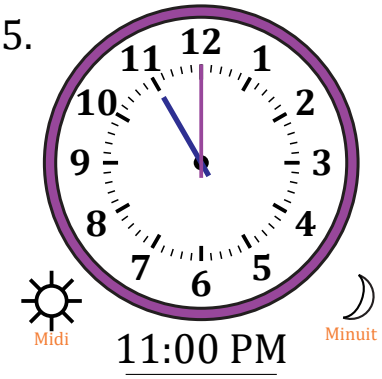

11:00 PM

6. 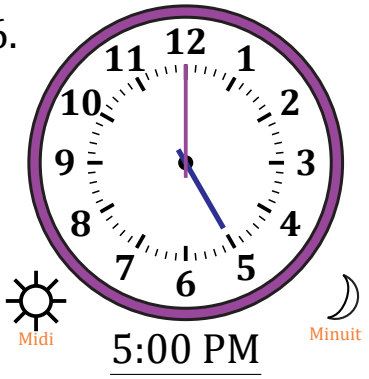

5:00 PM

7. 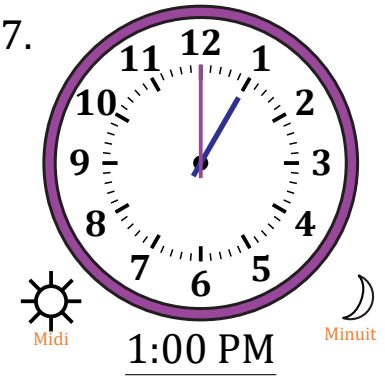

1:00 PM

8. 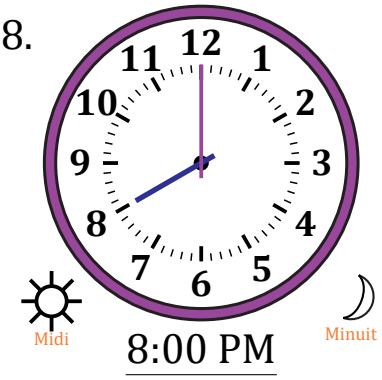

8:00 PM

9. 

7:00 PM

10. 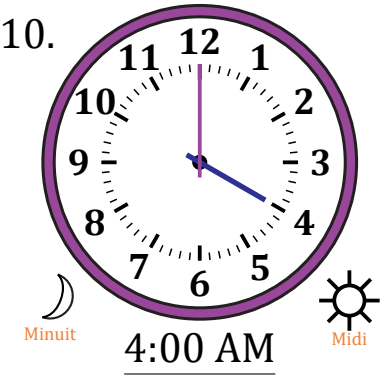

4:00 AM

11. 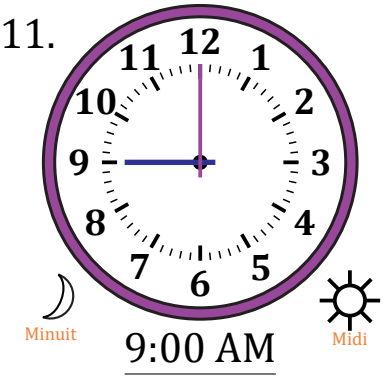

9:00 AM

12. 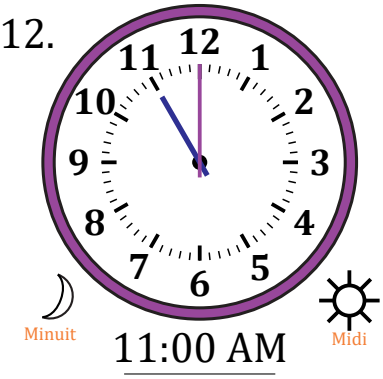

11:00 AM

Place d'Aiguiles sur Une Horloge Analogique (J)

Nom: _____ Date: _____

Placer les aiguilles de l'horloge pour qu'elles montrent le temps indiqué.

1. 

10:00 AM

2. 

2:00 AM

3. 

12:00 PM

4. 

5:00 AM

5. 

10:00 PM

6. 

6:00 AM

7. 

2:00 PM

8.

8:00 AM

9. 

6:00 PM

10. 

5:00 PM

11. 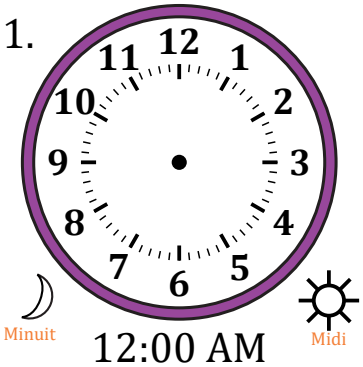

12:00 AM

12. 

9:00 PM

Place d'Aiguiles sur Une Horloge Analogique (J) Solutions

Nom: _____ Date: _____

Placer les aiguilles de l'horloge pour qu'elles montrent le temps indiqué.

1.


10:00 AM

2.
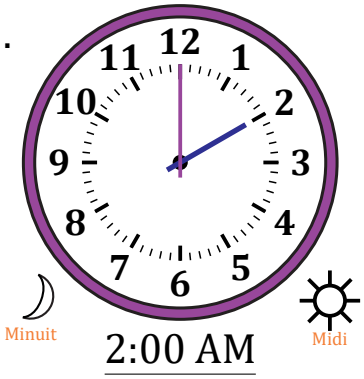

2:00 AM

3.
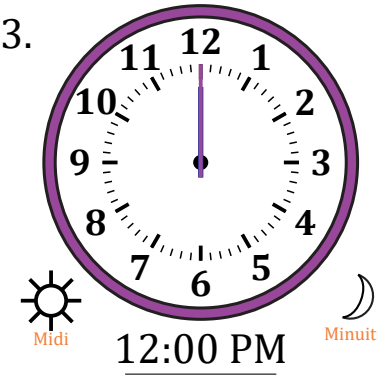

12:00 PM

4.

5:00 AM

5.
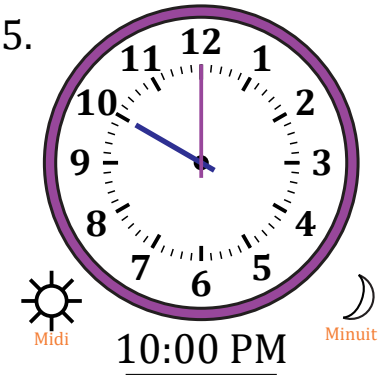

10:00 PM

6.

6:00 AM

7.
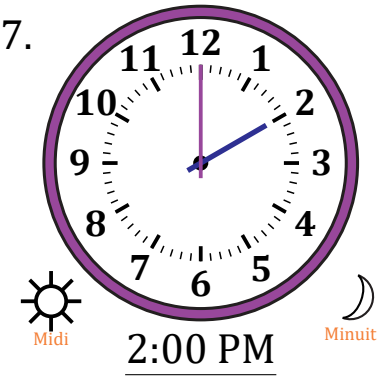

2:00 PM

8.
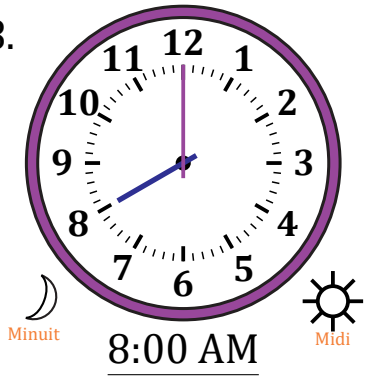

8:00 AM

9.
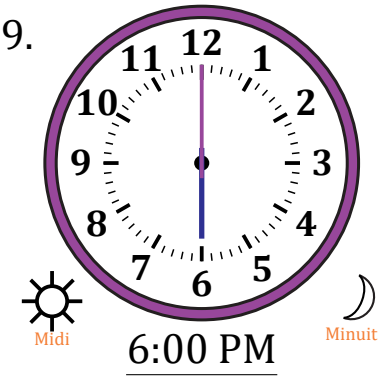

6:00 PM

10.
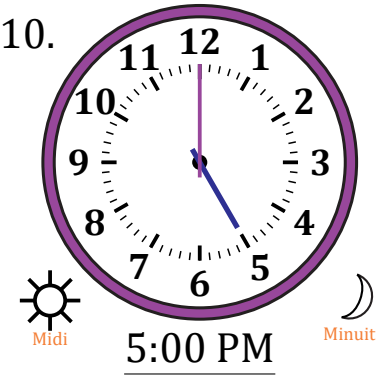

5:00 PM

11.
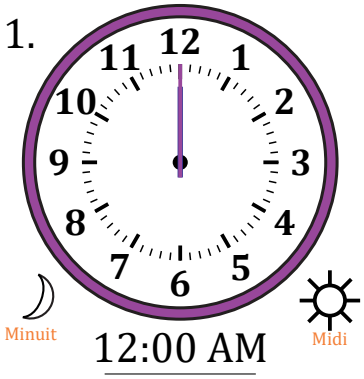

12:00 AM

12.
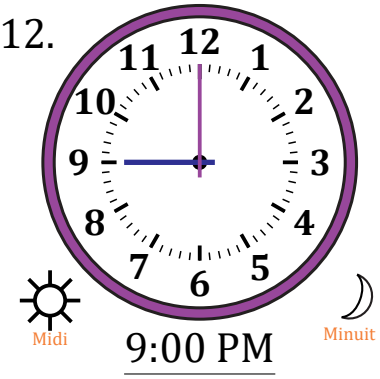

9:00 PM