Place d'Aiguiles sur Une Horloge Analogique (B)

Nom: _____ Date: _____

Placer les aiguilles de l'horloge pour qu'elles montrent le temps indiqué.

1. 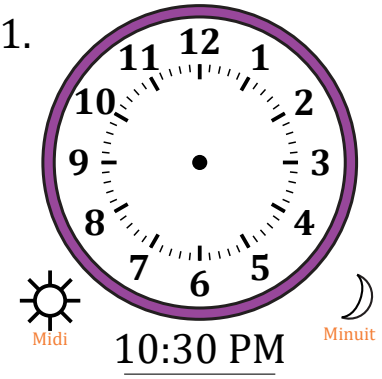

10:30 PM

2. 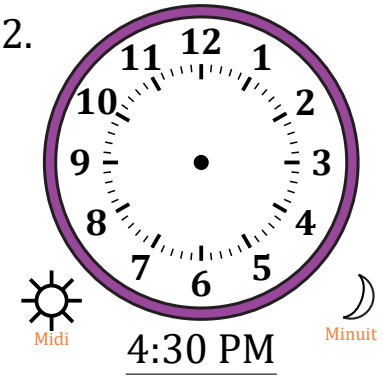

4:30 PM

3. 

7:00 AM

4. 

10:00 AM

5. 

2:30 AM

6. 

12:00 AM

7. 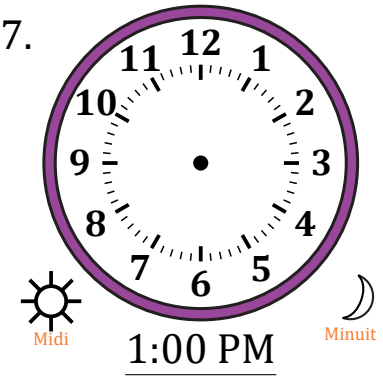

1:00 PM

8. 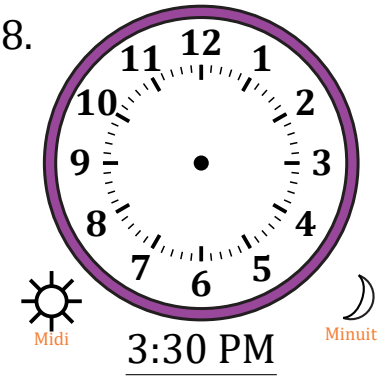

3:30 PM

9. 

8:00 AM

10. 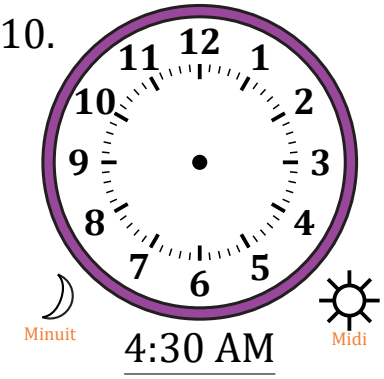

4:30 AM

11. 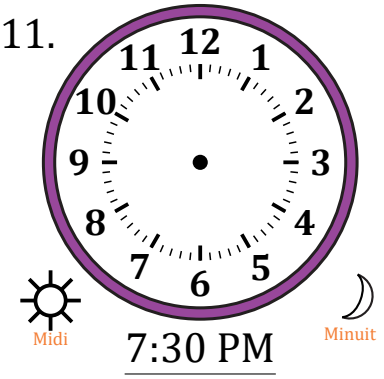

7:30 PM

12. 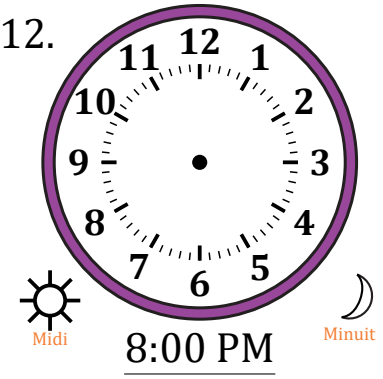

8:00 PM