Place d'Aiguiles sur Une Horloge Analogique (B)

Nom: _____ Date: _____

Placer les aiguilles de l'horloge pour qu'elles montrent le temps indiqué.

1. 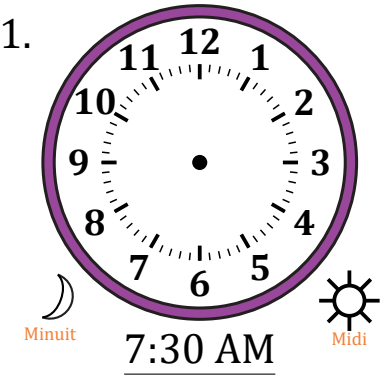

7:30 AM

2. 

1:15 AM

3. 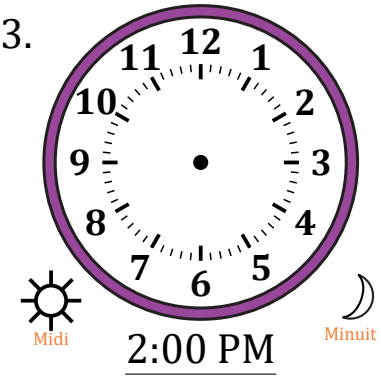

2:00 PM

4. 

7:30 PM

5. 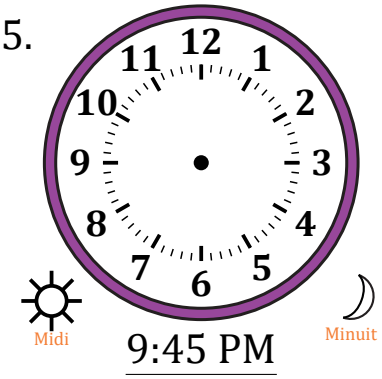

9:45 PM

6. 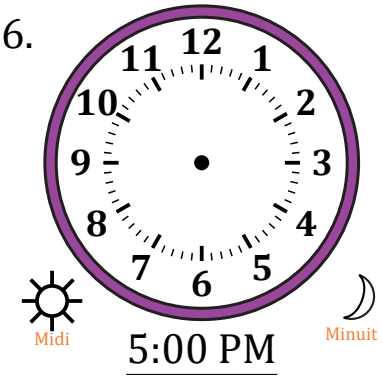

5:00 PM

7. 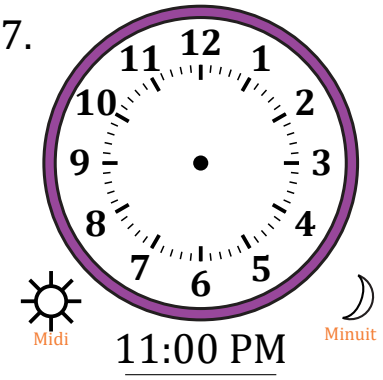

11:00 PM

8. 

10:15 AM

9. 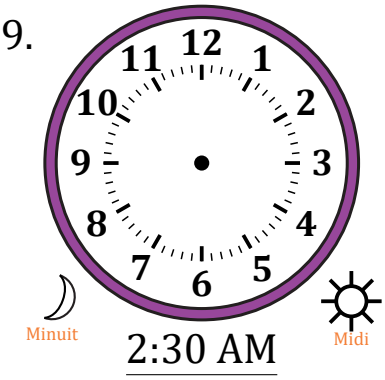

2:30 AM

10. 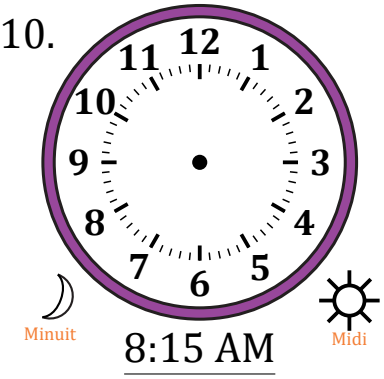

8:15 AM

11. 

5:45 AM

12. 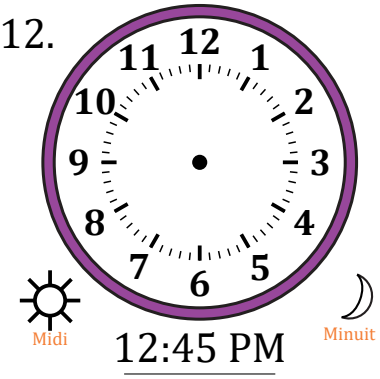

12:45 PM

Place d'Aiguiles sur Une Horloge Analogique (B) Solutions

Nom: _____ Date: _____

Placer les aiguilles de l'horloge pour qu'elles montrent le temps indiqué.

1. 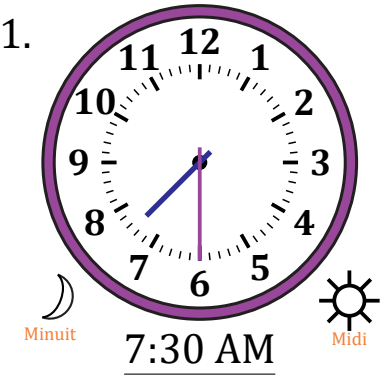

7:30 AM

2. 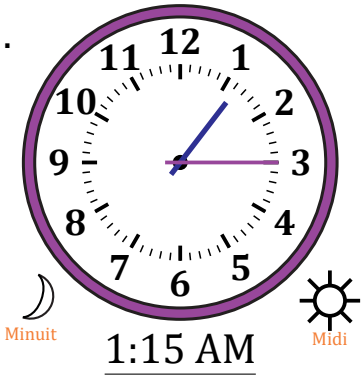

1:15 AM

3. 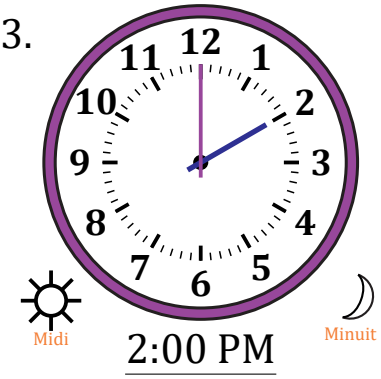

2:00 PM

4.

7:30 PM

5. 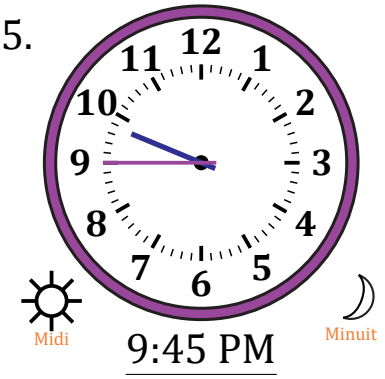

9:45 PM

6. 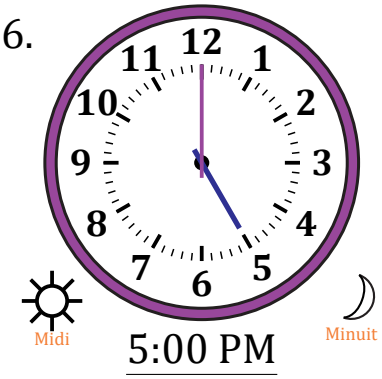

5:00 PM

7. 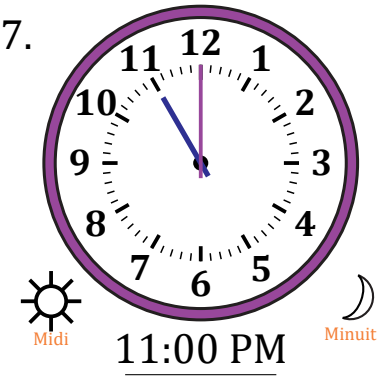

11:00 PM

8. 

10:15 AM

9. 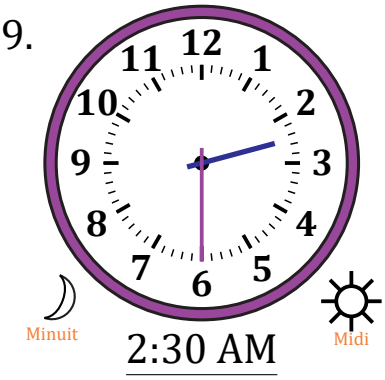

2:30 AM

10. 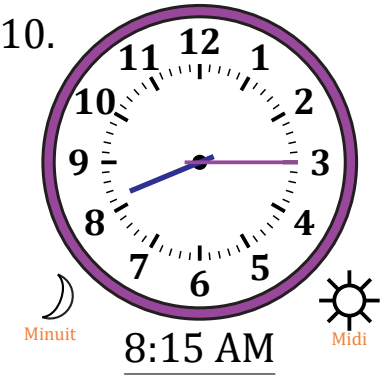

8:15 AM

11. 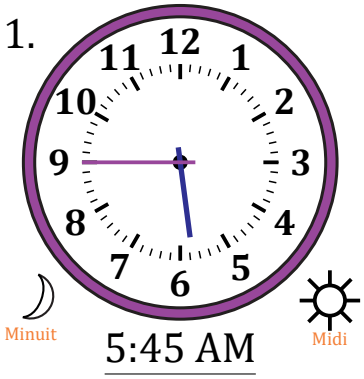

5:45 AM

12. 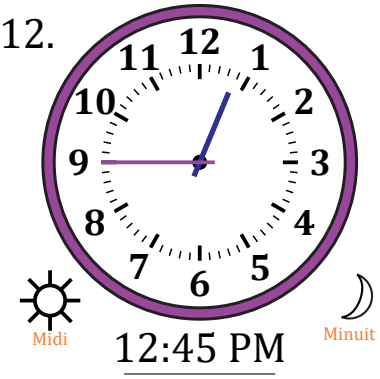

12:45 PM