Lecture d'une Horloge Analogique (D)

Nom: _____ Date: _____

Lisez chaque heure et écrivez-la dans l'espace sous l'horloge.

1.

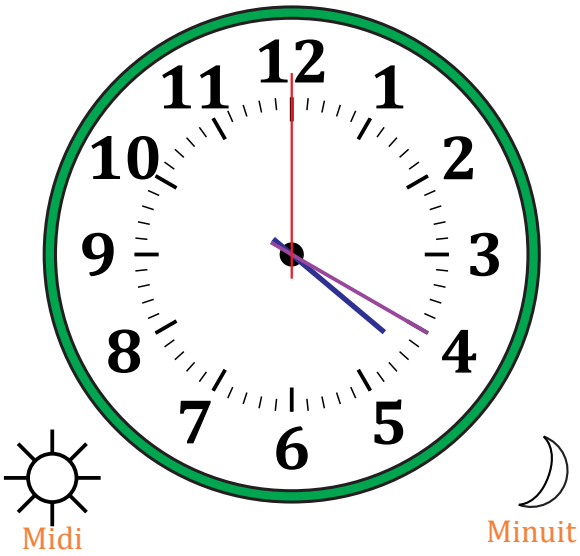

_____

2.



_____

3.



_____

4.



_____

Lecture d'une Horloge Analogique (D) Solutions

Nom: _____ Date: _____

Lisez chaque heure et écrivez-la dans l'espace sous l'horloge.

1.

4:20:00 PM

2.

10:15:00 PM

3.



4:16:30 AM

4.



10:06:30 AM