Lecture d'une Horloge Analogique (C)

Nom: _____ Date: _____

Lisez chaque heure et écrivez-la dans l'espace sous l'horloge.

1.

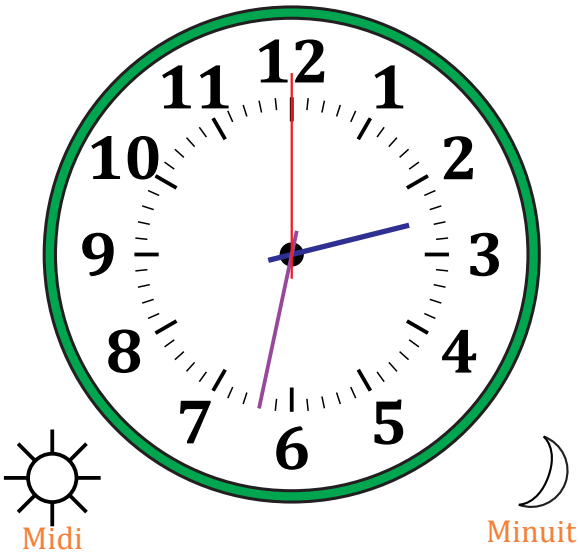

_____

2.



_____

3.



_____

4.

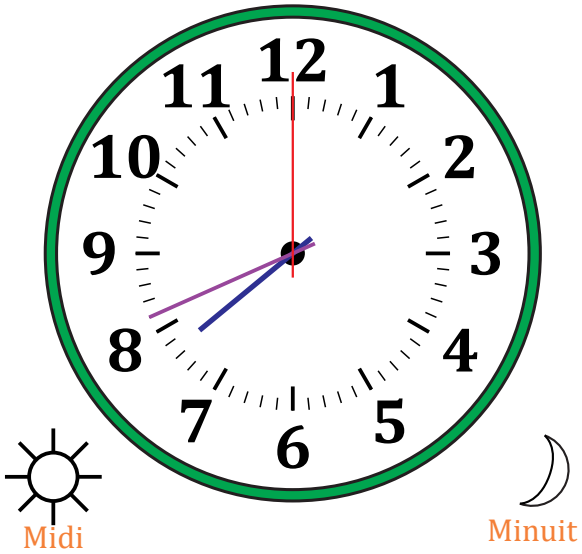

_____

Lecture d'une Horloge Analogique (C) Solutions

Nom: _____ Date: _____

Lisez chaque heure et écrivez-la dans l'espace sous l'horloge.

1.

2:32:00 PM

2.



3:38:30 AM

3.



8:23:30 AM

4.

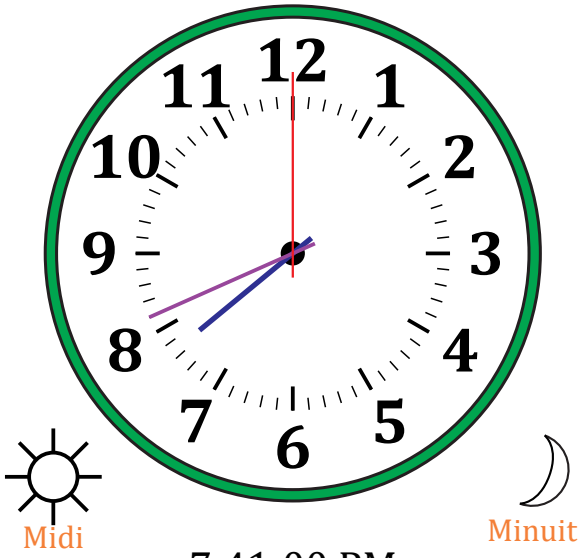

7:41:00 PM