Lecture d'une Horloge Analogique (B)

Nom: _____ Date: _____

Lisez chaque heure et écrivez-la dans l'espace sous l'horloge.

1.



_____

2.



_____

3.

_____

4.



_____

Lecture d'une Horloge Analogique (B) Solutions

Nom: _____ Date: _____

Lisez chaque heure et écrivez-la dans l'espace sous l'horloge.

1.



00h19m00s

2.



10h37m30s

3.

17h23m00s

4.



22h16m30s