Lecture d'une Horloge Analogique (A)

Nom: _____ Date: _____

Lisez chaque heure et écrivez-la dans l'espace sous l'horloge.

1.

_____

2.

_____

3.



_____

4.



_____

Lecture d'une Horloge Analogique (A) Solutions

Nom: _____ Date: _____

Lisez chaque heure et écrivez-la dans l'espace sous l'horloge.

1.

22h30m00s

2.



16h53m30s

3.



02h38m00s

4.



07h04m30s