Lecture d'une Horloge Analogique (F)

Nom: _____ Date: _____

Lisez chaque heure et écrivez-la dans l'espace sous l'horloge.

1.

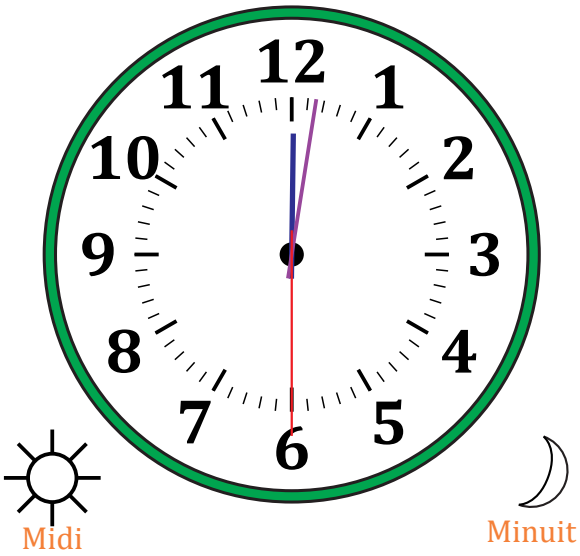

_____

2.



_____

3.



_____

4.



_____

Lecture d'une Horloge Analogique (F) Solutions

Nom: _____ Date: _____

Lisez chaque heure et écrivez-la dans l'espace sous l'horloge.

1.

12:01:30 PM

2.



8:35:15 PM

3.

1:32:00 AM

4.



10:19:45 AM